Task card 1 Multiplicative Comparison ("Times...

Complete the comparison for 40 = 4 × 10: 40 is ___ times as many as 10.

Task card 2 Multiplicative Comparison ("Times...

Zoe has 12 marbles. Ben has 9 times as many marbles as Zoe. How many marbles does Ben have?



Task card 3 Multiplicative Comparison ("Times...

Ella has 25 marbles. That is 5 times as many as Noah has. How many marbles does Noah have?

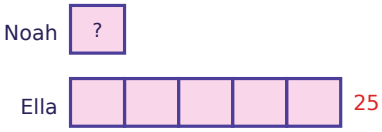

Task card 4 Multiplicative Comparison ("Times...

Ella has 12 books and Noah has 3 books. How many times as many books does Ella have as Noah?

Task card 5 Multiplicative Comparison ("Times...

Complete the comparison for 27 = 3 × 9: 27 is ___ times as many as 9.

Task card 6 Multiplicative Comparison ("Times...

Ava has 10 shells. Sam has 2 times as many shells as Ava. How many shells does Sam have?

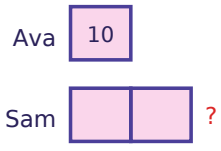

Task card 7 Multiplicative Comparison ("Times...

Omar has 54 cards. That is 9 times as many as Kim has. How many cards does Kim have?

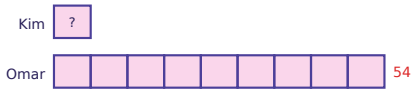

Task card 8 Multiplicative Comparison ("Times...

Ben has 21 stamps and Zoe has 3 stamps. How many times as many stamps does Ben have as Zoe?

Task card 9 Multiplicative Comparison ("Times...

Zoe has 2 stamps. Ben has 3 times as many stamps as Zoe. How many stamps does Ben have?

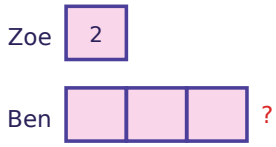

Task card 10 Multiplicative Comparison ("Times...

Ben has 63 coins. That is 7 times as many as Zoe has. How many coins does Zoe have?

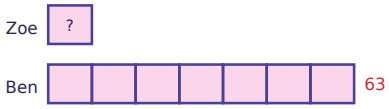

Task card 11 Multiplicative Comparison ("Times...

Jack has 12 stickers and Lily has 6 stickers. How many times as many stickers does Jack have as Lily?

Task card 12 Multiplicative Comparison ("Times...

Zoe has 10 stickers. Ben has 2 times as many. How many more stickers does Ben have than Zoe?

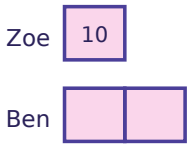

Task card 13 Multiplicative Comparison ("Times...

Zoe has 6 marbles. Ben has 8 times as many marbles as Zoe. How many marbles does Ben have?

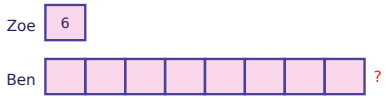

Task card 14 Multiplicative Comparison ("Times...

Ben has 15 shells. That is 3 times as many as Zoe has. How many shells does Zoe have?

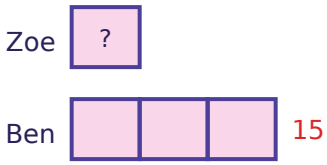

Task card 15 Multiplicative Comparison ("Times...

Sam has 15 shells and Ava has 3 shells. How many times as many shells does Sam have as Ava?

Task card 16 Multiplicative Comparison ("Times...

Lily has 3 pencils. Jack has 8 times as many. How many more pencils does Jack have than Lily?

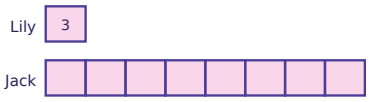

Task card 17 Multiplicative Comparison ("Times...

Mia has 18 books. Leo has 7 times as many books as Mia. How many books does Leo have?

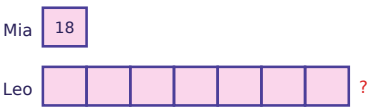

Task card 18 Multiplicative Comparison ("Times...

Jack has 168 marbles. That is 7 times as many as Lily has. How many marbles does Lily have?

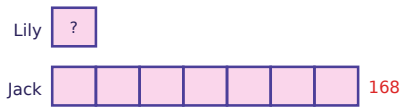

Task card 19 Multiplicative Comparison ("Times...

Ella has 39 coins and Noah has 13 coins. How many times as many coins does Ella have as Noah?

Task card 20 Multiplicative Comparison ("Times...

Kim has 9 pencils. Omar has 8 times as many. How many more pencils does Omar have than Kim?

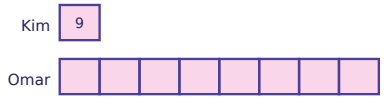

Task card 21 Multiplicative Comparison ("Times...

Noah has 23 shells. Ella has 9 times as many shells as Noah. How many shells does Ella have?

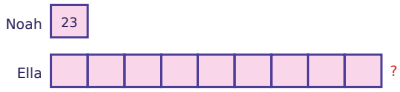

Task card 22 Multiplicative Comparison ("Times...

Jack has 168 pencils. That is 7 times as many as Lily has. How many pencils does Lily have?

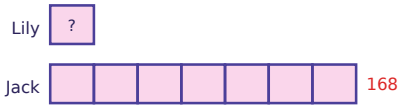

Task card 23 Multiplicative Comparison ("Times...

Ben has 176 marbles and Zoe has 22 marbles. How many times as many marbles does Ben have as Zoe?

Task card 24 Multiplicative Comparison ("Times...

Mia has 16 cards. Leo has 5 times as many. How many more cards does Leo have than Mia?

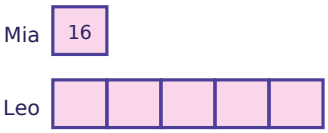

Multiplicative Comparison ("Times as Many") Task Cards

Recording sheet · Grade 4 · Solve each comparison problem. Use the bar models to help.

Scan to check your answers

Name: _____ Date: _____

1	2	3	4
5	6	7	8
9	10	11	12
13	14	15	16
17	18	19	20
21	22	23	24

Multiplicative Comparison ("Times as Many") Task Cards: Answer Key

Grade 4 · Medium

The answers online

1. 4	**2.** 108	**3.** 5
4. 4	**5.** 3	**6.** 20
7. 6	**8.** 7	**9.** 6
10. 9	**11.** 2	**12.** 10
13. 48	**14.** 5	**15.** 5
16. 21	**17.** 126	**18.** 24
19. 3	**20.** 63	**21.** 207
22. 24	**23.** 8	**24.** 64