Task card 1 Multiplicative Comparison ("Times...

Lily has 2 stamps. Jack has 6 times as many stamps as Lily. How many stamps does Jack have?

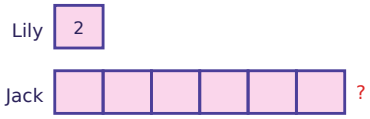

Task card 2 Multiplicative Comparison ("Times...

Omar has 133 stamps. That is 7 times as many as Kim has. How many stamps does Kim have?

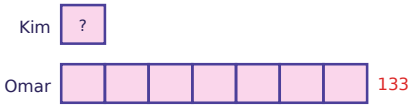

Task card 3 Multiplicative Comparison ("Times...

Ella has 184 marbles and Noah has 23 marbles. How many times as many marbles does Ella have as Noah?

Task card 4 Multiplicative Comparison ("Times...

Mia has 25 stamps. Leo has 7 times as many. How many more stamps does Leo have than Mia?

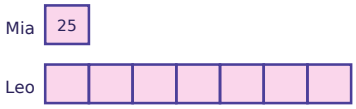

Task card 5 Multiplicative Comparison ("Times...

Lily has 4 stickers. Jack has 3 times as many stickers as Lily. How many stickers does Jack have?

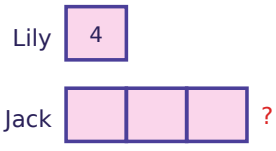

Task card 6 Multiplicative Comparison ("Times...

Omar has 70 stickers. That is 7 times as many as Kim has. How many stickers does Kim have?

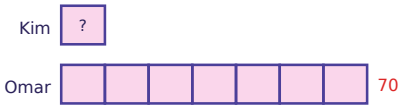

Task card 7 Multiplicative Comparison ("Times...

Ben has 44 marbles and Zoe has 22 marbles. How many times as many marbles does Ben have as Zoe?

Task card 8 Multiplicative Comparison ("Times...

Ava has 8 stamps. Sam has 2 times as many. How many more stamps does Sam have than Ava?

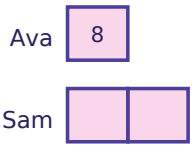

Task card 9 Multiplicative Comparison ("Times...

Kim has 22 books. Omar has 5 times as many books as Kim. How many books does Omar have?

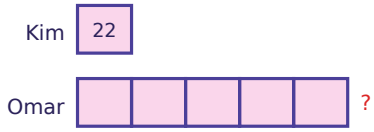

Task card 10 Multiplicative Comparison ("Times...

Ben has 162 cards. That is 9 times as many as Zoe has. How many cards does Zoe have?

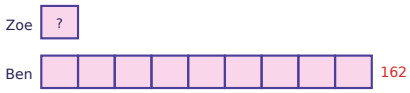

Task card 11 Multiplicative Comparison ("Times...

Leo has 91 pencils and Mia has 13 pencils. How many times as many pencils does Leo have as Mia?

Task card 12 Multiplicative Comparison ("Times...

Lily has 8 cards. Jack has 4 times as many. How many more cards does Jack have than Lily?

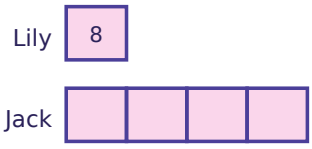

Task card 13 Multiplicative Comparison ("Times...

Zoe has 10 shells. Ben has 9 times as many shells as Zoe. How many shells does Ben have?



Task card 14 Multiplicative Comparison ("Times...

Leo has 64 stickers. That is 8 times as many as Mia has. How many stickers does Mia have?



Task card 15 Multiplicative Comparison ("Times...

Jack has 12 marbles and Lily has 2 marbles. How many times as many marbles does Jack have as Lily?

Task card 16 Multiplicative Comparison ("Times...

Zoe has 6 stickers. Ben has 6 times as many. How many more stickers does Ben have than Zoe?

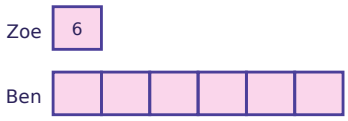

Task card 17 Multiplicative Comparison ("Times...

Noah has 24 pencils. Ella has 6 times as many pencils as Noah. How many pencils does Ella have?

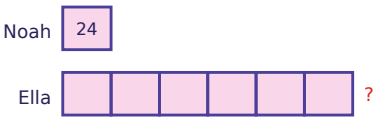

Task card 18 Multiplicative Comparison ("Times...

Sam has 120 books. That is 5 times as many as Ava has. How many books does Ava have?

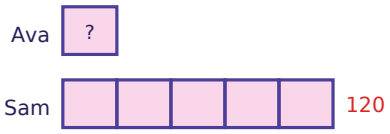

Task card 19 Multiplicative Comparison ("Times...

Leo has 81 stamps and Mia has 9 stamps. How many times as many stamps does Leo have as Mia?

Task card 20 Multiplicative Comparison ("Times...

Kim has 14 stamps. Omar has 6 times as many. How many more stamps does Omar have than Kim?

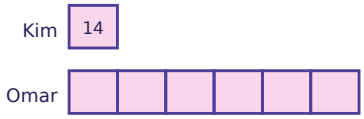

Task card 21 Multiplicative Comparison ("Times...

Mia has 25 stickers. Leo has 8 times as many stickers as Mia. How many stickers does Leo have?

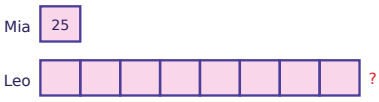

Task card 22 Multiplicative Comparison ("Times...

Sam has 68 stamps. That is 4 times as many as Ava has. How many stamps does Ava have?

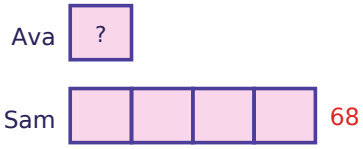

Task card 23 Multiplicative Comparison ("Times...

Omar has 36 shells and Kim has 12 shells. How many times as many shells does Omar have as Kim?

Task card 24 Multiplicative Comparison ("Times...

Noah has 17 marbles. Ella has 3 times as many. How many more marbles does Ella have than Noah?

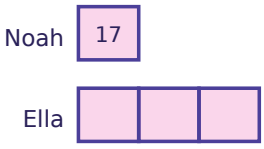

Multiplicative Comparison ("Times as Many") Task Cards

Recording sheet · Grade 4 · Solve each comparison problem. Use the bar models to help.

Scan to check your answers

Name: _____ Date: _____

1	2	3	4
5	6	7	8
9	10	11	12
13	14	15	16
17	18	19	20
21	22	23	24

Multiplicative Comparison ("Times as Many") Task Cards: Answer Key

Grade 4 · Hard

The answers online

1. 12	**2.** 19	**3.** 8
4. 150	**5.** 12	**6.** 10
7. 2	**8.** 8	**9.** 110
10. 18	**11.** 7	**12.** 24
13. 90	**14.** 8	**15.** 6
16. 30	**17.** 144	**18.** 24
19. 9	**20.** 70	**21.** 200
22. 17	**23.** 3	**24.** 34