Task card 1 Multiplicative Comparison ("Times...

Complete the comparison for 6 = 2 × 3: 6 is ___ times as many as 3.

Task card 2 Multiplicative Comparison ("Times...

Zoe has 5 pencils. Ben has 3 times as many pencils as Zoe. How many pencils does Ben have?

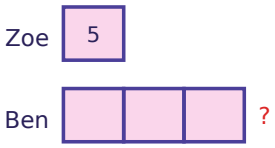

Task card 3 Multiplicative Comparison ("Times...

Ava has 9 books. Sam has 4 times as many books as Ava. How many books does Sam have?

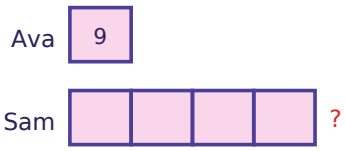

Task card 4 Multiplicative Comparison ("Times...

Complete the comparison for 10 = 5 × 2: 10 is ___ times as many as 2.

Task card 5 Multiplicative Comparison ("Times...

Complete the comparison for 27 = 3 × 9: 27 is ___ times as many as 9.

Task card 6 Multiplicative Comparison ("Times...

Noah has 4 books. Ella has 3 times as many books as Noah. How many books does Ella have?

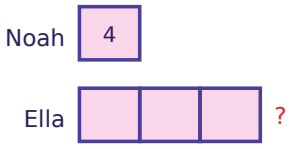

Task card 7 Multiplicative Comparison ("Times...

Zoe has 3 books. Ben has 4 times as many books as Zoe. How many books does Ben have?

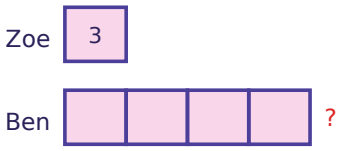

Task card 8 Multiplicative Comparison ("Times...

Complete the comparison for 16 = 2 × 8: 16 is ___ times as many as 8.

Task card 9 Multiplicative Comparison ("Times...

Complete the comparison for 14 = 2 × 7: 14 is ___ times as many as 7.

Task card 10 Multiplicative Comparison ("Times...

Lily has 2 pencils. Jack has 4 times as many pencils as Lily. How many pencils does Jack have?

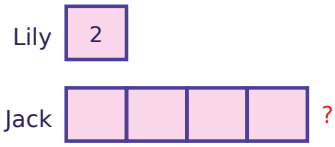

Task card 11 Multiplicative Comparison ("Times...

Lily has 5 stickers. Jack has 3 times as many stickers as Lily. How many stickers does Jack have?

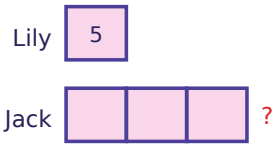

Task card 12 Multiplicative Comparison ("Times...

Complete the comparison for 20 = 4 × 5: 20 is ___ times as many as 5.

Task card 13 Multiplicative Comparison ("Times...

Complete the comparison for 45 = 5 × 9: 45 is ___ times as many as 9.

Task card 14 Multiplicative Comparison ("Times...

Zoe has 3 pencils. Ben has 3 times as many pencils as Zoe. How many pencils does Ben have?

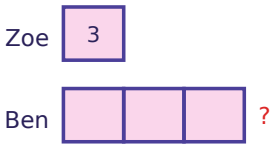

Task card 15 Multiplicative Comparison ("Times...

Zoe has 3 marbles. Ben has 4 times as many marbles as Zoe. How many marbles does Ben have?

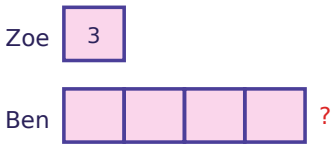

Task card 16 Multiplicative Comparison ("Times...

Complete the comparison for 20 = 5 × 4: 20 is ___ times as many as 4.

Task card 17 Multiplicative Comparison ("Times...

Complete the comparison for 42 = 6 × 7: 42 is ___ times as many as 7.

Task card 18 Multiplicative Comparison ("Times...

Zoe has 8 coins. Ben has 3 times as many coins as Zoe. How many coins does Ben have?

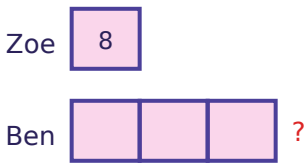

Task card 19 Multiplicative Comparison ("Times...

Omar has 20 pencils. That is 4 times as many as Kim has. How many pencils does Kim have?

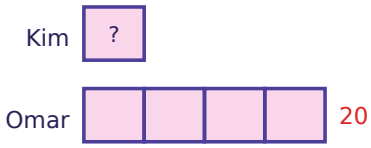

Task card 20 Multiplicative Comparison ("Times...

Ben has 42 books and Zoe has 6 books. How many times as many books does Ben have as Zoe?

Task card 21 Multiplicative Comparison ("Times...

Complete the comparison for 42 = 7 × 6: 42 is ___ times as many as 6.

Task card 22 Multiplicative Comparison ("Times...

Zoe has 3 cards. Ben has 8 times as many cards as Zoe. How many cards does Ben have?

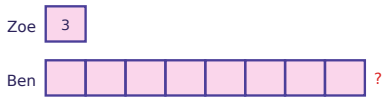

Task card 23 Multiplicative Comparison ("Times...

Sam has 36 marbles. That is 9 times as many as Ava has. How many marbles does Ava have?

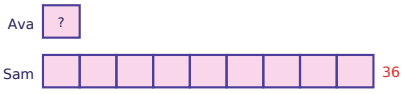

Task card 24 Multiplicative Comparison ("Times...

Jack has 42 stickers and Lily has 7 stickers. How many times as many stickers does Jack have as Lily?

Multiplicative Comparison ("Times as Many") Task Cards

Recording sheet · Grade 4 · Solve each comparison problem. Use the bar models to help.

Scan to check your answers

Name: _____ Date: _____

1	2	3	4
5	6	7	8
9	10	11	12
13	14	15	16
17	18	19	20
21	22	23	24

Multiplicative Comparison ("Times as Many") Task Cards: Answer Key

Grade 4 · Easy

The answers online

1. 2	**2.** 15	**3.** 36
4. 5	**5.** 3	**6.** 12
7. 12	**8.** 2	**9.** 2
10. 8	**11.** 15	**12.** 4
13. 5	**14.** 9	**15.** 12
16. 5	**17.** 6	**18.** 24
19. 5	**20.** 7	**21.** 7
22. 24	**23.** 4	**24.** 6