Multiplicative Comparison ("Times as Many") · 1

Complete the comparison for $40 = 4 \times 10$: 40 is ___ times as many as 10.

Multiplicative Comparison ("Times as Many") · 2

Zoe has 12 marbles. Ben has 9 times as many marbles as Zoe. How many marbles does Ben have?

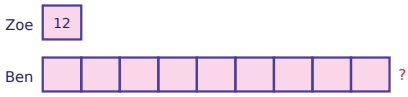

Multiplicative Comparison ("Times as Many") · 3

Ella has 25 marbles. That is 5 times as many as Noah has. How many marbles does Noah have?

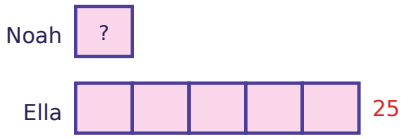

Multiplicative Comparison ("Times as Many") · 4

Ella has 12 books and Noah has 3 books. How many times as many books does Ella have as Noah?

Multiplicative Comparison ("Times as Many") · 5

Complete the comparison for $27 = 3 \times 9$: 27 is ___ times as many as 9.

Multiplicative Comparison ("Times as Many") · 6

Ava has 10 shells. Sam has 2 times as many shells as Ava. How many shells does Sam have?

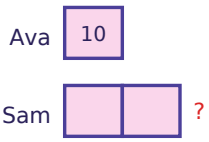

Multiplicative Comparison ("Times as Many") · 7

Omar has 54 cards. That is 9 times as many as Kim has. How many cards does Kim have?

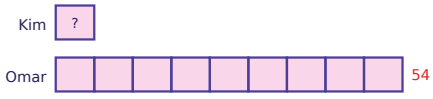

Multiplicative Comparison ("Times as Many") · 8

Ben has 21 stamps and Zoe has 3 stamps. How many times as many stamps does Ben have as Zoe?

Multiplicative Comparison ("Times as Many") · 2

ANSWER

108

Multiplicative Comparison ("Times as Many") · 1

ANSWER

4

Multiplicative Comparison ("Times as Many") · 4

ANSWER

4

Multiplicative Comparison ("Times as Many") · 3

ANSWER

5

Multiplicative Comparison ("Times as Many") · 6

ANSWER

20

Multiplicative Comparison ("Times as Many") · 5

ANSWER

3

Multiplicative Comparison ("Times as Many") · 8

ANSWER

7

Multiplicative Comparison ("Times as Many") · 7

ANSWER

6

Multiplicative Comparison ("Times as Many") · 9

Zoe has 2 stamps. Ben has 3 times as many stamps as Zoe. How many stamps does Ben have?

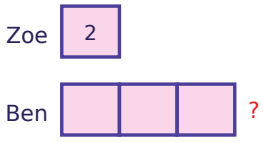

Multiplicative Comparison ("Times as Many") · 10

Ben has 63 coins. That is 7 times as many as Zoe has. How many coins does Zoe have?

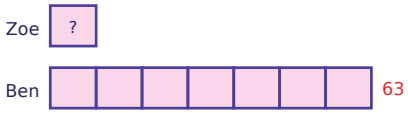

Multiplicative Comparison ("Times as Many") · 11

Jack has 12 stickers and Lily has 6 stickers. How many times as many stickers does Jack have as Lily?

Multiplicative Comparison ("Times as Many") · 12

Zoe has 10 stickers. Ben has 2 times as many. How many more stickers does Ben have than Zoe?

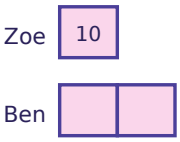

Multiplicative Comparison ("Times as Many") · 13

Zoe has 6 marbles. Ben has 8 times as many marbles as Zoe. How many marbles does Ben have?

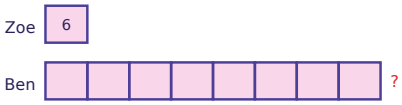

Multiplicative Comparison ("Times as Many") · 14

Ben has 15 shells. That is 3 times as many as Zoe has. How many shells does Zoe have?

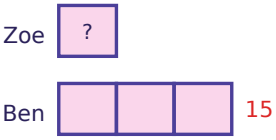

Multiplicative Comparison ("Times as Many") · 15

Sam has 15 shells and Ava has 3 shells. How many times as many shells does Sam have as Ava?

Multiplicative Comparison ("Times as Many") · 16

Lily has 3 pencils. Jack has 8 times as many. How many more pencils does Jack have than Lily?

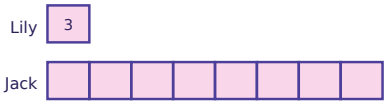

Multiplicative Comparison ("Times as Many") · 10

ANSWER

9

Multiplicative Comparison ("Times as Many") · 9

ANSWER

6

Multiplicative Comparison ("Times as Many") · 12

ANSWER

10

Multiplicative Comparison ("Times as Many") · 11

ANSWER

2

Multiplicative Comparison ("Times as Many") · 14

ANSWER

5

Multiplicative Comparison ("Times as Many") · 13

ANSWER

48

Multiplicative Comparison ("Times as Many") · 16

ANSWER

21

Multiplicative Comparison ("Times as Many") · 15

ANSWER

5

Multiplicative Comparison ("Times as Many") · 17

Mia has 18 books. Leo has 7 times as many books as Mia. How many books does Leo have?

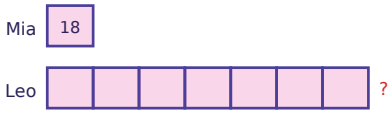

Multiplicative Comparison ("Times as Many") · 18

Jack has 168 marbles. That is 7 times as many as Lily has. How many marbles does Lily have?

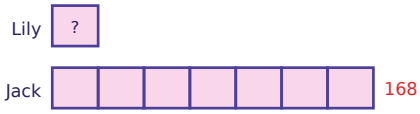

Multiplicative Comparison ("Times as Many") · 19

Ella has 39 coins and Noah has 13 coins. How many times as many coins does Ella have as Noah?

Multiplicative Comparison ("Times as Many") · 20

Kim has 9 pencils. Omar has 8 times as many. How many more pencils does Omar have than Kim?

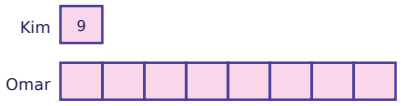

Multiplicative Comparison ("Times as Many") · 21

Noah has 23 shells. Ella has 9 times as many shells as Noah. How many shells does Ella have?

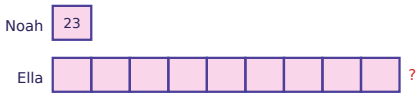

Multiplicative Comparison ("Times as Many") · 22

Jack has 168 pencils. That is 7 times as many as Lily has. How many pencils does Lily have?

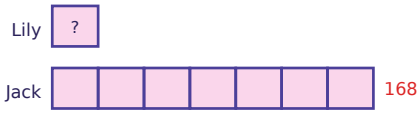

Multiplicative Comparison ("Times as Many") · 23

Ben has 176 marbles and Zoe has 22 marbles. How many times as many marbles does Ben have as Zoe?

Multiplicative Comparison ("Times as Many") · 24

Mia has 16 cards. Leo has 5 times as many. How many more cards does Leo have than Mia?

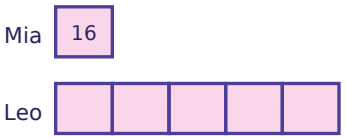

Multiplicative Comparison ("Times as Many") · 18

ANSWER

24

Multiplicative Comparison ("Times as Many") · 17

ANSWER

126

Multiplicative Comparison ("Times as Many") · 20

ANSWER

63

Multiplicative Comparison ("Times as Many") · 19

ANSWER

3

Multiplicative Comparison ("Times as Many") · 22

ANSWER

24

Multiplicative Comparison ("Times as Many") · 21

ANSWER

207

Multiplicative Comparison ("Times as Many") · 24

ANSWER

64

Multiplicative Comparison ("Times as Many") · 23

ANSWER

8