Multiplicative Comparison ("Times as Many") · 1

Lily has 2 stamps. Jack has 6 times as many stamps as Lily. How many stamps does Jack have?

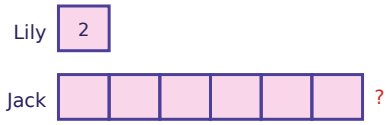

Multiplicative Comparison ("Times as Many") · 2

Omar has 133 stamps. That is 7 times as many as Kim has. How many stamps does Kim have?

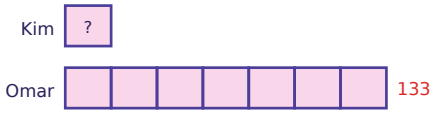

Multiplicative Comparison ("Times as Many") · 3

Ella has 184 marbles and Noah has 23 marbles. How many times as many marbles does Ella have as Noah?

Multiplicative Comparison ("Times as Many") · 4

Mia has 25 stamps. Leo has 7 times as many. How many more stamps does Leo have than Mia?

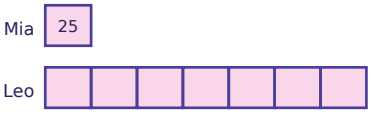

Multiplicative Comparison ("Times as Many") · 5

Lily has 4 stickers. Jack has 3 times as many stickers as Lily. How many stickers does Jack have?

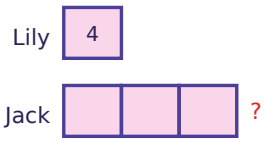

Multiplicative Comparison ("Times as Many") · 6

Omar has 70 stickers. That is 7 times as many as Kim has. How many stickers does Kim have?

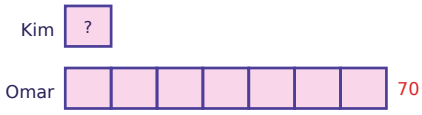

Multiplicative Comparison ("Times as Many") · 7

Ben has 44 marbles and Zoe has 22 marbles. How many times as many marbles does Ben have as Zoe?

Multiplicative Comparison ("Times as Many") · 8

Ava has 8 stamps. Sam has 2 times as many. How many more stamps does Sam have than Ava?

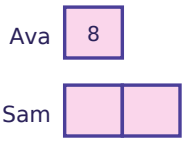

Multiplicative Comparison ("Times as Many") · 2

ANSWER

19

Multiplicative Comparison ("Times as Many") · 1

ANSWER

12

Multiplicative Comparison ("Times as Many") · 4

ANSWER

150

Multiplicative Comparison ("Times as Many") · 3

ANSWER

8

Multiplicative Comparison ("Times as Many") · 6

ANSWER

10

Multiplicative Comparison ("Times as Many") · 5

ANSWER

12

Multiplicative Comparison ("Times as Many") · 8

ANSWER

8

Multiplicative Comparison ("Times as Many") · 7

ANSWER

2

Multiplicative Comparison ("Times as Many") · 9

Kim has 22 books. Omar has 5 times as many books as Kim. How many books does Omar have?

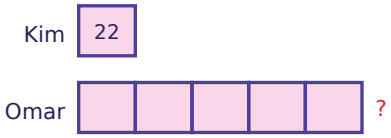

Multiplicative Comparison ("Times as Many") · 10

Ben has 162 cards. That is 9 times as many as Zoe has. How many cards does Zoe have?

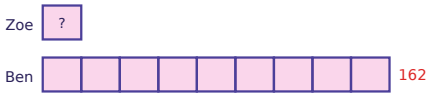

Multiplicative Comparison ("Times as Many") · 11

Leo has 91 pencils and Mia has 13 pencils. How many times as many pencils does Leo have as Mia?

Multiplicative Comparison ("Times as Many") · 12

Lily has 8 cards. Jack has 4 times as many. How many more cards does Jack have than Lily?

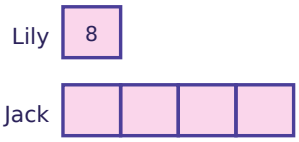

Multiplicative Comparison ("Times as Many") · 13

Zoe has 10 shells. Ben has 9 times as many shells as Zoe. How many shells does Ben have?

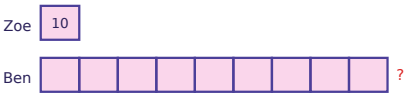

Multiplicative Comparison ("Times as Many") · 14

Leo has 64 stickers. That is 8 times as many as Mia has. How many stickers does Mia have?



Multiplicative Comparison ("Times as Many") · 15

Jack has 12 marbles and Lily has 2 marbles. How many times as many marbles does Jack have as Lily?

Multiplicative Comparison ("Times as Many") · 16

Zoe has 6 stickers. Ben has 6 times as many. How many more stickers does Ben have than Zoe?

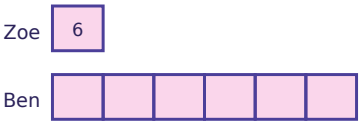

Multiplicative Comparison ("Times as Many") · 10

ANSWER

18

Multiplicative Comparison ("Times as Many") · 9

ANSWER

110

Multiplicative Comparison ("Times as Many") · 12

ANSWER

24

Multiplicative Comparison ("Times as Many") · 11

ANSWER

7

Multiplicative Comparison ("Times as Many") · 14

ANSWER

8

Multiplicative Comparison ("Times as Many") · 13

ANSWER

90

Multiplicative Comparison ("Times as Many") · 16

ANSWER

30

Multiplicative Comparison ("Times as Many") · 15

ANSWER

6

Multiplicative Comparison ("Times as Many") · 17

Noah has 24 pencils. Ella has 6 times as many pencils as Noah. How many pencils does Ella have?

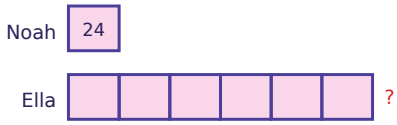

Multiplicative Comparison ("Times as Many") · 18

Sam has 120 books. That is 5 times as many as Ava has. How many books does Ava have?

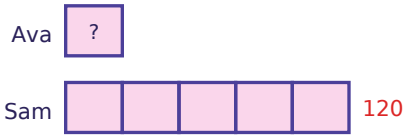

Multiplicative Comparison ("Times as Many") · 19

Leo has 81 stamps and Mia has 9 stamps. How many times as many stamps does Leo have as Mia?

Multiplicative Comparison ("Times as Many") · 20

Kim has 14 stamps. Omar has 6 times as many. How many more stamps does Omar have than Kim?

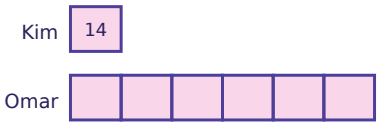

Multiplicative Comparison ("Times as Many") · 21

Mia has 25 stickers. Leo has 8 times as many stickers as Mia. How many stickers does Leo have?



Multiplicative Comparison ("Times as Many") · 22

Sam has 68 stamps. That is 4 times as many as Ava has. How many stamps does Ava have?

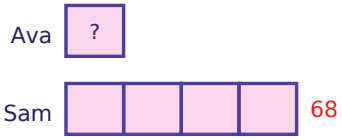

Multiplicative Comparison ("Times as Many") · 23

Omar has 36 shells and Kim has 12 shells. How many times as many shells does Omar have as Kim?

Multiplicative Comparison ("Times as Many") · 24

Noah has 17 marbles. Ella has 3 times as many. How many more marbles does Ella have than Noah?

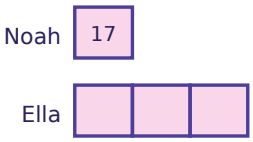

Multiplicative Comparison ("Times as Many") · 18

ANSWER

24

Multiplicative Comparison ("Times as Many") · 17

ANSWER

144

Multiplicative Comparison ("Times as Many") · 20

ANSWER

70

Multiplicative Comparison ("Times as Many") · 19

ANSWER

9

Multiplicative Comparison ("Times as Many") · 22

ANSWER

17

Multiplicative Comparison ("Times as Many") · 21

ANSWER

200

Multiplicative Comparison ("Times as Many") · 24

ANSWER

34

Multiplicative Comparison ("Times as Many") · 23

ANSWER

3