Multiplicative Comparison ("Times as Many") · 1

Complete the comparison for $6 = 2 \times 3$: 6 is ___ times as many as 3.

Multiplicative Comparison ("Times as Many") · 2

Zoe has 5 pencils. Ben has 3 times as many pencils as Zoe. How many pencils does Ben have?

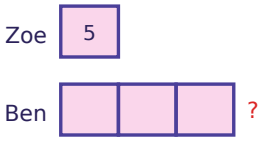

Multiplicative Comparison ("Times as Many") · 3

Ava has 9 books. Sam has 4 times as many books as Ava. How many books does Sam have?

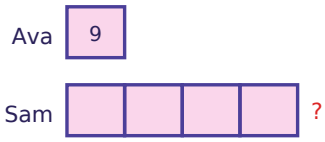

Multiplicative Comparison ("Times as Many") · 4

Complete the comparison for $10 = 5 \times 2$: 10 is ___ times as many as 2.

Multiplicative Comparison ("Times as Many") · 5

Complete the comparison for $27 = 3 \times 9$: 27 is ___ times as many as 9.

Multiplicative Comparison ("Times as Many") · 6

Noah has 4 books. Ella has 3 times as many books as Noah. How many books does Ella have?

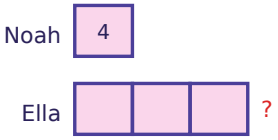

Multiplicative Comparison ("Times as Many") · 7

Zoe has 3 books. Ben has 4 times as many books as Zoe. How many books does Ben have?

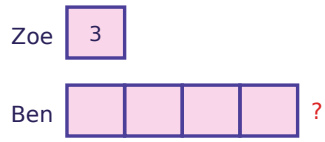

Multiplicative Comparison ("Times as Many") · 8

Complete the comparison for $16 = 2 \times 8$: 16 is ___ times as many as 8.

Multiplicative Comparison ("Times as Many") · 2

ANSWER

15

Multiplicative Comparison ("Times as Many") · 1

ANSWER

2

Multiplicative Comparison ("Times as Many") · 4

ANSWER

5

Multiplicative Comparison ("Times as Many") · 3

ANSWER

36

Multiplicative Comparison ("Times as Many") · 6

ANSWER

12

Multiplicative Comparison ("Times as Many") · 5

ANSWER

3

Multiplicative Comparison ("Times as Many") · 8

ANSWER

2

Multiplicative Comparison ("Times as Many") · 7

ANSWER

12

Multiplicative Comparison ("Times as Many") · 9

Complete the comparison for $14 = 2 \times 7$: 14 is ___ times as many as 7.

Multiplicative Comparison ("Times as Many") · 10

Lily has 2 pencils. Jack has 4 times as many pencils as Lily. How many pencils does Jack have?

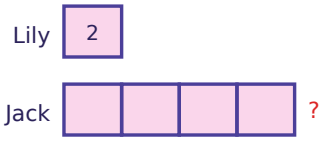

Multiplicative Comparison ("Times as Many") · 11

Lily has 5 stickers. Jack has 3 times as many stickers as Lily. How many stickers does Jack have?

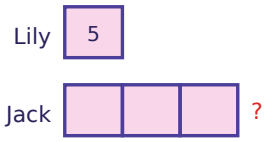

Multiplicative Comparison ("Times as Many") · 12

Complete the comparison for $20 = 4 \times 5$: 20 is ___ times as many as 5.

Multiplicative Comparison ("Times as Many") · 13

Complete the comparison for $45 = 5 \times 9$: 45 is ___ times as many as 9.

Multiplicative Comparison ("Times as Many") · 14

Zoe has 3 pencils. Ben has 3 times as many pencils as Zoe. How many pencils does Ben have?

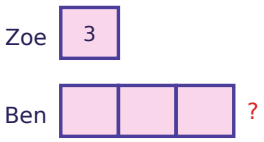

Multiplicative Comparison ("Times as Many") · 15

Zoe has 3 marbles. Ben has 4 times as many marbles as Zoe. How many marbles does Ben have?

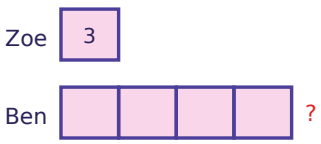

Multiplicative Comparison ("Times as Many") · 16

Complete the comparison for $20 = 5 \times 4$: 20 is ___ times as many as 4.

Multiplicative Comparison ("Times as Many") · 10

ANSWER

8

Multiplicative Comparison ("Times as Many") · 9

ANSWER

2

Multiplicative Comparison ("Times as Many") · 12

ANSWER

4

Multiplicative Comparison ("Times as Many") · 11

ANSWER

15

Multiplicative Comparison ("Times as Many") · 14

ANSWER

9

Multiplicative Comparison ("Times as Many") · 13

ANSWER

5

Multiplicative Comparison ("Times as Many") · 16

ANSWER

5

Multiplicative Comparison ("Times as Many") · 15

ANSWER

12

Multiplicative Comparison ("Times as Many") · 17

Complete the comparison for 42 = 6 × 7: 42 is ___ times as many as 7.

Multiplicative Comparison ("Times as Many") · 18

Zoe has 8 coins. Ben has 3 times as many coins as Zoe. How many coins does Ben have?

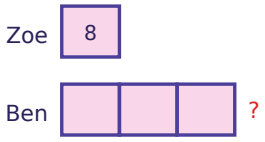

Multiplicative Comparison ("Times as Many") · 19

Omar has 20 pencils. That is 4 times as many as Kim has. How many pencils does Kim have?

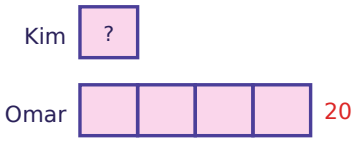

Multiplicative Comparison ("Times as Many") · 20

Ben has 42 books and Zoe has 6 books. How many times as many books does Ben have as Zoe?

Multiplicative Comparison ("Times as Many") · 21

Complete the comparison for 42 = 7 × 6: 42 is ___ times as many as 6.

Multiplicative Comparison ("Times as Many") · 22

Zoe has 3 cards. Ben has 8 times as many cards as Zoe. How many cards does Ben have?

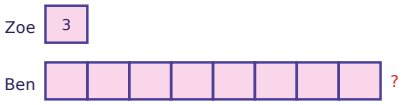

Multiplicative Comparison ("Times as Many") · 23

Sam has 36 marbles. That is 9 times as many as Ava has. How many marbles does Ava have?

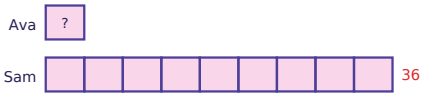

Multiplicative Comparison ("Times as Many") · 24

Jack has 42 stickers and Lily has 7 stickers. How many times as many stickers does Jack have as Lily?

Multiplicative Comparison ("Times as Many") · 18

ANSWER

24

Multiplicative Comparison ("Times as Many") · 17

ANSWER

6

Multiplicative Comparison ("Times as Many") · 20

ANSWER

7

Multiplicative Comparison ("Times as Many") · 19

ANSWER

5

Multiplicative Comparison ("Times as Many") · 22

ANSWER

24

Multiplicative Comparison ("Times as Many") · 21

ANSWER

7

Multiplicative Comparison ("Times as Many") · 24

ANSWER

6

Multiplicative Comparison ("Times as Many") · 23

ANSWER

4