Task card 1 Line Plots with Fractions

How many pencils have a length of $4\frac{1}{2}$ inches?

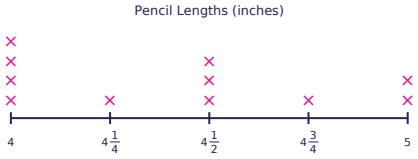

Task card 2 Line Plots with Fractions

How many puppies are heavier than $3\frac{1}{4}$ pounds?

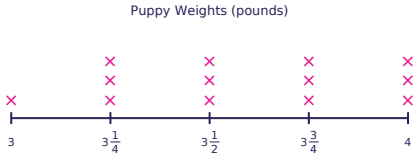

Task card 3 Line Plots with Fractions

What is the difference between the greatest and the least weight, in pounds?

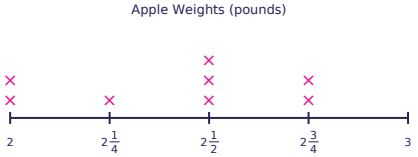

Task card 4 Line Plots with Fractions

Which length did the most pencils have? (Answer in inches.)

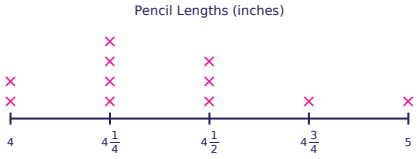

Task card 5 Line Plots with Fractions

How many ribbons have a length of 4 feet?

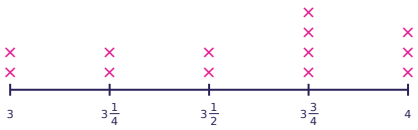

Task card 6 Line Plots with Fractions

How many pencils are longer than 3 inches?

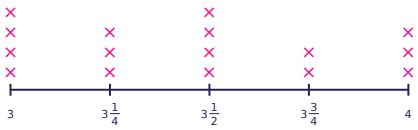

Task card 7 Line Plots with Fractions

What is the difference between the greatest and the least length, in inches?

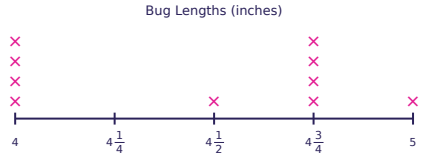

Task card 8 Line Plots with Fractions

Which weight did the most apples have? (Answer in pounds.)

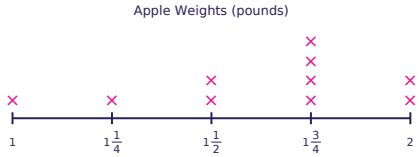

Task card 9 Line Plots with Fractions

What is the difference between the greatest and the least weight, in pounds?



Task card 10 Line Plots with Fractions

How many puppies are heavier than $2\frac{1}{4}$ pounds?



Task card 11 Line Plots with Fractions

What is the difference between the greatest and the least weight, in pounds?



Task card 12 Line Plots with Fractions

How many puppies have a weight of $1\frac{1}{2}$ pounds?

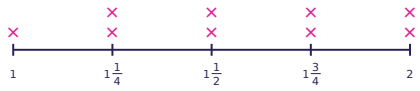

Task card 13 Line Plots with Fractions

What is the difference between the greatest and the least weight, in pounds?

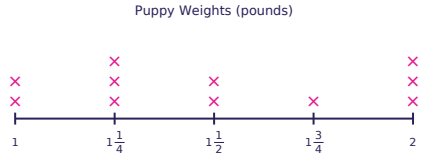

Task card 14 Line Plots with Fractions

What is the difference between the greatest and the least weight, in pounds?

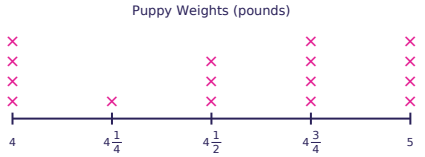

Task card 15 Line Plots with Fractions

Look at the bugs that have a length of 1 inch. What is their total length, in inches?

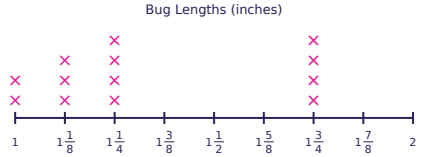

Task card 16 Line Plots with Fractions

How many ribbons are longer than $4\frac{1}{4}$ feet?

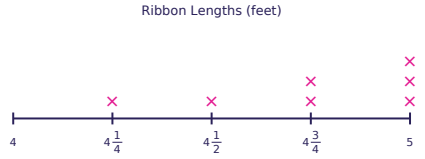

Task card 17 Line Plots with Fractions

What is the difference between the greatest and the least weight, in pounds?

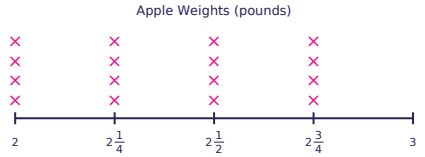

Task card 18 Line Plots with Fractions

Look at the ribbons that have a length of 2 feet. What is their total length, in feet?

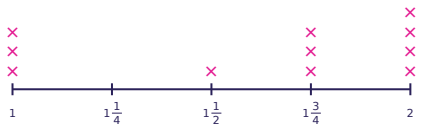

Task card 19 Line Plots with Fractions

How many pencils have a length of 3 inches?

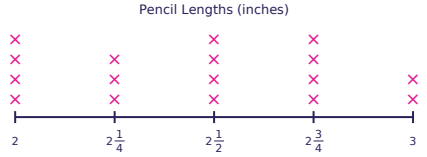

Task card 20 Line Plots with Fractions

What is the difference between the greatest and the least length, in feet?

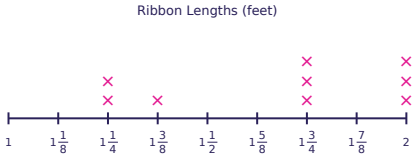

Task card 21 Line Plots with Fractions

How many apples have a weight of 3 pounds?

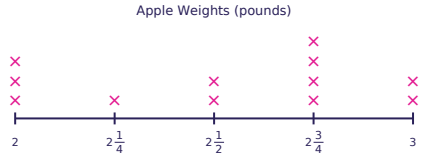

Task card 22 Line Plots with Fractions

How many puppies are heavier than 4 pounds?

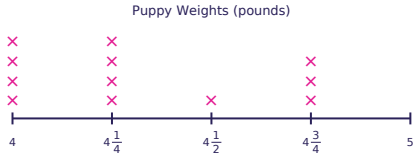

Task card 23 Line Plots with Fractions

What is the difference between the greatest and the least length, in feet?

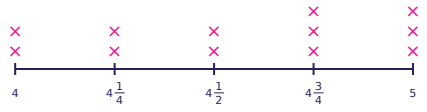

Task card 24 Line Plots with Fractions

Which length did the most ribbons have? (Answer in feet.)

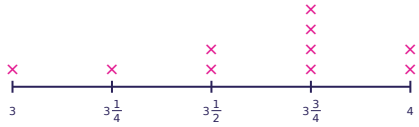

Line Plots with Fractions Task Cards

Recording sheet · Grade 4 · Use the line plot to answer each question. Each × stands for one item. Write fractions in simplest form.

Name: _____ Date: _____

Scan to check your answers

1	2	3	4
5	6	7	8
9	10	11	12
13	14	15	16
17	18	19	20
21	22	23	24

Line Plots with Fractions Task Cards: Answer Key

Grade 4 · Medium

The answers online

1. 3	**2.** 9	**3.** $\frac{3}{4}$
4. $4\frac{1}{4}$	**5.** 3	**6.** 12
7. 1	**8.** $1\frac{3}{4}$	**9.** $\frac{1}{2}$
10. 6	**11.** $\frac{7}{8}$	**12.** 2
13. 1	**14.** 1	**15.** 2
16. 6	**17.** $\frac{3}{4}$	**18.** 8
19. 2	**20.** $\frac{3}{4}$	**21.** 2
22. 8	**23.** 1	**24.** $3\frac{3}{4}$