Task card 1 Line Plots with Fractions

What is the difference between the greatest and the least length, in inches?

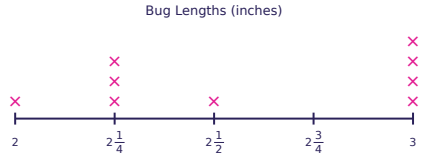

Task card 2 Line Plots with Fractions

How many pencils are longer than $1\frac{3}{4}$ inches?

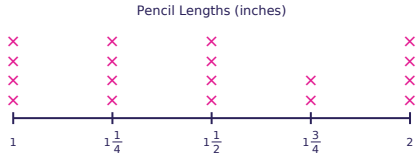

Task card 3 Line Plots with Fractions

What is the difference between the greatest and the least weight, in pounds?

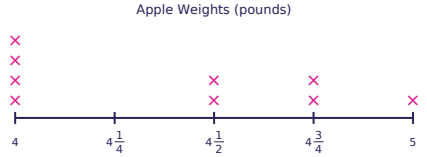

Task card 4 Line Plots with Fractions

Look at the puppies that have a weight of 5 pounds. What is their total weight, in pounds?



Task card 5 Line Plots with Fractions

How many ribbons have a length of $4\frac{1}{8}$ feet?

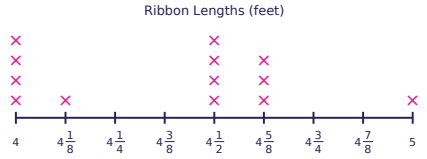

Task card 6 Line Plots with Fractions

What is the difference between the greatest and the least length, in inches?



Task card 7 Line Plots with Fractions

Look at the pencils that have a length of 2 inches. What is their total length, in inches?

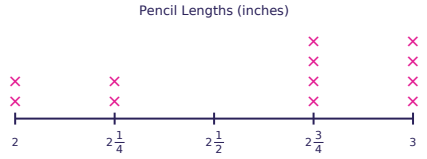

Task card 8 Line Plots with Fractions

What is the difference between the greatest and the least length, in inches?

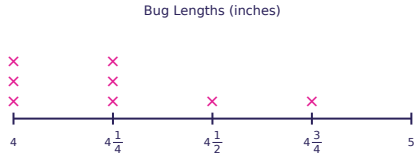

Task card 9 Line Plots with Fractions

Look at the apples that have a weight of 2 pounds. What is their total weight, in pounds?

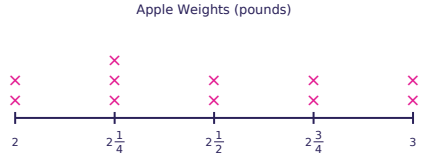

Task card 10 Line Plots with Fractions

How many apples are heavier than $1\frac{1}{4}$ pounds?

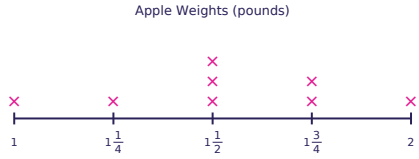

Task card 11 Line Plots with Fractions

What is the difference between the greatest and the least length, in inches?

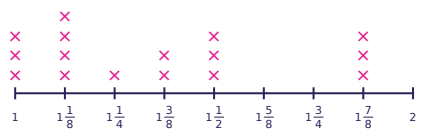

Task card 12 Line Plots with Fractions

How many apples have a weight of $2\frac{1}{8}$ pounds?



Task card 13 Line Plots with Fractions

What is the difference between the greatest and the least length, in inches?

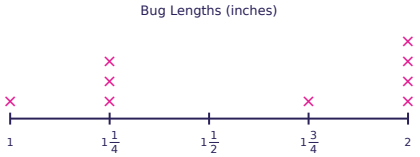

Task card 14 Line Plots with Fractions

What is the difference between the greatest and the least length, in inches?

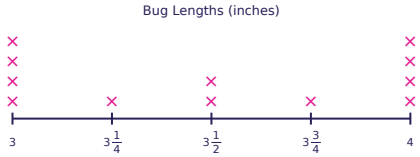

Task card 15 Line Plots with Fractions

How many ribbons are longer than $2\frac{1}{4}$ feet?

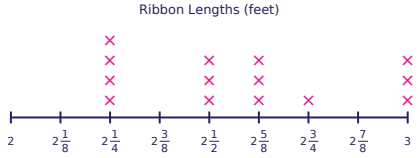

Task card 16 Line Plots with Fractions

What is the difference between the greatest and the least weight, in pounds?



Task card 17 Line Plots with Fractions

How many pencils have a length of $1\frac{1}{4}$ inches?

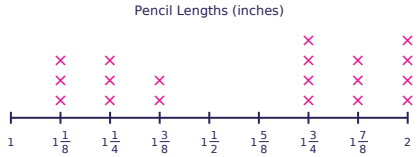

Task card 18 Line Plots with Fractions

What is the difference between the greatest and the least weight, in pounds?



Task card 19 Line Plots with Fractions

What is the difference between the greatest and the least length, in feet?

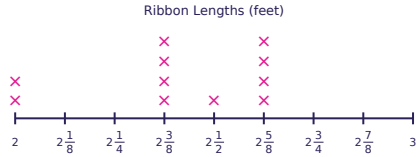

Task card 20 Line Plots with Fractions

How many apples are heavier than $3\frac{1}{8}$ pounds?



Task card 21 Line Plots with Fractions

What is the difference between the greatest and the least weight, in pounds?

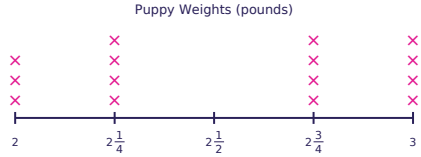

Task card 22 Line Plots with Fractions

How many pencils have a length of 4 inches?

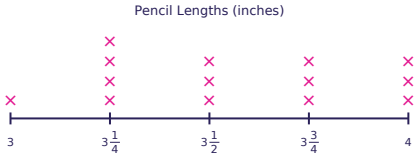

Task card 23 Line Plots with Fractions

What is the difference between the greatest and the least weight, in pounds?

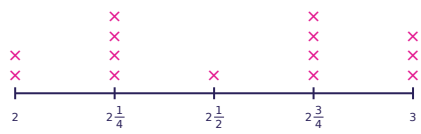

Task card 24 Line Plots with Fractions

What is the difference between the greatest and the least length, in feet?

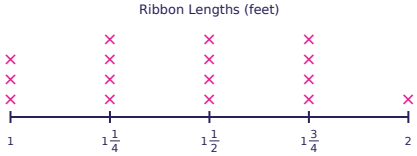

Line Plots with Fractions Task Cards

Recording sheet · Grade 4 · Use the line plot to answer each question. Each × stands for one item. Write fractions in simplest form.

Name: _____ Date: _____

Scan to check your answers

1	2	3	4
5	6	7	8
9	10	11	12
13	14	15	16
17	18	19	20
21	22	23	24

Line Plots with Fractions Task Cards: Answer Key

Grade 4 · Hard

The answers online

1. 1	**2.** 4	**3.** 1
4. 20	**5.** 1	**6.** $\frac{3}{4}$
7. 4	**8.** $\frac{3}{4}$	**9.** 4
10. 6	**11.** $\frac{7}{8}$	**12.** 2
13. 1	**14.** 1	**15.** 10
16. $\frac{7}{8}$	**17.** 3	**18.** 1
19. $\frac{5}{8}$	**20.** 9	**21.** 1
22. 3	**23.** 1	**24.** 1