Line Plots with Fractions · 1

How many pencils have a length of $4\frac{1}{2}$ inches?

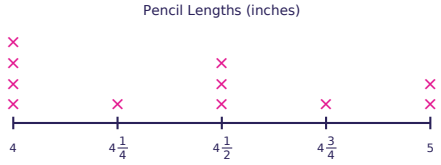

Line Plots with Fractions · 2

How many puppies are heavier than $3\frac{1}{4}$ pounds?

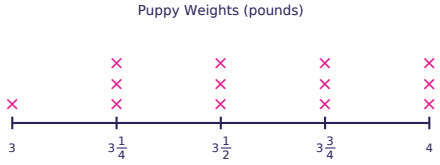

Line Plots with Fractions · 3

What is the difference between the greatest and the least weight, in pounds?

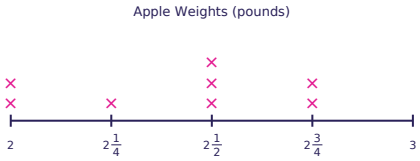

Line Plots with Fractions · 4

Which length did the most pencils have? (Answer in inches.)

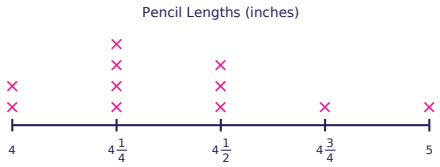

Line Plots with Fractions · 5

How many ribbons have a length of 4 feet?

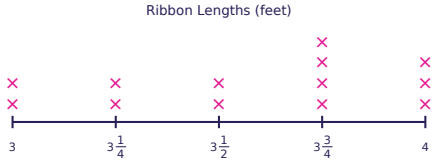

Line Plots with Fractions · 6

How many pencils are longer than 3 inches?

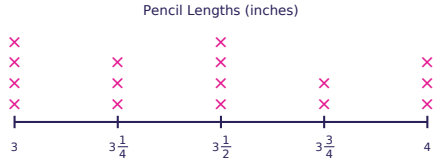

Line Plots with Fractions · 7

What is the difference between the greatest and the least length, in inches?

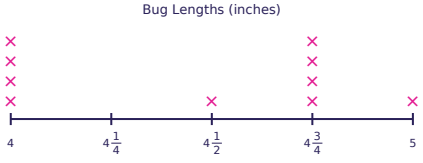

Line Plots with Fractions · 8

Which weight did the most apples have? (Answer in pounds.)

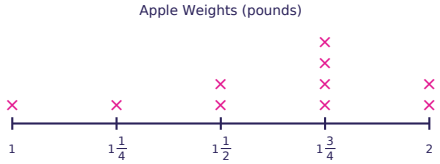

Line Plots with Fractions · 2

ANSWER

9

Line Plots with Fractions · 1

ANSWER

3

Line Plots with Fractions · 4

ANSWER

$4\frac{1}{4}$

Line Plots with Fractions · 3

ANSWER

$\frac{3}{4}$

Line Plots with Fractions · 6

ANSWER

12

Line Plots with Fractions · 5

ANSWER

3

Line Plots with Fractions · 8

ANSWER

$1\frac{3}{4}$

Line Plots with Fractions · 7

ANSWER

1

Line Plots with Fractions · 9

What is the difference between the greatest and the least weight, in pounds?



Line Plots with Fractions · 10

How many puppies are heavier than $2\frac{1}{4}$ pounds?



Line Plots with Fractions · 11

What is the difference between the greatest and the least weight, in pounds?



Line Plots with Fractions · 12

How many puppies have a weight of $1\frac{1}{2}$ pounds?

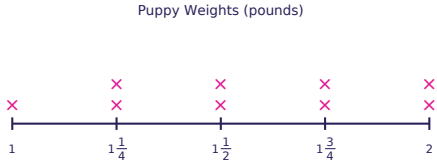

Line Plots with Fractions · 13

What is the difference between the greatest and the least weight, in pounds?

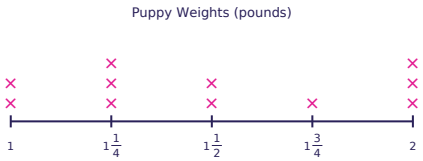

Line Plots with Fractions · 14

What is the difference between the greatest and the least weight, in pounds?

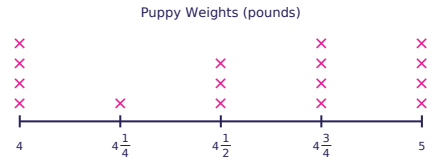

Line Plots with Fractions · 15

Look at the bugs that have a length of 1 inch. What is their total length, in inches?

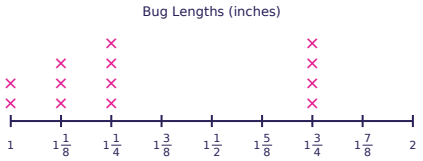

Line Plots with Fractions · 16

How many ribbons are longer than $4\frac{1}{4}$ feet?

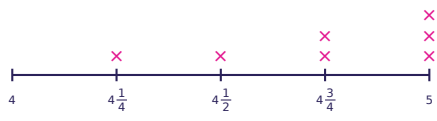

Line Plots with Fractions · 10

ANSWER

6

Line Plots with Fractions · 9

ANSWER

$\frac{1}{2}$

Line Plots with Fractions · 12

ANSWER

2

Line Plots with Fractions · 11

ANSWER

$\frac{7}{8}$

Line Plots with Fractions · 14

ANSWER

1

Line Plots with Fractions · 13

ANSWER

1

Line Plots with Fractions · 16

ANSWER

6

Line Plots with Fractions · 15

ANSWER

2

Line Plots with Fractions · 17

What is the difference between the greatest and the least weight, in pounds?

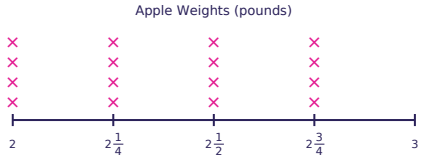

Line Plots with Fractions · 18

Look at the ribbons that have a length of 2 feet. What is their total length, in feet?

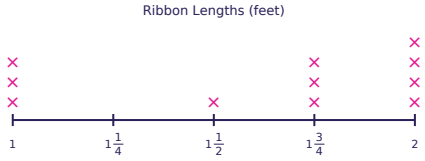

Line Plots with Fractions · 19

How many pencils have a length of 3 inches?

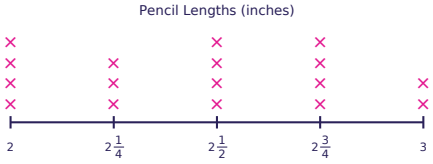

Line Plots with Fractions · 20

What is the difference between the greatest and the least length, in feet?

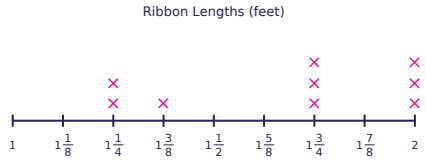

Line Plots with Fractions · 21

How many apples have a weight of 3 pounds?

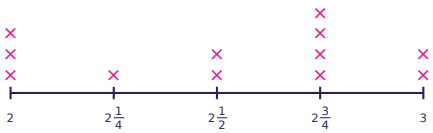

Line Plots with Fractions · 22

How many puppies are heavier than 4 pounds?

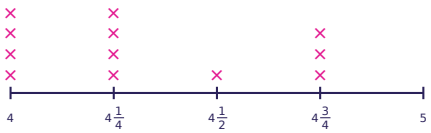

Line Plots with Fractions · 23

What is the difference between the greatest and the least length, in feet?

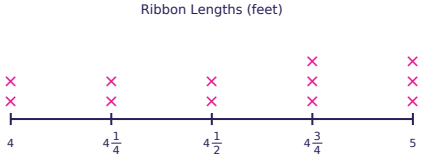

Line Plots with Fractions · 24

Which length did the most ribbons have? (Answer in feet.)

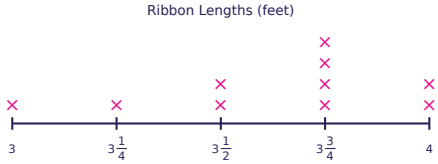

Line Plots with Fractions · 18

ANSWER

8

Line Plots with Fractions · 17

ANSWER

$\frac{3}{4}$

Line Plots with Fractions · 20

ANSWER

$\frac{3}{4}$

Line Plots with Fractions · 19

ANSWER

2

Line Plots with Fractions · 22

ANSWER

8

Line Plots with Fractions · 21

ANSWER

2

Line Plots with Fractions · 24

ANSWER

$3\frac{3}{4}$

Line Plots with Fractions · 23

ANSWER

1