Line Plots with Fractions · 1

What is the difference between the greatest and the least length, in inches?

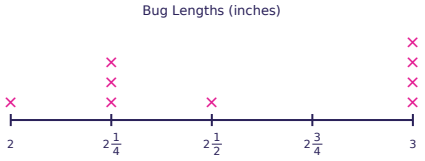

Line Plots with Fractions · 2

How many pencils are longer than $1\frac{3}{4}$ inches?

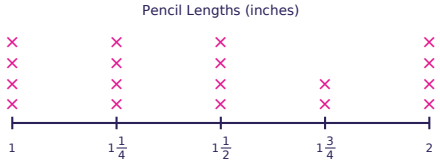

Line Plots with Fractions · 3

What is the difference between the greatest and the least weight, in pounds?

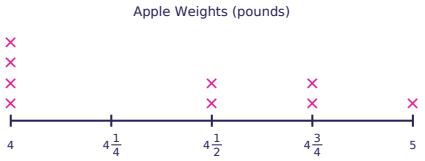

Line Plots with Fractions · 4

Look at the puppies that have a weight of 5 pounds. What is their total weight, in pounds?



Line Plots with Fractions · 5

How many ribbons have a length of $4\frac{1}{8}$ feet?

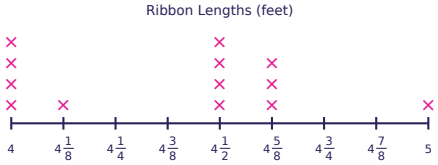

Line Plots with Fractions · 6

What is the difference between the greatest and the least length, in inches?

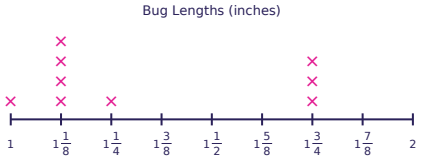

Line Plots with Fractions · 7

Look at the pencils that have a length of 2 inches. What is their total length, in inches?

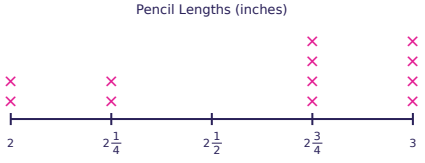

Line Plots with Fractions · 8

What is the difference between the greatest and the least length, in inches?

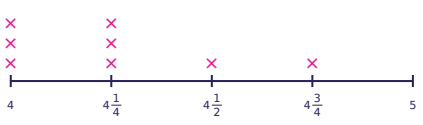

Line Plots with Fractions · 2

ANSWER

4

Line Plots with Fractions · 1

ANSWER

1

Line Plots with Fractions · 4

ANSWER

20

Line Plots with Fractions · 3

ANSWER

1

Line Plots with Fractions · 6

ANSWER

$\frac{3}{4}$

Line Plots with Fractions · 5

ANSWER

1

Line Plots with Fractions · 8

ANSWER

$\frac{3}{4}$

Line Plots with Fractions · 7

ANSWER

4

Line Plots with Fractions · 9

Look at the apples that have a weight of 2 pounds. What is their total weight, in pounds?

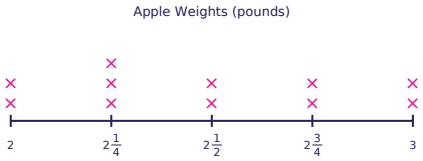

Line Plots with Fractions · 10

How many apples are heavier than $1\frac{1}{4}$ pounds?

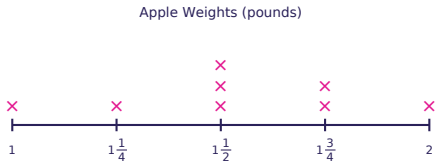

Line Plots with Fractions · 11

What is the difference between the greatest and the least length, in inches?



Line Plots with Fractions · 12

How many apples have a weight of $2\frac{1}{8}$ pounds?



Line Plots with Fractions · 13

What is the difference between the greatest and the least length, in inches?

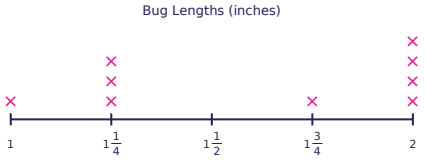

Line Plots with Fractions · 14

What is the difference between the greatest and the least length, in inches?

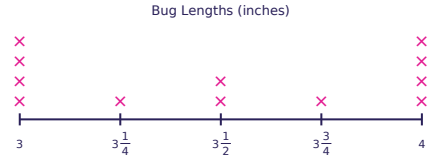

Line Plots with Fractions · 15

How many ribbons are longer than $2\frac{1}{4}$ feet?

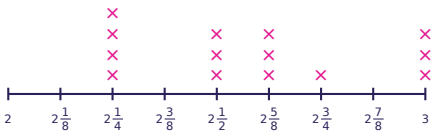

Line Plots with Fractions · 16

What is the difference between the greatest and the least weight, in pounds?

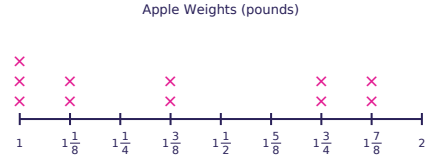

Line Plots with Fractions · 10

ANSWER

6

Line Plots with Fractions · 9

ANSWER

4

Line Plots with Fractions · 12

ANSWER

2

Line Plots with Fractions · 11

ANSWER

$\frac{7}{8}$

Line Plots with Fractions · 14

ANSWER

1

Line Plots with Fractions · 13

ANSWER

1

Line Plots with Fractions · 16

ANSWER

$\frac{7}{8}$

Line Plots with Fractions · 15

ANSWER

10

Line Plots with Fractions · 17

How many pencils have a length of $1\frac{1}{4}$ inches?

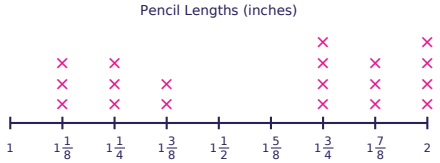

Line Plots with Fractions · 18

What is the difference between the greatest and the least weight, in pounds?



Line Plots with Fractions · 19

What is the difference between the greatest and the least length, in feet?

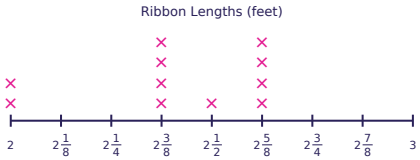

Line Plots with Fractions · 20

How many apples are heavier than $3\frac{1}{8}$ pounds?



Line Plots with Fractions · 21

What is the difference between the greatest and the least weight, in pounds?

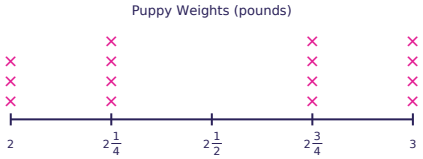

Line Plots with Fractions · 22

How many pencils have a length of 4 inches?

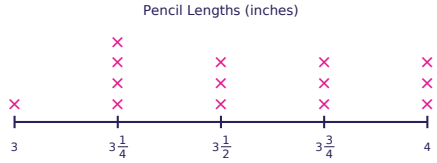

Line Plots with Fractions · 23

What is the difference between the greatest and the least weight, in pounds?

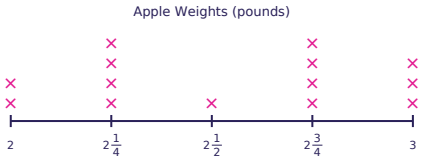

Line Plots with Fractions · 24

What is the difference between the greatest and the least length, in feet?

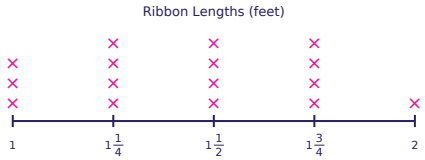

Line Plots with Fractions · 18

ANSWER

1

Line Plots with Fractions · 17

ANSWER

3

Line Plots with Fractions · 20

ANSWER

9

Line Plots with Fractions · 19

ANSWER

$\frac{5}{8}$

Line Plots with Fractions · 22

ANSWER

3

Line Plots with Fractions · 21

ANSWER

1

Line Plots with Fractions · 24

ANSWER

1

Line Plots with Fractions · 23

ANSWER

1