Line Plots with Fractions · 1

How many apples have a weight of 2 pounds?

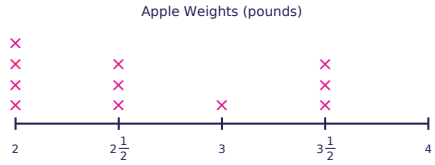

Line Plots with Fractions · 2

Which length did the most ribbons have? (Answer in feet.)

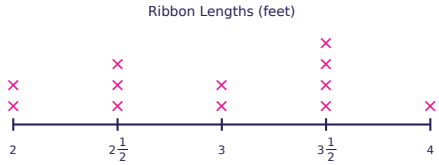

Line Plots with Fractions · 3

How many bugs have a length of $2\frac{1}{2}$ inches?

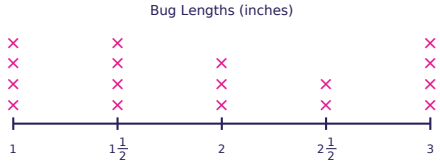

Line Plots with Fractions · 4

How many apples are heavier than $1\frac{3}{4}$ pounds?

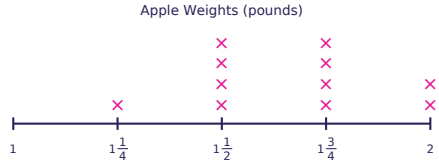

Line Plots with Fractions · 5

How many ribbons have a length of $1\frac{1}{2}$ feet?

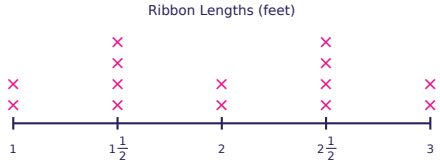

Line Plots with Fractions · 6

Which weight did the most puppies have? (Answer in pounds.)

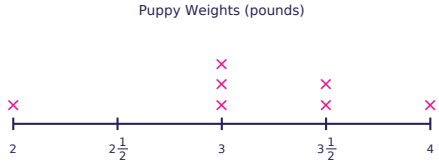

Line Plots with Fractions · 7

How many ribbons have a length of 3 feet?

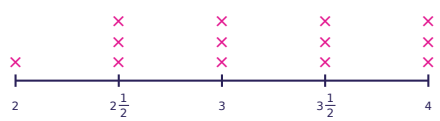

Line Plots with Fractions · 8

How many pencils are longer than 2 inches?

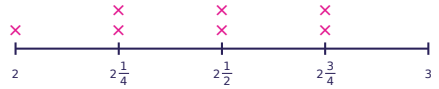

Line Plots with Fractions · 2

ANSWER

$3\frac{1}{2}$

Line Plots with Fractions · 1

ANSWER

4

Line Plots with Fractions · 4

ANSWER

2

Line Plots with Fractions · 3

ANSWER

2

Line Plots with Fractions · 6

ANSWER

3

Line Plots with Fractions · 5

ANSWER

4

Line Plots with Fractions · 8

ANSWER

6

Line Plots with Fractions · 7

ANSWER

3

Line Plots with Fractions · 9

How many bugs have a length of 2 inches?

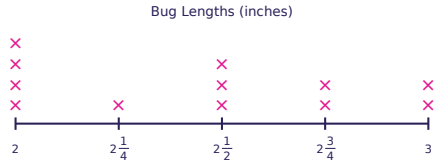

Line Plots with Fractions · 10

Which weight did the most puppies have? (Answer in pounds.)

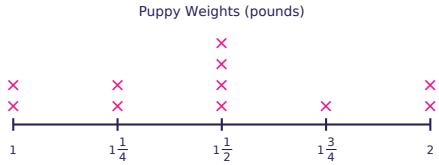

Line Plots with Fractions · 11

How many puppies have a weight of 1 $\frac{1}{4}$ pounds?

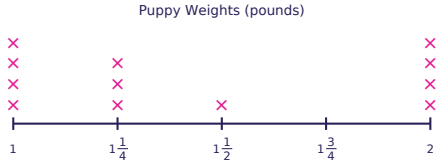

Line Plots with Fractions · 12

How many pencils are longer than 2 $\frac{1}{2}$ inches?

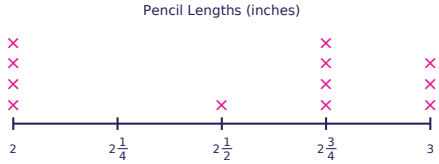

Line Plots with Fractions · 13

How many apples have a weight of 2 pounds?

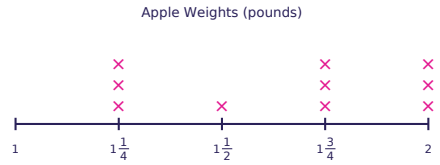

Line Plots with Fractions · 14

Which length did the most pencils have? (Answer in inches.)

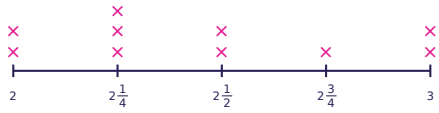

Line Plots with Fractions · 15

How many apples have a weight of 1 $\frac{1}{4}$ pounds?



Line Plots with Fractions · 16

How many apples are heavier than 2 pounds?

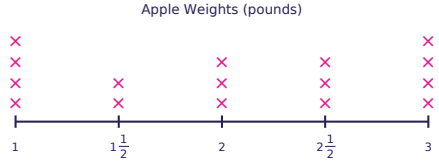

Line Plots with Fractions · 10

ANSWER

$1\frac{1}{2}$

Line Plots with Fractions · 9

ANSWER

4

Line Plots with Fractions · 12

ANSWER

7

Line Plots with Fractions · 11

ANSWER

3

Line Plots with Fractions · 14

ANSWER

$2\frac{1}{4}$

Line Plots with Fractions · 13

ANSWER

3

Line Plots with Fractions · 16

ANSWER

7

Line Plots with Fractions · 15

ANSWER

4

Line Plots with Fractions · 17

How many puppies have a weight of 5 pounds?

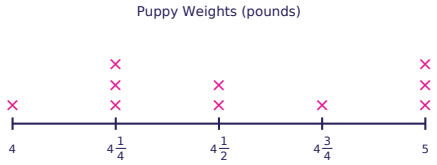

Line Plots with Fractions · 18

How many apples are heavier than 3 pounds?



Line Plots with Fractions · 19

What is the difference between the greatest and the least length, in inches?

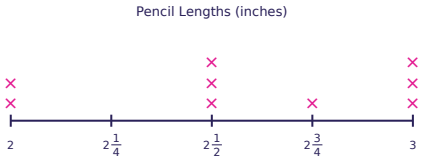

Line Plots with Fractions · 20

Which weight did the most apples have? (Answer in pounds.)

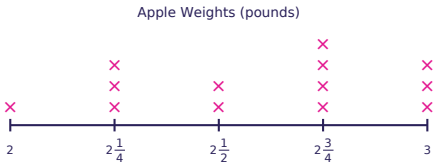

Line Plots with Fractions · 21

How many apples have a weight of 3 pounds?

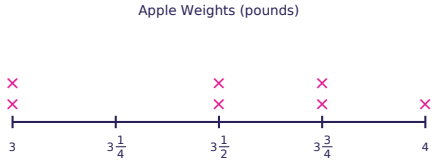

Line Plots with Fractions · 22

How many bugs are longer than $4\frac{1}{2}$ inches?

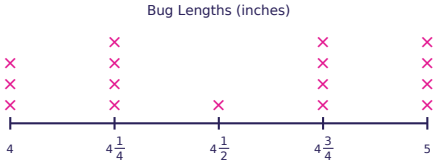

Line Plots with Fractions · 23

What is the difference between the greatest and the least weight, in pounds?

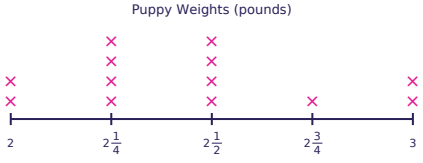

Line Plots with Fractions · 24

Which weight did the most puppies have? (Answer in pounds.)

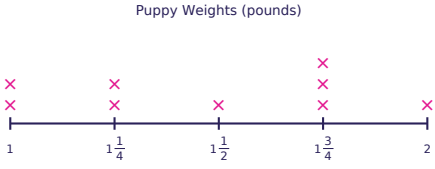

Line Plots with Fractions · 18

ANSWER

7

Line Plots with Fractions · 17

ANSWER

3

Line Plots with Fractions · 20

ANSWER

$2\frac{3}{4}$

Line Plots with Fractions · 19

ANSWER

1

Line Plots with Fractions · 22

ANSWER

8

Line Plots with Fractions · 21

ANSWER

2

Line Plots with Fractions · 24

ANSWER

$1\frac{3}{4}$

Line Plots with Fractions · 23

ANSWER

1