Task card 1 Halloween Math

Noah hangs orange lights all the way around a rectangular porch that is 9 feet long and 2 feet wide. How many feet of lights does Noah need?



Task card 2 Halloween Math

There are 59 pumpkin muffins. Each treat bag holds 5. After filling as many treat bags as possible, how many pumpkin muffins are left over?

Task card 3 Halloween Math

Each treat bag holds 5 pumpkin muffins. The bakery fills 56 treat bags. How many pumpkin muffins is that?

Task card 4 Halloween Math

Ella eats $\frac{1}{9}$ of a pumpkin cake. Sam eats $\frac{6}{9}$ of it. What fraction of the pumpkin cake did they eat together?

Task card 5 Halloween Math

Each treat bag holds 7 pumpkin muffins. The bakery fills 17 treat bags. How many pumpkin muffins is that?

Task card 6 Halloween Math

Lily eats $\frac{5}{8}$ of a pumpkin cake. Sam eats $\frac{2}{8}$ of it. What fraction of the pumpkin cake did they eat together?

Task card 7 Halloween Math

There are 13 cupcakes. Each treat bag holds 3. How many treat bags can be filled all the way?

Task card 8 Halloween Math

Zoe hangs orange lights all the way around a rectangular porch that is 9 feet long and 4 feet wide. How many feet of lights does Zoe need?



Task card 9 Halloween Math

Mia hangs orange lights all the way around a rectangular porch that is 7 feet long and 4 feet wide. How many feet of lights does Mia need?

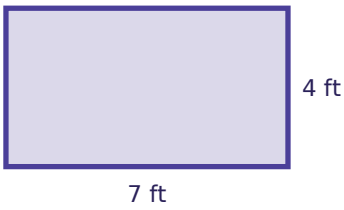

Task card 10 Halloween Math

Leo eats $\frac{5}{12}$ of a pumpkin cake. Sam eats $\frac{6}{12}$ of it. What fraction of the pumpkin cake did they eat together?

Task card 11 Halloween Math

There are 82 spider cookies. Each treat bag holds 8. How many treat bags can be filled all the way?

Task card 12 Halloween Math

Each treat bag holds 8 spider cookies. The bakery fills 45 treat bags. How many spider cookies is that?

Task card 13 Halloween Math

Lily eats $\frac{3}{10}$ of a pumpkin cake. Zoe eats $\frac{4}{10}$ of it. What fraction of the pumpkin cake did they eat together?

Task card 14 Halloween Math

Sam hangs orange lights all the way around a rectangular porch that is 9 feet long and 7 feet wide. How many feet of lights does Sam need?

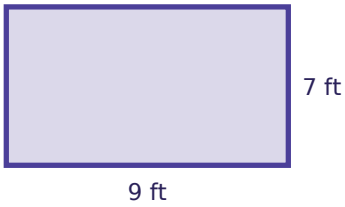

Task card 15 Halloween Math

Each treat bag holds 6 spider cookies. The bakery fills 13 treat bags. How many spider cookies is that?

Task card 16 Halloween Math

There are 83 pumpkin muffins. Each treat bag holds 8. After filling as many treat bags as possible, how many pumpkin muffins are left over?

Task card 17 Halloween Math

Ava hangs orange lights all the way around a rectangular porch that is 8 feet long and 5 feet wide. How many feet of lights does Ava need?



Task card 18 Halloween Math

Each treat bag holds 16 cupcakes. The bakery fills 14 treat bags. How many cupcakes is that?

Task card 19 Halloween Math

Lily eats $\frac{2}{10}$ of a pumpkin cake. Noah eats $\frac{1}{10}$ of it. What fraction of the pumpkin cake did they eat together?

Task card 20 Halloween Math

Noah hangs orange lights all the way around a rectangular porch that is 8 feet long and 3 feet wide. How many feet of lights does Noah need?

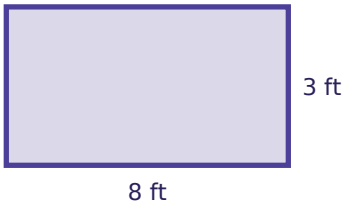

Task card 21 Halloween Math

There are 18 pumpkin muffins. Each treat bag holds 4. After filling as many treat bags as possible, how many pumpkin muffins are left over?

Task card 22 Halloween Math

There are 133 pumpkin muffins. Each treat bag holds 9. After filling as many treat bags as possible, how many pumpkin muffins are left over?

Task card 23 Halloween Math

Noah eats $\frac{2}{9}$ of a pumpkin cake. Sam eats $\frac{2}{9}$ of it. What fraction of the pumpkin cake did they eat together?

Task card 24 Halloween Math

Each treat bag holds 12 pumpkin muffins. The bakery fills 25 treat bags. How many pumpkin muffins is that?

Halloween Math Task Cards

Recording sheet · Grade 4 · Read each story and solve.

Name: _____ Date: _____

Scan to check your answers

1	2	3	4
5	6	7	8
9	10	11	12
13	14	15	16
17	18	19	20
21	22	23	24

Halloween Math Task Cards: Answer Key

Grade 4 · Medium

The answers online

1. 22	**2.** 4	**3.** 280
4. $\frac{7}{9}$	**5.** 119	**6.** $\frac{7}{8}$
7. 4	**8.** 26	**9.** 22
10. $\frac{11}{12}$	**11.** 10	**12.** 360
13. $\frac{7}{10}$	**14.** 32	**15.** 78
16. 3	**17.** 26	**18.** 224
19. $\frac{3}{10}$	**20.** 22	**21.** 2
22. 7	**23.** $\frac{4}{9}$	**24.** 300