Task card 1 Halloween Math

There are 44 spider cookies. Each treat bag holds 3. How many treat bags can be filled all the way?

Task card 2 Halloween Math

Omar hangs orange lights all the way around a rectangular porch that is 4 feet long and 3 feet wide. How many feet of lights does Omar need?

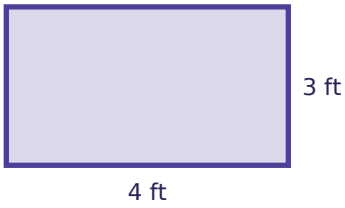

Task card 3 Halloween Math

Noah eats $\frac{2}{8}$ of a pumpkin cake. Ella eats $\frac{5}{8}$ of it. What fraction of the pumpkin cake did they eat together?

Task card 4 Halloween Math

Noah hangs orange lights all the way around a rectangular porch that is 10 feet long and 7 feet wide. How many feet of lights does Noah need?

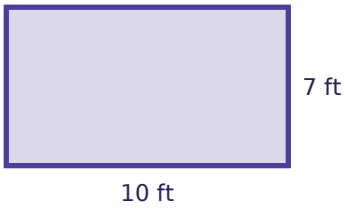

Task card 5 Halloween Math

Each treat bag holds 12 spider cookies. The bakery fills 89 treat bags. How many spider cookies is that?

Task card 6 Halloween Math

Omar eats $\frac{1}{12}$ of a pumpkin cake. Noah eats $\frac{4}{12}$ of it. What fraction of the pumpkin cake did they eat together?

Task card 7 Halloween Math

Each treat bag holds 16 pumpkin muffins. The bakery fills 48 treat bags. How many pumpkin muffins is that?

Task card 8 Halloween Math

There are 44 pumpkin muffins. Each treat bag holds 7. After filling as many treat bags as possible, how many pumpkin muffins are left over?

Task card 9 Halloween Math

There are 95 cupcakes. Each treat bag holds 7. After filling as many treat bags as possible, how many cupcakes are left over?

Task card 10 Halloween Math

There are 110 spider cookies. Each treat bag holds 8. How many treat bags can be filled all the way?

Task card 11 Halloween Math

Lily hangs orange lights all the way around a rectangular porch that is 5 feet long and 4 feet wide. How many feet of lights does Lily need?

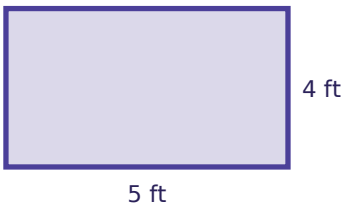

Task card 12 Halloween Math

Each treat bag holds 24 cupcakes. The bakery fills 68 treat bags. How many cupcakes is that?

Task card 13 Halloween Math

Zoe eats $\frac{4}{12}$ of a pumpkin cake. Ben eats $\frac{3}{12}$ of it. What fraction of the pumpkin cake did they eat together?

Task card 14 Halloween Math

Ella hangs orange lights all the way around a rectangular porch that is 6 feet long and 4 feet wide. How many feet of lights does Ella need?

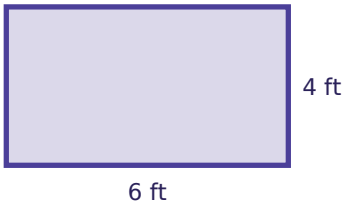

Task card 15 Halloween Math

Ben eats $\frac{1}{8}$ of a pumpkin cake. Ella eats $\frac{2}{8}$ of it. What fraction of the pumpkin cake did they eat together?

Task card 16 Halloween Math

Each treat bag holds 22 cupcakes. The bakery fills 74 treat bags. How many cupcakes is that?

Task card 17 Halloween Math

Each treat bag holds 18 spider cookies. The bakery fills 30 treat bags. How many spider cookies is that?

Task card 18 Halloween Math

There are 115 spider cookies. Each treat bag holds 9. How many treat bags can be filled all the way?

Task card 19 Halloween Math

Omar hangs orange lights all the way around a rectangular porch that is 9 feet long and 7 feet wide. How many feet of lights does Omar need?



Task card 20 Halloween Math

Sam hangs orange lights all the way around a rectangular porch that is 10 feet long and 3 feet wide. How many feet of lights does Sam need?



Task card 21 Halloween Math

Each treat bag holds 22 cupcakes. The bakery fills 19 treat bags. How many cupcakes is that?

Task card 22 Halloween Math

Omar eats $\frac{2}{10}$ of a pumpkin cake. Leo eats $\frac{1}{10}$ of it. What fraction of the pumpkin cake did they eat together?

Task card 23 Halloween Math

There are 65 cupcakes. Each treat bag holds 8. After filling as many treat bags as possible, how many cupcakes are left over?

Task card 24 Halloween Math

Leo eats $\frac{1}{9}$ of a pumpkin cake. Sam eats $\frac{1}{9}$ of it. What fraction of the pumpkin cake did they eat together?

Halloween Math Task Cards

Recording sheet · Grade 4 · Read each story and solve.

Name: _____ Date: _____

Scan to check your answers

1	2	3	4
5	6	7	8
9	10	11	12
13	14	15	16
17	18	19	20
21	22	23	24

Halloween Math Task Cards: Answer Key

Grade 4 · Hard

The answers online

1. 14	**2.** 14	**3.** $\frac{7}{8}$
4. 34	**5.** 1068	**6.** $\frac{5}{12}$
7. 768	**8.** 2	**9.** 4
10. 13	**11.** 18	**12.** 1632
13. $\frac{7}{12}$	**14.** 20	**15.** $\frac{3}{8}$
16. 1628	**17.** 540	**18.** 12
19. 32	**20.** 26	**21.** 418
22. $\frac{3}{10}$	**23.** 1	**24.** $\frac{2}{9}$