Task card 1 Halloween Math

There are 39 spider cookies. Each treat bag holds 6. How many treat bags can be filled all the way?

Task card 2 Halloween Math

Noah hangs orange lights all the way around a rectangular porch that is 7 feet long and 2 feet wide. How many feet of lights does Noah need?

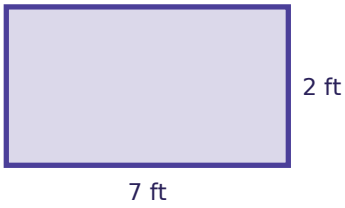

Task card 3 Halloween Math

There are 41 spider cookies. Each treat bag holds 9. How many treat bags can be filled all the way?

Task card 4 Halloween Math

Each treat bag holds 5 cupcakes. The bakery fills 22 treat bags. How many cupcakes is that?

Task card 5 Halloween Math

Leo hangs orange lights all the way around a rectangular porch that is 5 feet long and 2 feet wide. How many feet of lights does Leo need?

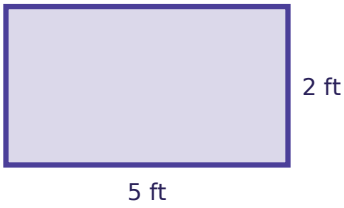

Task card 6 Halloween Math

Lily eats $\frac{2}{7}$ of a pumpkin cake. Mia eats $\frac{2}{7}$ of it. What fraction of the pumpkin cake did they eat together?

Task card 7 Halloween Math

Ava eats $\frac{1}{8}$ of a pumpkin cake. Zoe eats $\frac{2}{8}$ of it. What fraction of the pumpkin cake did they eat together?

Task card 8 Halloween Math

Each treat bag holds 9 pumpkin muffins. The bakery fills 22 treat bags. How many pumpkin muffins is that?

Task card 9 Halloween Math

There are 14 cupcakes. Each treat bag holds 3. How many treat bags can be filled all the way?

Task card 10 Halloween Math

Zoe hangs orange lights all the way around a rectangular porch that is 6 feet long and 4 feet wide. How many feet of lights does Zoe need?

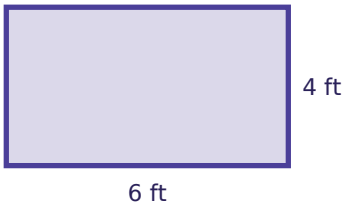

Task card 11 Halloween Math

Sam eats $\frac{2}{7}$ of a pumpkin cake. Noah eats $\frac{2}{7}$ of it. What fraction of the pumpkin cake did they eat together?

Task card 12 Halloween Math

Each treat bag holds 6 spider cookies. The bakery fills 30 treat bags. How many spider cookies is that?

Task card 13 Halloween Math

Each treat bag holds 9 pumpkin muffins. The bakery fills 37 treat bags. How many pumpkin muffins is that?

Task card 14 Halloween Math

Ben hangs orange lights all the way around a rectangular porch that is 8 feet long and 7 feet wide. How many feet of lights does Ben need?

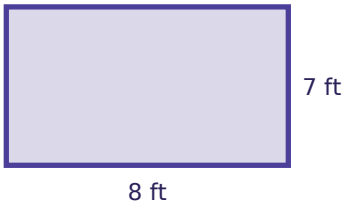

Task card 15 Halloween Math

There are 93 spider cookies. Each treat bag holds 9. After filling as many treat bags as possible, how many spider cookies are left over?

Task card 16 Halloween Math

Sam eats $\frac{3}{8}$ of a pumpkin cake. Ava eats $\frac{2}{8}$ of it. What fraction of the pumpkin cake did they eat together?

Task card 17 Halloween Math

Ella hangs orange lights all the way around a rectangular porch that is 6 feet long and 4 feet wide. How many feet of lights does Ella need?

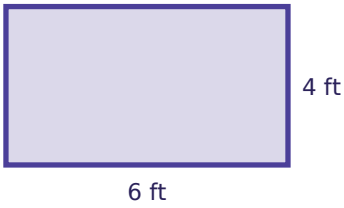

Task card 18 Halloween Math

Ben eats $\frac{1}{8}$ of a pumpkin cake. Noah eats $\frac{4}{8}$ of it. What fraction of the pumpkin cake did they eat together?

Task card 19 Halloween Math

There are 81 pumpkin muffins. Each treat bag holds 7. How many treat bags can be filled all the way?

Task card 20 Halloween Math

There are 20 spider cookies. Each treat bag holds 3. After filling as many treat bags as possible, how many spider cookies are left over?

Task card 21 Halloween Math

Each treat bag holds 9 spider cookies. The bakery fills 47 treat bags. How many spider cookies is that?

Task card 22 Halloween Math

Zoe hangs orange lights all the way around a rectangular porch that is 6 feet long and 2 feet wide. How many feet of lights does Zoe need?

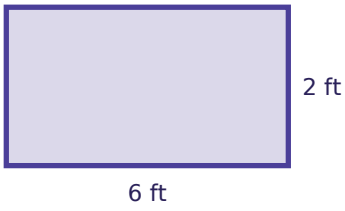

Task card 23 Halloween Math

Ben eats $\frac{2}{8}$ of a pumpkin cake. Ella eats $\frac{5}{8}$ of it. What fraction of the pumpkin cake did they eat together?

Task card 24 Halloween Math

Each treat bag holds 6 cupcakes. The bakery fills 40 treat bags. How many cupcakes is that?

Halloween Math Task Cards

Recording sheet · Grade 4 · Read each story and solve.

Name: _____ Date: _____

Scan to check your answers

1	2	3	4
5	6	7	8
9	10	11	12
13	14	15	16
17	18	19	20
21	22	23	24

Halloween Math Task Cards: Answer Key

Grade 4 · Easy

The answers online

1. 6	**2.** 18	**3.** 4
4. 110	**5.** 14	**6.** $\frac{4}{7}$
7. $\frac{3}{8}$	**8.** 198	**9.** 4
10. 20	**11.** $\frac{4}{7}$	**12.** 180
13. 333	**14.** 30	**15.** 3
16. $\frac{5}{8}$	**17.** 20	**18.** $\frac{5}{8}$
19. 11	**20.** 2	**21.** 423
22. 16	**23.** $\frac{7}{8}$	**24.** 240