Halloween Math · 1

Noah hangs orange lights all the way around a rectangular porch that is 9 feet long and 2 feet wide. How many feet of lights does Noah need?

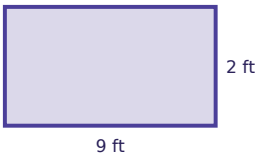

Halloween Math · 2

There are 59 pumpkin muffins. Each treat bag holds 5. After filling as many treat bags as possible, how many pumpkin muffins are left over?

Halloween Math · 3

Each treat bag holds 5 pumpkin muffins. The bakery fills 56 treat bags. How many pumpkin muffins is that?

Halloween Math · 4

Ella eats $\frac{1}{9}$ of a pumpkin cake. Sam eats $\frac{6}{9}$ of it. What fraction of the pumpkin cake did they eat together?

Halloween Math · 5

Each treat bag holds 7 pumpkin muffins. The bakery fills 17 treat bags. How many pumpkin muffins is that?

Halloween Math · 6

Lily eats $\frac{5}{8}$ of a pumpkin cake. Sam eats $\frac{2}{8}$ of it. What fraction of the pumpkin cake did they eat together?

Halloween Math · 7

There are 13 cupcakes. Each treat bag holds 3. How many treat bags can be filled all the way?

Halloween Math · 8

Zoe hangs orange lights all the way around a rectangular porch that is 9 feet long and 4 feet wide. How many feet of lights does Zoe need?

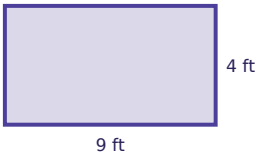

Halloween Math · 2

ANSWER

4

Halloween Math · 1

ANSWER

22

Halloween Math · 4

ANSWER

$$\frac{7}{9}$$

Halloween Math · 3

ANSWER

280

Halloween Math · 6

ANSWER

$$\frac{7}{8}$$

Halloween Math · 5

ANSWER

119

Halloween Math · 8

ANSWER

26

Halloween Math · 7

ANSWER

4

Halloween Math · 9

Mia hangs orange lights all the way around a rectangular porch that is 7 feet long and 4 feet wide. How many feet of lights does Mia need?

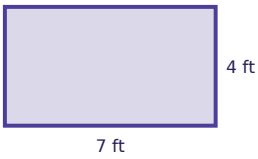

Halloween Math · 10

Leo eats $\frac{5}{12}$ of a pumpkin cake. Sam eats $\frac{6}{12}$ of it. What fraction of the pumpkin cake did they eat together?

Halloween Math · 11

There are 82 spider cookies. Each treat bag holds 8. How many treat bags can be filled all the way?

Halloween Math · 12

Each treat bag holds 8 spider cookies. The bakery fills 45 treat bags. How many spider cookies is that?

Halloween Math · 13

Lily eats $\frac{3}{10}$ of a pumpkin cake. Zoe eats $\frac{4}{10}$ of it. What fraction of the pumpkin cake did they eat together?

Halloween Math · 14

Sam hangs orange lights all the way around a rectangular porch that is 9 feet long and 7 feet wide. How many feet of lights does Sam need?

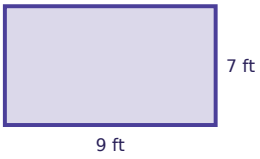

Halloween Math · 15

Each treat bag holds 6 spider cookies. The bakery fills 13 treat bags. How many spider cookies is that?

Halloween Math · 16

There are 83 pumpkin muffins. Each treat bag holds 8. After filling as many treat bags as possible, how many pumpkin muffins are left over?

Halloween Math · 10

ANSWER

$\frac{11}{12}$

Halloween Math · 9

ANSWER

22

Halloween Math · 12

ANSWER

360

Halloween Math · 11

ANSWER

10

Halloween Math · 14

ANSWER

32

Halloween Math · 13

ANSWER

$\frac{7}{10}$

Halloween Math · 16

ANSWER

3

Halloween Math · 15

ANSWER

78

Halloween Math · 17

Ava hangs orange lights all the way around a rectangular porch that is 8 feet long and 5 feet wide. How many feet of lights does Ava need?

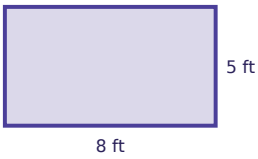

Halloween Math · 18

Each treat bag holds 16 cupcakes. The bakery fills 14 treat bags. How many cupcakes is that?

Halloween Math · 19

Lily eats $\frac{2}{10}$ of a pumpkin cake. Noah eats $\frac{1}{10}$ of it. What fraction of the pumpkin cake did they eat together?

Halloween Math · 20

Noah hangs orange lights all the way around a rectangular porch that is 8 feet long and 3 feet wide. How many feet of lights does Noah need?

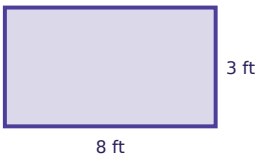

Halloween Math · 21

There are 18 pumpkin muffins. Each treat bag holds 4. After filling as many treat bags as possible, how many pumpkin muffins are left over?

Halloween Math · 22

There are 133 pumpkin muffins. Each treat bag holds 9. After filling as many treat bags as possible, how many pumpkin muffins are left over?

Halloween Math · 23

Noah eats $\frac{2}{9}$ of a pumpkin cake. Sam eats $\frac{2}{9}$ of it. What fraction of the pumpkin cake did they eat together?

Halloween Math · 24

Each treat bag holds 12 pumpkin muffins. The bakery fills 25 treat bags. How many pumpkin muffins is that?

Halloween Math · 18

ANSWER

224

Halloween Math · 17

ANSWER

26

Halloween Math · 20

ANSWER

22

Halloween Math · 19

ANSWER

$$\frac{3}{10}$$

Halloween Math · 22

ANSWER

7

Halloween Math · 21

ANSWER

2

Halloween Math · 24

ANSWER

300

Halloween Math · 23

ANSWER

$$\frac{4}{9}$$