Halloween Math · 1

There are 39 spider cookies. Each treat bag holds 6. How many treat bags can be filled all the way?

Halloween Math · 2

Noah hangs orange lights all the way around a rectangular porch that is 7 feet long and 2 feet wide. How many feet of lights does Noah need?

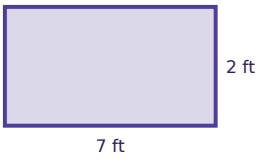

Halloween Math · 3

There are 41 spider cookies. Each treat bag holds 9. How many treat bags can be filled all the way?

Halloween Math · 4

Each treat bag holds 5 cupcakes. The bakery fills 22 treat bags. How many cupcakes is that?

Halloween Math · 5

Leo hangs orange lights all the way around a rectangular porch that is 5 feet long and 2 feet wide. How many feet of lights does Leo need?



Halloween Math · 6

Lily eats $\frac{2}{7}$ of a pumpkin cake. Mia eats $\frac{2}{7}$ of it. What fraction of the pumpkin cake did they eat together?

Halloween Math · 7

Ava eats $\frac{1}{8}$ of a pumpkin cake. Zoe eats $\frac{2}{8}$ of it. What fraction of the pumpkin cake did they eat together?

Halloween Math · 8

Each treat bag holds 9 pumpkin muffins. The bakery fills 22 treat bags. How many pumpkin muffins is that?

Halloween Math · 2

ANSWER

18

Halloween Math · 1

ANSWER

6

Halloween Math · 4

ANSWER

110

Halloween Math · 3

ANSWER

4

Halloween Math · 6

ANSWER

$$\frac{4}{7}$$

Halloween Math · 5

ANSWER

14

Halloween Math · 8

ANSWER

198

Halloween Math · 7

ANSWER

$$\frac{3}{8}$$

Halloween Math · 9

There are 14 cupcakes. Each treat bag holds 3. How many treat bags can be filled all the way?

Halloween Math · 10

Zoe hangs orange lights all the way around a rectangular porch that is 6 feet long and 4 feet wide. How many feet of lights does Zoe need?

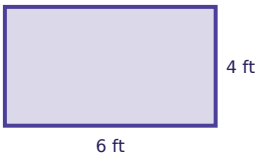

Halloween Math · 11

Sam eats $\frac{2}{7}$ of a pumpkin cake. Noah eats $\frac{2}{7}$ of it. What fraction of the pumpkin cake did they eat together?

Halloween Math · 12

Each treat bag holds 6 spider cookies. The bakery fills 30 treat bags. How many spider cookies is that?

Halloween Math · 13

Each treat bag holds 9 pumpkin muffins. The bakery fills 37 treat bags. How many pumpkin muffins is that?

Halloween Math · 14

Ben hangs orange lights all the way around a rectangular porch that is 8 feet long and 7 feet wide. How many feet of lights does Ben need?

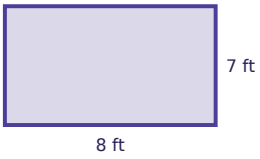

Halloween Math · 15

There are 93 spider cookies. Each treat bag holds 9. After filling as many treat bags as possible, how many spider cookies are left over?

Halloween Math · 16

Sam eats $\frac{3}{8}$ of a pumpkin cake. Ava eats $\frac{2}{8}$ of it. What fraction of the pumpkin cake did they eat together?

Halloween Math · 10

ANSWER

20

Halloween Math · 9

ANSWER

4

Halloween Math · 12

ANSWER

180

Halloween Math · 11

ANSWER

$$\frac{4}{7}$$

Halloween Math · 14

ANSWER

30

Halloween Math · 13

ANSWER

333

Halloween Math · 16

ANSWER

$$\frac{5}{8}$$

Halloween Math · 15

ANSWER

3

Halloween Math · 17

Ella hangs orange lights all the way around a rectangular porch that is 6 feet long and 4 feet wide. How many feet of lights does Ella need?

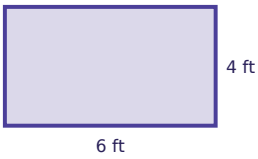

Halloween Math · 18

Ben eats $\frac{1}{8}$ of a pumpkin cake. Noah eats $\frac{4}{8}$ of it. What fraction of the pumpkin cake did they eat together?

Halloween Math · 19

There are 81 pumpkin muffins. Each treat bag holds 7. How many treat bags can be filled all the way?

Halloween Math · 20

There are 20 spider cookies. Each treat bag holds 3. After filling as many treat bags as possible, how many spider cookies are left over?

Halloween Math · 21

Each treat bag holds 9 spider cookies. The bakery fills 47 treat bags. How many spider cookies is that?

Halloween Math · 22

Zoe hangs orange lights all the way around a rectangular porch that is 6 feet long and 2 feet wide. How many feet of lights does Zoe need?

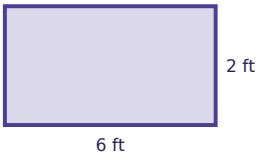

Halloween Math · 23

Ben eats $\frac{2}{8}$ of a pumpkin cake. Ella eats $\frac{5}{8}$ of it. What fraction of the pumpkin cake did they eat together?

Halloween Math · 24

Each treat bag holds 6 cupcakes. The bakery fills 40 treat bags. How many cupcakes is that?

Halloween Math · 18

ANSWER

$\frac{5}{8}$

Halloween Math · 17

ANSWER

20

Halloween Math · 20

ANSWER

2

Halloween Math · 19

ANSWER

11

Halloween Math · 22

ANSWER

16

Halloween Math · 21

ANSWER

423

Halloween Math · 24

ANSWER

240

Halloween Math · 23

ANSWER

$\frac{7}{8}$