Task card 1 Fraction Equivalence

$$\frac{1}{3} = \frac{\quad}{6}$$

Task card 2 Fraction Equivalence

$$\frac{1}{4} = \frac{\quad}{8}$$

Task card 3 Fraction Equivalence

The bars are the same length. $\frac{3}{4} = \frac{\quad}{8}$

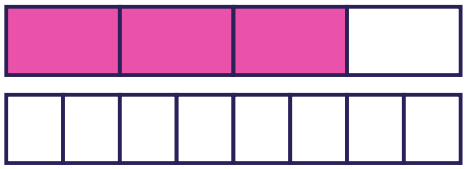

Task card 4 Fraction Equivalence

Both bars show the same amount. Count the parts of the second bar: $\frac{2}{3} = \frac{4}{\quad}$

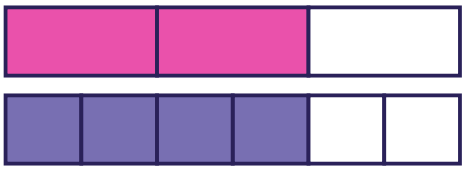

Task card 5 Fraction Equivalence

$$\frac{2}{5} = \frac{4}{\quad}$$

Task card 6 Fraction Equivalence

$\frac{4}{5} = \frac{8}{10}$. The top and the bottom were both multiplied by ___

Task card 7 Fraction Equivalence

Divide the top and the bottom by the same number: $\frac{2}{4} = \frac{__}{2}$

Task card 8 Fraction Equivalence

Lily eats $\frac{2}{4}$ of a pie. Sam has a pie of the same size cut into 8 equal pieces. How many pieces must Sam eat to eat the same amount?

Task card 9 Fraction Equivalence

$$\frac{2}{6} = \frac{__}{12}$$

Task card 10 Fraction Equivalence

$$\frac{1}{3} = \frac{__}{9}$$

Task card 11 Fraction Equivalence

The bars are the same length. $\frac{4}{6} = \frac{__}{18}$

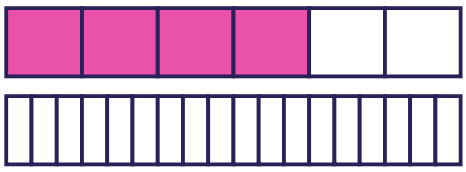

Task card 12 Fraction Equivalence

Both bars show the same amount. Count the parts of the second bar: $\frac{1}{6} = \frac{2}{__}$

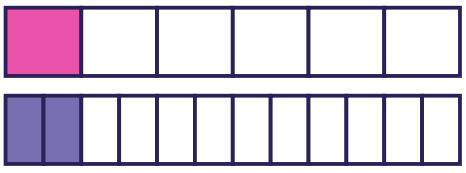

Task card 13 Fraction Equivalence

$$\frac{3}{6} = \frac{9}{___}$$

Task card 14 Fraction Equivalence

$\frac{4}{6} = \frac{8}{12}$. The top and the bottom were both multiplied by ___

Task card 15 Fraction Equivalence

Divide the top and the bottom by the same number: $\frac{4}{8} = \frac{__}{4}$

Task card 16 Fraction Equivalence

Mia eats $\frac{3}{4}$ of a pizza. Zoe has a pizza of the same size cut into 8 equal slices. How many slices must Zoe eat to eat the same amount?

Task card 17 Fraction Equivalence

$$\frac{2}{3} = \frac{__}{6}$$

Task card 18 Fraction Equivalence

$$\frac{3}{6} = \frac{__}{18}$$

Task card 19 Fraction Equivalence

The bars are the same length. $\frac{3}{6} = \frac{\quad}{12}$

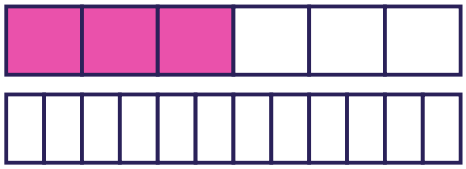

Task card 20 Fraction Equivalence

Both bars show the same amount. Count the parts of the second bar: $\frac{2}{4} = \frac{4}{\quad}$

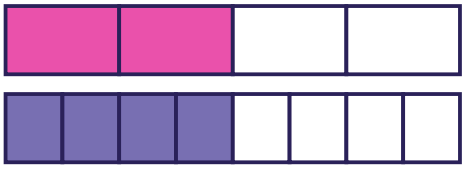

Task card 21 Fraction Equivalence

$$\frac{1}{3} = \frac{2}{\quad}$$

Task card 22 Fraction Equivalence

$\frac{3}{7} = \frac{6}{14}$. The top and the bottom were both multiplied by ___

Task card 23 Fraction Equivalence

Divide the top and the bottom by the same number: $\frac{6}{15} = \frac{\quad}{5}$

Task card 24 Fraction Equivalence

Sam eats $\frac{4}{5}$ of a cake. Ava has a cake of the same size cut into 10 equal pieces. How many pieces must Ava eat to eat the same amount?

Fraction Equivalence Task Cards

Recording sheet · Grade 4 · Find each missing number. The same fractions come in different shapes!

Name: _____ Date: _____

Scan to check your answers

1	2	3	4
5	6	7	8
9	10	11	12
13	14	15	16
17	18	19	20
21	22	23	24

Fraction Equivalence Task Cards: Answer Key

Grade 4 · Easy

The answers online

1. 2	**2.** 2	**3.** 6
4. 6	**5.** 10	**6.** 2
7. 1	**8.** 4	**9.** 4
10. 3	**11.** 12	**12.** 12
13. 18	**14.** 2	**15.** 2
16. 6	**17.** 4	**18.** 9
19. 6	**20.** 8	**21.** 6
22. 2	**23.** 2	**24.** 8