Fraction Equivalence · 1

$$\frac{4}{10} = \frac{\quad}{30}$$

Fraction Equivalence · 2

$$\frac{4}{6} = \frac{\quad}{12}$$

Fraction Equivalence · 3

The bars are the same length. $\frac{2}{3} = \frac{\quad}{6}$

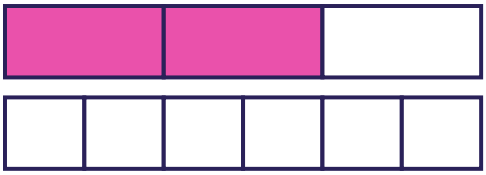

Fraction Equivalence · 4

Both bars show the same amount. Count the parts of the second bar: $\frac{1}{7} = \frac{2}{\quad}$

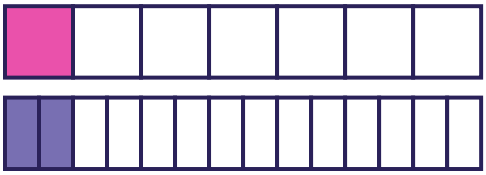

Fraction Equivalence · 5

$$\frac{1}{3} = \frac{4}{\quad}$$

Fraction Equivalence · 6

$\frac{1}{2} = \frac{2}{4}$. The top and the bottom were both multiplied by ___

Fraction Equivalence · 7

Divide the top and the bottom by the same number: $\frac{2}{8} = \frac{\quad}{4}$

Fraction Equivalence · 8

Max eats $\frac{3}{6}$ of a pizza. Ben has a pizza of the same size cut into 30 equal slices. How many slices must Ben eat to eat the same amount?

Fraction Equivalence · 2

ANSWER

8

Fraction Equivalence · 1

ANSWER

12

Fraction Equivalence · 4

ANSWER

14

Fraction Equivalence · 3

ANSWER

4

Fraction Equivalence · 6

ANSWER

2

Fraction Equivalence · 5

ANSWER

12

Fraction Equivalence · 8

ANSWER

15

Fraction Equivalence · 7

ANSWER

1

Fraction Equivalence · 9

$$\frac{3}{6} = \frac{\quad}{30}$$

Fraction Equivalence · 10

$$\frac{1}{3} = \frac{\quad}{15}$$

Fraction Equivalence · 11

The bars are the same length. $\frac{1}{7} = \frac{\quad}{21}$

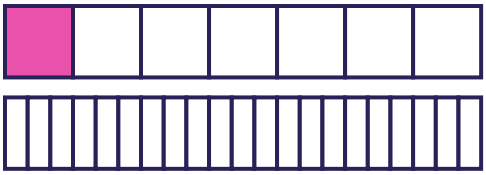

Fraction Equivalence · 12

Both bars show the same amount. Count the parts of the second bar: $\frac{2}{4} = \frac{8}{\quad}$

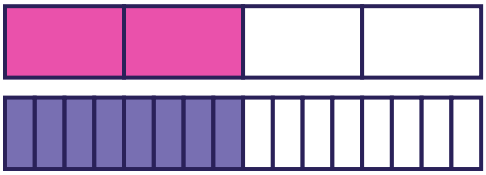

Fraction Equivalence · 13

$$\frac{4}{6} = \frac{20}{\quad}$$

Fraction Equivalence · 14

$\frac{1}{2} = \frac{6}{12}$. The top and the bottom were both multiplied by ___

Fraction Equivalence · 15

Divide the top and the bottom by the same number: $\frac{28}{32} = \frac{\quad}{8}$

Fraction Equivalence · 16

Ben eats $\frac{1}{9}$ of a chocolate bar. Sam has a chocolate bar of the same size cut into 54 equal squares. How many squares must Sam eat to eat the same amount?

Fraction Equivalence · 10

ANSWER

5

Fraction Equivalence · 9

ANSWER

15

Fraction Equivalence · 12

ANSWER

16

Fraction Equivalence · 11

ANSWER

3

Fraction Equivalence · 14

ANSWER

6

Fraction Equivalence · 13

ANSWER

30

Fraction Equivalence · 16

ANSWER

6

Fraction Equivalence · 15

ANSWER

7

Fraction Equivalence · 17

$\frac{3}{7} = \frac{\quad}{35}$

Fraction Equivalence · 18

$\frac{4}{8} = \frac{\quad}{16}$

Fraction Equivalence · 19

The bars are the same length. $\frac{1}{5} = \frac{\quad}{10}$

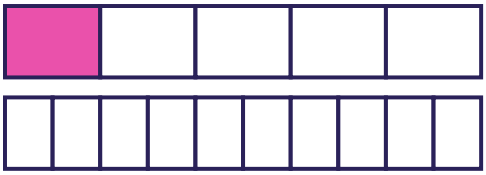

Fraction Equivalence · 20

Both bars show the same amount. Count the parts of the second bar: $\frac{1}{4} = \frac{4}{\quad}$

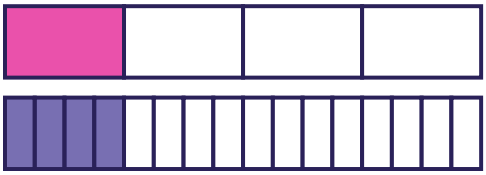

Fraction Equivalence · 21

$\frac{8}{9} = \frac{40}{\quad}$

Fraction Equivalence · 22

$\frac{2}{3} = \frac{4}{6}$. The top and the bottom were both multiplied by ___

Fraction Equivalence · 23

Divide the top and the bottom by the same number: $\frac{2}{4} = \frac{\quad}{2}$

Fraction Equivalence · 24

Ben eats $\frac{2}{9}$ of a chocolate bar. Ava has a chocolate bar of the same size cut into 27 equal squares. How many squares must Ava eat to eat the same amount?

Fraction Equivalence · 18

ANSWER

8

Fraction Equivalence · 17

ANSWER

15

Fraction Equivalence · 20

ANSWER

16

Fraction Equivalence · 19

ANSWER

2

Fraction Equivalence · 22

ANSWER

2

Fraction Equivalence · 21

ANSWER

45

Fraction Equivalence · 24

ANSWER

6

Fraction Equivalence · 23

ANSWER

1