Fraction Equivalence · 1

$\frac{4}{5} = \frac{\quad}{20}$

Fraction Equivalence · 2

$\frac{4}{5} = \frac{\quad}{10}$

Fraction Equivalence · 3

The bars are the same length. $\frac{4}{5} = \frac{\quad}{15}$

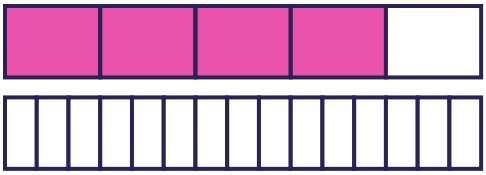

Fraction Equivalence · 4

Both bars show the same amount. Count the parts of the second bar: $\frac{2}{5} = \frac{4}{\quad}$

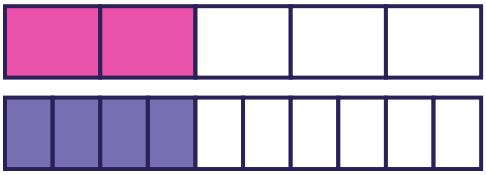

Fraction Equivalence · 5

$\frac{1}{4} = \frac{2}{\quad}$

Fraction Equivalence · 6

$\frac{1}{3} = \frac{3}{9}$. The top and the bottom were both multiplied by ___

Fraction Equivalence · 7

Divide the top and the bottom by the same number: $\frac{6}{12} = \frac{\quad}{6}$

Fraction Equivalence · 8

Lily eats $\frac{2}{3}$ of a cake. Mia has a cake of the same size cut into 12 equal pieces. How many pieces must Mia eat to eat the same amount?

Fraction Equivalence · 2

ANSWER

8

Fraction Equivalence · 1

ANSWER

16

Fraction Equivalence · 4

ANSWER

10

Fraction Equivalence · 3

ANSWER

12

Fraction Equivalence · 6

ANSWER

3

Fraction Equivalence · 5

ANSWER

8

Fraction Equivalence · 8

ANSWER

8

Fraction Equivalence · 7

ANSWER

3

Fraction Equivalence · 9

$$\frac{1}{2} = \frac{\quad}{6}$$

Fraction Equivalence · 10

$$\frac{3}{4} = \frac{\quad}{16}$$

Fraction Equivalence · 11

The bars are the same length. $\frac{2}{4} = \frac{\quad}{12}$

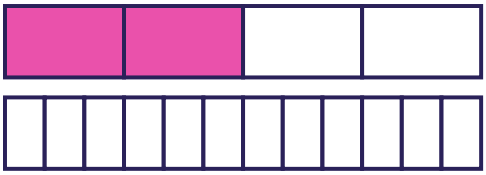

Fraction Equivalence · 12

Both bars show the same amount. Count the parts of the second bar: $\frac{1}{2} = \frac{2}{\quad}$

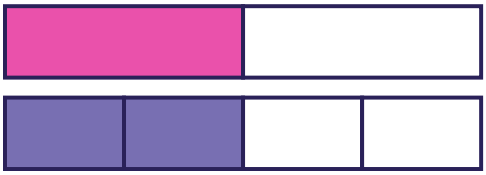

Fraction Equivalence · 13

$$\frac{2}{7} = \frac{6}{\quad}$$

Fraction Equivalence · 14

$\frac{1}{2} = \frac{4}{8}$. The top and the bottom were both multiplied by ___

Fraction Equivalence · 15

Divide the top and the bottom by the same number: $\frac{6}{15} = \frac{\quad}{5}$

Fraction Equivalence · 16

Zoe eats $\frac{5}{6}$ of a chocolate bar. Max has a chocolate bar of the same size cut into 12 equal squares. How many squares must Max eat to eat the same amount?

Fraction Equivalence · 10

ANSWER

12

Fraction Equivalence · 9

ANSWER

3

Fraction Equivalence · 12

ANSWER

4

Fraction Equivalence · 11

ANSWER

6

Fraction Equivalence · 14

ANSWER

4

Fraction Equivalence · 13

ANSWER

21

Fraction Equivalence · 16

ANSWER

10

Fraction Equivalence · 15

ANSWER

2

Fraction Equivalence · 17

$\frac{2}{8} = \frac{\quad}{32}$

Fraction Equivalence · 18

$\frac{1}{2} = \frac{\quad}{8}$

Fraction Equivalence · 19

The bars are the same length. $\frac{1}{5} = \frac{\quad}{10}$

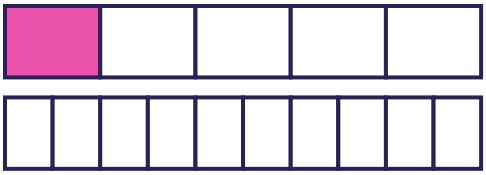

Fraction Equivalence · 20

Both bars show the same amount. Count the parts of the second bar: $\frac{5}{9} = \frac{10}{\quad}$

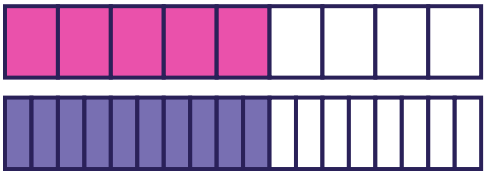

Fraction Equivalence · 21

$\frac{6}{9} = \frac{18}{\quad}$

Fraction Equivalence · 22

$\frac{3}{9} = \frac{15}{45}$. The top and the bottom were both multiplied by ___

Fraction Equivalence · 23

Divide the top and the bottom by the same number: $\frac{3}{18} = \frac{\quad}{6}$

Fraction Equivalence · 24

Mia eats $\frac{2}{10}$ of a pie. Leo has a pie of the same size cut into 30 equal pieces. How many pieces must Leo eat to eat the same amount?

Fraction Equivalence · 18

ANSWER

4

Fraction Equivalence · 17

ANSWER

8

Fraction Equivalence · 20

ANSWER

18

Fraction Equivalence · 19

ANSWER

2

Fraction Equivalence · 22

ANSWER

5

Fraction Equivalence · 21

ANSWER

27

Fraction Equivalence · 24

ANSWER

6

Fraction Equivalence · 23

ANSWER

1