Easter Math · 1

There are 67 hot cross buns. Each basket holds 7. How many baskets can be filled all the way?

Easter Math · 2

Ella plants flowers all the way around a rectangular garden that is 6 feet long and 4 feet wide. How many feet of flower border is that?

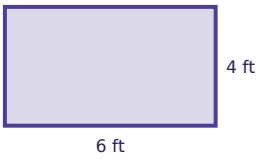

Easter Math · 3

Each basket holds 23 bunny cookies. The bakery fills 22 baskets. How many bunny cookies is that?

Easter Math · 4

Omar eats $\frac{2}{12}$ of a carrot cake. Lily eats $\frac{9}{12}$ of it. What fraction of the carrot cake did they eat together?

Easter Math · 5

Ben eats $\frac{2}{12}$ of a carrot cake. Ella eats $\frac{5}{12}$ of it. What fraction of the carrot cake did they eat together?

Easter Math · 6

There are 56 bunny cookies. Each basket holds 5. After filling as many baskets as possible, how many bunny cookies are left over?

Easter Math · 7

Ava plants flowers all the way around a rectangular garden that is 5 feet long and 4 feet wide. How many feet of flower border is that?

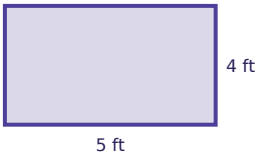

Easter Math · 8

Each basket holds 20 carrot muffins. The bakery fills 40 baskets. How many carrot muffins is that?

Easter Math · 2

ANSWER

20

Easter Math · 1

ANSWER

9

Easter Math · 4

ANSWER

$$\frac{11}{12}$$

Easter Math · 3

ANSWER

506

Easter Math · 6

ANSWER

1

Easter Math · 5

ANSWER

$$\frac{7}{12}$$

Easter Math · 8

ANSWER

800

Easter Math · 7

ANSWER

18

Easter Math · 9

Lily plants flowers all the way around a rectangular garden that is 8 feet long and 6 feet wide. How many feet of flower border is that?

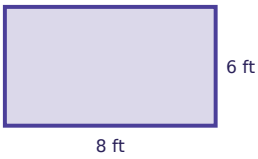

Easter Math · 10

Leo eats $\frac{2}{10}$ of a carrot cake. Ava eats $\frac{1}{10}$ of it. What fraction of the carrot cake did they eat together?

Easter Math · 11

There are 82 carrot muffins. Each basket holds 5. How many baskets can be filled all the way?

Easter Math · 12

Each basket holds 11 carrot muffins. The bakery fills 16 baskets. How many carrot muffins is that?

Easter Math · 13

Lily eats $\frac{5}{10}$ of a carrot cake. Ella eats $\frac{2}{10}$ of it. What fraction of the carrot cake did they eat together?

Easter Math · 14

Ben plants flowers all the way around a rectangular garden that is 8 feet long and 4 feet wide. How many feet of flower border is that?

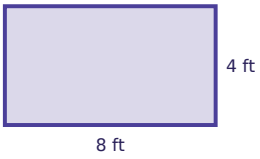

Easter Math · 15

Each basket holds 16 carrot muffins. The bakery fills 43 baskets. How many carrot muffins is that?

Easter Math · 16

There are 34 hot cross buns. Each basket holds 5. After filling as many baskets as possible, how many hot cross buns are left over?

Easter Math · 10

ANSWER

$\frac{3}{10}$

Easter Math · 9

ANSWER

28

Easter Math · 12

ANSWER

176

Easter Math · 11

ANSWER

16

Easter Math · 14

ANSWER

24

Easter Math · 13

ANSWER

$\frac{7}{10}$

Easter Math · 16

ANSWER

4

Easter Math · 15

ANSWER

688

Easter Math · 17

Leo eats $\frac{7}{9}$ of a carrot cake. Ben eats $\frac{1}{9}$ of it. What fraction of the carrot cake did they eat together?

Easter Math · 18

Sam plants flowers all the way around a rectangular garden that is 6 feet long and 5 feet wide. How many feet of flower border is that?

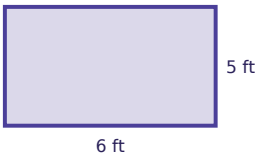

Easter Math · 19

Each basket holds 12 bunny cookies. The bakery fills 48 baskets. How many bunny cookies is that?

Easter Math · 20

There are 16 bunny cookies. Each basket holds 3. How many baskets can be filled all the way?

Easter Math · 21

Lily plants flowers all the way around a rectangular garden that is 11 feet long and 7 feet wide. How many feet of flower border is that?



Easter Math · 22

There are 119 carrot muffins. Each basket holds 8. After filling as many baskets as possible, how many carrot muffins are left over?

Easter Math · 23

Noah eats $\frac{7}{12}$ of a carrot cake. Ella eats $\frac{4}{12}$ of it. What fraction of the carrot cake did they eat together?

Easter Math · 24

Each basket holds 14 carrot muffins. The bakery fills 15 baskets. How many carrot muffins is that?

Easter Math · 18

ANSWER

22

Easter Math · 17

ANSWER

$$\frac{8}{9}$$

Easter Math · 20

ANSWER

5

Easter Math · 19

ANSWER

576

Easter Math · 22

ANSWER

7

Easter Math · 21

ANSWER

36

Easter Math · 24

ANSWER

210

Easter Math · 23

ANSWER

$$\frac{11}{12}$$