Easter Math · 1

There are 22 hot cross buns. Each basket holds 3. After filling as many baskets as possible, how many hot cross buns are left over?

Easter Math · 2

Sam eats $\frac{4}{12}$ of a carrot cake. Noah eats $\frac{1}{12}$ of it. What fraction of the carrot cake did they eat together?

Easter Math · 3

Each basket holds 5 carrot muffins. The bakery fills 34 baskets. How many carrot muffins is that?

Easter Math · 4

Omar eats $\frac{5}{8}$ of a carrot cake. Lily eats $\frac{2}{8}$ of it. What fraction of the carrot cake did they eat together?

Easter Math · 5

There are 73 bunny cookies. Each basket holds 8. After filling as many baskets as possible, how many bunny cookies are left over?

Easter Math · 6

Ava plants flowers all the way around a rectangular garden that is 6 feet long and 5 feet wide. How many feet of flower border is that?

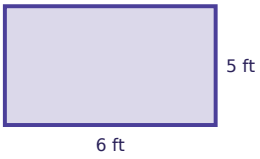

Easter Math · 7

Ava plants flowers all the way around a rectangular garden that is 5 feet long and 2 feet wide. How many feet of flower border is that?

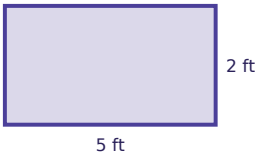

Easter Math · 8

Each basket holds 5 carrot muffins. The bakery fills 40 baskets. How many carrot muffins is that?

Easter Math · 2

ANSWER

$\frac{5}{12}$

Easter Math · 1

ANSWER

1

Easter Math · 4

ANSWER

$\frac{7}{8}$

Easter Math · 3

ANSWER

170

Easter Math · 6

ANSWER

22

Easter Math · 5

ANSWER

1

Easter Math · 8

ANSWER

200

Easter Math · 7

ANSWER

14

Easter Math · 9

Omar eats $\frac{10}{12}$ of a carrot cake. Lily eats $\frac{1}{12}$ of it. What fraction of the carrot cake did they eat together?

Easter Math · 10

Each basket holds 5 hot cross buns. The bakery fills 52 baskets. How many hot cross buns is that?

Easter Math · 11

Omar plants flowers all the way around a rectangular garden that is 6 feet long and 3 feet wide. How many feet of flower border is that?

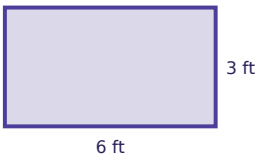

Easter Math · 12

Each basket holds 7 carrot muffins. The bakery fills 61 baskets. How many carrot muffins is that?

Easter Math · 13

Ben plants flowers all the way around a rectangular garden that is 4 feet long and 3 feet wide. How many feet of flower border is that?



Easter Math · 14

Mia eats $\frac{2}{8}$ of a carrot cake. Sam eats $\frac{5}{8}$ of it. What fraction of the carrot cake did they eat together?

Easter Math · 15

There are 28 bunny cookies. Each basket holds 6. After filling as many baskets as possible, how many bunny cookies are left over?

Easter Math · 16

There are 129 hot cross buns. Each basket holds 9. After filling as many baskets as possible, how many hot cross buns are left over?

Easter Math · 10

ANSWER

260

Easter Math · 9

ANSWER

$$\frac{11}{12}$$

Easter Math · 12

ANSWER

427

Easter Math · 11

ANSWER

18

Easter Math · 14

ANSWER

$$\frac{7}{8}$$

Easter Math · 13

ANSWER

14

Easter Math · 16

ANSWER

3

Easter Math · 15

ANSWER

4

Easter Math · 17

Sam plants flowers all the way around a rectangular garden that is 10 feet long and 6 feet wide. How many feet of flower border is that?

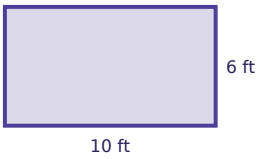

Easter Math · 18

There are 66 bunny cookies. Each basket holds 4. After filling as many baskets as possible, how many bunny cookies are left over?

Easter Math · 19

There are 109 hot cross buns. Each basket holds 9. After filling as many baskets as possible, how many hot cross buns are left over?

Easter Math · 20

Each basket holds 21 carrot muffins. The bakery fills 20 baskets. How many carrot muffins is that?

Easter Math · 21

Each basket holds 22 hot cross buns. The bakery fills 27 baskets. How many hot cross buns is that?

Easter Math · 22

Ella plants flowers all the way around a rectangular garden that is 9 feet long and 3 feet wide. How many feet of flower border is that?

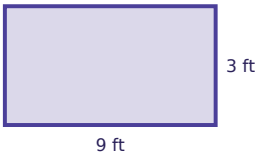

Easter Math · 23

Ava eats $\frac{2}{8}$ of a carrot cake. Omar eats $\frac{1}{8}$ of it. What fraction of the carrot cake did they eat together?

Easter Math · 24

Mia eats $\frac{2}{10}$ of a carrot cake. Zoe eats $\frac{1}{10}$ of it. What fraction of the carrot cake did they eat together?

Easter Math · 18

ANSWER

2

Easter Math · 17

ANSWER

32

Easter Math · 20

ANSWER

420

Easter Math · 19

ANSWER

1

Easter Math · 22

ANSWER

24

Easter Math · 21

ANSWER

594

Easter Math · 24

ANSWER

$$\frac{3}{10}$$

Easter Math · 23

ANSWER

$$\frac{3}{8}$$