Easter Math · 1

Ava plants flowers all the way around a rectangular garden that is 6 feet long and 5 feet wide. How many feet of flower border is that?

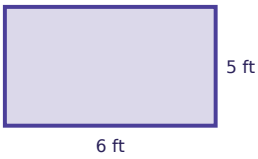

Easter Math · 2

There are 43 hot cross buns. Each basket holds 7. How many baskets can be filled all the way?

Easter Math · 3

Omar plants flowers all the way around a rectangular garden that is 5 feet long and 3 feet wide. How many feet of flower border is that?



Easter Math · 4

Sam eats $\frac{3}{7}$ of a carrot cake. Zoe eats $\frac{1}{7}$ of it. What fraction of the carrot cake did they eat together?

Easter Math · 5

Each basket holds 5 carrot muffins. The bakery fills 22 baskets. How many carrot muffins is that?

Easter Math · 6

There are 35 bunny cookies. Each basket holds 4. How many baskets can be filled all the way?

Easter Math · 7

Each basket holds 9 hot cross buns. The bakery fills 19 baskets. How many hot cross buns is that?

Easter Math · 8

Ava eats $\frac{2}{8}$ of a carrot cake. Ella eats $\frac{1}{8}$ of it. What fraction of the carrot cake did they eat together?

Easter Math · 2

ANSWER

6

Easter Math · 1

ANSWER

22

Easter Math · 4

ANSWER

$$\frac{4}{7}$$

Easter Math · 3

ANSWER

16

Easter Math · 6

ANSWER

8

Easter Math · 5

ANSWER

110

Easter Math · 8

ANSWER

$$\frac{3}{8}$$

Easter Math · 7

ANSWER

171

Easter Math · 9

Zoe eats $\frac{1}{8}$ of a carrot cake. Ella eats $\frac{4}{8}$ of it. What fraction of the carrot cake did they eat together?

Easter Math · 10

Leo plants flowers all the way around a rectangular garden that is 5 feet long and 3 feet wide. How many feet of flower border is that?

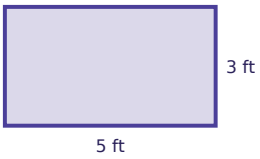

Easter Math · 11

There are 77 carrot muffins. Each basket holds 9. How many baskets can be filled all the way?

Easter Math · 12

Each basket holds 3 hot cross buns. The bakery fills 17 baskets. How many hot cross buns is that?

Easter Math · 13

There are 70 hot cross buns. Each basket holds 9. After filling as many baskets as possible, how many hot cross buns are left over?

Easter Math · 14

Each basket holds 4 bunny cookies. The bakery fills 12 baskets. How many bunny cookies is that?

Easter Math · 15

Noah plants flowers all the way around a rectangular garden that is 6 feet long and 4 feet wide. How many feet of flower border is that?

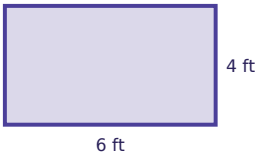

Easter Math · 16

Omar eats $\frac{1}{5}$ of a carrot cake. Sam eats $\frac{2}{5}$ of it. What fraction of the carrot cake did they eat together?

Easter Math · 10

ANSWER

16

Easter Math · 9

ANSWER

$$\frac{5}{8}$$

Easter Math · 12

ANSWER

51

Easter Math · 11

ANSWER

8

Easter Math · 14

ANSWER

48

Easter Math · 13

ANSWER

7

Easter Math · 16

ANSWER

$$\frac{3}{5}$$

Easter Math · 15

ANSWER

20

Easter Math · 17

There are 43 hot cross buns. Each basket holds 5. After filling as many baskets as possible, how many hot cross buns are left over?

Easter Math · 18

Each basket holds 8 hot cross buns. The bakery fills 17 baskets. How many hot cross buns is that?

Easter Math · 19

Zoe eats $\frac{2}{8}$ of a carrot cake. Lily eats $\frac{3}{8}$ of it. What fraction of the carrot cake did they eat together?

Easter Math · 20

Each basket holds 7 carrot muffins. The bakery fills 43 baskets. How many carrot muffins is that?

Easter Math · 21

Lily eats $\frac{1}{5}$ of a carrot cake. Ben eats $\frac{3}{5}$ of it. What fraction of the carrot cake did they eat together?

Easter Math · 22

Noah plants flowers all the way around a rectangular garden that is 7 feet long and 3 feet wide. How many feet of flower border is that?

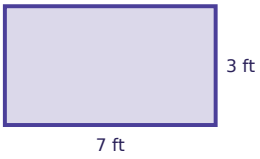

Easter Math · 23

Noah plants flowers all the way around a rectangular garden that is 5 feet long and 3 feet wide. How many feet of flower border is that?

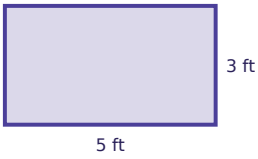

Easter Math · 24

There are 37 bunny cookies. Each basket holds 3. How many baskets can be filled all the way?

Easter Math · 18

ANSWER

136

Easter Math · 17

ANSWER

3

Easter Math · 20

ANSWER

301

Easter Math · 19

ANSWER

$$\frac{5}{8}$$

Easter Math · 22

ANSWER

20

Easter Math · 21

ANSWER

$$\frac{4}{5}$$

Easter Math · 24

ANSWER

12

Easter Math · 23

ANSWER

16