Task card 1 Converting Fractions to Decimals

Write $\frac{5}{10}$ as a decimal.

Task card 2 Converting Fractions to Decimals

Write $\frac{6}{10}$ as a decimal.

Task card 3 Converting Fractions to Decimals

The bar shows $\frac{7}{10}$. Write $\frac{7}{10}$ as a decimal.



Task card 4 Converting Fractions to Decimals

The bar shows $\frac{9}{10}$. Write $\frac{9}{10}$ as a decimal.



Task card 5 Converting Fractions to Decimals

$\frac{8}{10}$ is 8 tenths. Write $\frac{8}{10}$ as a decimal.

Task card 6 Converting Fractions to Decimals

$\frac{\quad}{10} = 0.4$

Task card 7 Converting Fractions to Decimals

A bottle holds $\frac{1}{10}$ of a liter of juice. Write $\frac{1}{10}$ as a decimal.

Task card 8 Converting Fractions to Decimals

$\frac{3}{\quad} = 0.3$

Task card 9 Converting Fractions to Decimals

Write $\frac{47}{100}$ as a decimal.

Task card 10 Converting Fractions to Decimals

Write $\frac{64}{100}$ as a decimal.

Task card 11 Converting Fractions to Decimals

The grid shows $\frac{62}{100}$. Write $\frac{62}{100}$ as a decimal.



Task card 12 Converting Fractions to Decimals

The grid shows $\frac{57}{100}$. Write $\frac{57}{100}$ as a decimal.



Task card 13 Converting Fractions to Decimals

$\frac{43}{100}$ is 43 hundredths. Write $\frac{43}{100}$ as a decimal.

Task card 14 Converting Fractions to Decimals

$\frac{\quad}{100} = 0.36$

Task card 15 Converting Fractions to Decimals

A ribbon is $\frac{68}{100}$ of a meter long.

Write $\frac{68}{100}$ as a decimal.

Task card 16 Converting Fractions to Decimals

$\frac{79}{\quad} = 0.79$

Task card 17 Converting Fractions to Decimals

Write $\frac{1}{10}$ as a decimal.

Task card 18 Converting Fractions to Decimals

Write $\frac{58}{100}$ as a decimal.

Task card 19 Converting Fractions to Decimals

The grid shows $\frac{6}{100}$. Write $\frac{6}{100}$ as a decimal.



Task card 20 Converting Fractions to Decimals

$\frac{89}{100}$ is 89 hundredths. Write $\frac{89}{100}$ as a decimal.

Task card 21 Converting Fractions to Decimals

$\frac{\quad}{100} = 0.02$

Task card 22 Converting Fractions to Decimals

A bottle holds $\frac{2}{10}$ of a liter of juice. Write $\frac{2}{10}$ as a decimal.

Task card 23 Converting Fractions to Decimals

$\frac{64}{\quad} = 0.64$

Task card 24 Converting Fractions to Decimals

Write $\frac{4}{10}$ as a decimal.

Converting Fractions to Decimals Task Cards

Recording sheet · Grade 4 · Write each fraction or mixed number as a decimal, or fill in the missing number.

Name: _____ Date: _____

Scan to check your answers

1	2	3	4
5	6	7	8
9	10	11	12
13	14	15	16
17	18	19	20
21	22	23	24

Converting Fractions to Decimals Task Cards: Answer Key

Grade 4 · Easy

The answers online

1. 0.5	**2.** 0.6	**3.** 0.7
4. 0.9	**5.** 0.8	**6.** 4
7. 0.1	**8.** 10	**9.** 0.47
10. 0.64	**11.** 0.62	**12.** 0.57
13. 0.43	**14.** 36	**15.** 0.68
16. 100	**17.** 0.1	**18.** 0.58
19. 0.06	**20.** 0.89	**21.** 2
22. 0.2	**23.** 100	**24.** 0.4