Converting Fractions to Decimals · 1

Write $\frac{5}{10}$ as a decimal.

Converting Fractions to Decimals · 2

Write $\frac{6}{10}$ as a decimal.

Converting Fractions to Decimals · 3

The bar shows $\frac{7}{10}$. Write $\frac{7}{10}$ as a decimal.



Converting Fractions to Decimals · 4

The bar shows $\frac{9}{10}$. Write $\frac{9}{10}$ as a decimal.



Converting Fractions to Decimals · 5

$\frac{8}{10}$ is 8 tenths. Write $\frac{8}{10}$ as a decimal.

Converting Fractions to Decimals · 6

$\frac{\quad}{10} = 0.4$

Converting Fractions to Decimals · 7

A bottle holds $\frac{1}{10}$ of a liter of juice. Write $\frac{1}{10}$ as a decimal.

Converting Fractions to Decimals · 8

$\frac{3}{\quad} = 0.3$

Converting Fractions to Decimals · 2

ANSWER

0.6

Converting Fractions to Decimals · 1

ANSWER

0.5

Converting Fractions to Decimals · 4

ANSWER

0.9

Converting Fractions to Decimals · 3

ANSWER

0.7

Converting Fractions to Decimals · 6

ANSWER

4

Converting Fractions to Decimals · 5

ANSWER

0.8

Converting Fractions to Decimals · 8

ANSWER

10

Converting Fractions to Decimals · 7

ANSWER

0.1

Converting Fractions to Decimals · 9

Write $\frac{47}{100}$ as a decimal.

Converting Fractions to Decimals · 10

Write $\frac{64}{100}$ as a decimal.

Converting Fractions to Decimals · 11

The grid shows $\frac{62}{100}$. Write $\frac{62}{100}$ as a decimal.



Converting Fractions to Decimals · 12

The grid shows $\frac{57}{100}$. Write $\frac{57}{100}$ as a decimal.



Converting Fractions to Decimals · 13

$\frac{43}{100}$ is 43 hundredths. Write $\frac{43}{100}$ as a decimal.

Converting Fractions to Decimals · 14

$\frac{\quad}{100} = 0.36$

Converting Fractions to Decimals · 15

A ribbon is $\frac{68}{100}$ of a meter long.

Write $\frac{68}{100}$ as a decimal.

Converting Fractions to Decimals · 16

$\frac{79}{\quad} = 0.79$

Converting Fractions to Decimals · 10

ANSWER

0.64

Converting Fractions to Decimals · 9

ANSWER

0.47

Converting Fractions to Decimals · 12

ANSWER

0.57

Converting Fractions to Decimals · 11

ANSWER

0.62

Converting Fractions to Decimals · 14

ANSWER

36

Converting Fractions to Decimals · 13

ANSWER

0.43

Converting Fractions to Decimals · 16

ANSWER

100

Converting Fractions to Decimals · 15

ANSWER

0.68

Converting Fractions to Decimals · 17

Write $\frac{1}{10}$ as a decimal.

Converting Fractions to Decimals · 18

Write $\frac{58}{100}$ as a decimal.

Converting Fractions to Decimals · 19

The grid shows $\frac{6}{100}$. Write $\frac{6}{100}$ as a decimal.



Converting Fractions to Decimals · 20

$\frac{89}{100}$ is 89 hundredths. Write $\frac{89}{100}$ as a decimal.

Converting Fractions to Decimals · 21

$\frac{__}{100} = 0.02$

Converting Fractions to Decimals · 22

A bottle holds $\frac{2}{10}$ of a liter of juice.

Write $\frac{2}{10}$ as a decimal.

Converting Fractions to Decimals · 23

$\frac{64}{__} = 0.64$

Converting Fractions to Decimals · 24

Write $\frac{4}{10}$ as a decimal.

Converting Fractions to Decimals · 18

ANSWER

0.58

Converting Fractions to Decimals · 17

ANSWER

0.1

Converting Fractions to Decimals · 20

ANSWER

0.89

Converting Fractions to Decimals · 19

ANSWER

0.06

Converting Fractions to Decimals · 22

ANSWER

0.2

Converting Fractions to Decimals · 21

ANSWER

2

Converting Fractions to Decimals · 24

ANSWER

0.4

Converting Fractions to Decimals · 23

ANSWER

100