Task card 1 Converting Decimals to Fractions

Write 0.6 as a fraction with denominator 10.

Task card 2 Converting Decimals to Fractions

Write 0.7 as a fraction with denominator 10.

Task card 3 Converting Decimals to Fractions

The shaded part shows 0.3. Write 0.3 as a fraction with denominator 10.



Task card 4 Converting Decimals to Fractions

The shaded part shows 0.2. Write 0.2 as a fraction with denominator 10.



Task card 5 Converting Decimals to Fractions

0.1 is 1 tenth. Write 0.1 as a fraction with denominator 10.

Task card 6 Converting Decimals to Fractions

$$0.9 = \frac{\quad}{10}$$

Task card 7 Converting Decimals to Fractions

Ben cut a ribbon 0.4 of a meter long. Write 0.4 as a fraction with denominator 10.

Task card 8 Converting Decimals to Fractions

$$0.8 = \frac{8}{__}$$

Task card 9 Converting Decimals to Fractions

Write 0.54 as a fraction with denominator 100.

Task card 10 Converting Decimals to Fractions

Write 0.31 as a fraction with denominator 100.

Task card 11 Converting Decimals to Fractions

The shaded part shows 0.52. Write 0.52 as a fraction with denominator 100.



Task card 12 Converting Decimals to Fractions

The shaded part shows 0.35. Write 0.35 as a fraction with denominator 100.



Task card 13 Converting Decimals to Fractions

0.42 is 42 hundredths. Write 0.42 as a fraction with denominator 100.

Task card 14 Converting Decimals to Fractions

$$0.93 = \frac{\quad}{100}$$

Task card 15 Converting Decimals to Fractions

Ava drank 0.76 of a liter of water. Write 0.76 as a fraction with denominator 100.

Task card 16 Converting Decimals to Fractions

$$0.94 = \frac{94}{\quad}$$

Task card 17 Converting Decimals to Fractions

Write 0.3 as a fraction in lowest terms.

Task card 18 Converting Decimals to Fractions

Write 0.01 as a fraction in lowest terms.

Task card 19 Converting Decimals to Fractions

The shaded part shows 0.21. Write 0.21 as a fraction in lowest terms.



Task card 20 Converting Decimals to Fractions

The shaded part shows 0.1. Write 0.1 as a fraction in lowest terms.



Task card 21 Converting Decimals to Fractions

0.41 is 41 hundredths. Write 0.41 as a fraction in lowest terms.

Task card 22 Converting Decimals to Fractions

$$0.99 = \frac{\quad}{100}$$

Task card 23 Converting Decimals to Fractions

Mia drank 0.7 of a liter of water. Write 0.7 as a fraction in lowest terms.

Task card 24 Converting Decimals to Fractions

$$0.07 = \frac{7}{\quad}$$

Converting Decimals to Fractions Task Cards

Recording sheet · Grade 4 · Write each decimal as a fraction or mixed number, or fill in the missing number. Use lowest terms unless a denominator is given.

Name: _____ Date: _____

Scan to check your answers

1	2	3	4
5	6	7	8
9	10	11	12
13	14	15	16
17	18	19	20
21	22	23	24

Converting Decimals to Fractions Task Cards: Answer Key

Grade 4 · Easy

The answers online

1. $\frac{6}{10}$	**2.** $\frac{7}{10}$	**3.** $\frac{3}{10}$
4. $\frac{2}{10}$	**5.** $\frac{1}{10}$	**6.** 9
7. $\frac{4}{10}$	**8.** 10	**9.** $\frac{54}{100}$
10. $\frac{31}{100}$	**11.** $\frac{52}{100}$	**12.** $\frac{35}{100}$
13. $\frac{42}{100}$	**14.** 93	**15.** $\frac{76}{100}$
16. 100	**17.** $\frac{3}{10}$	**18.** $\frac{1}{100}$
19. $\frac{21}{100}$	**20.** $\frac{1}{10}$	**21.** $\frac{41}{100}$
22. 99	**23.** $\frac{7}{10}$	**24.** 100