Write 0.6 as a fraction with denominator 10.

Write 0.7 as a fraction with denominator 10.

The shaded part shows 0.3. Write 0.3 as a fraction with denominator 10.



The shaded part shows 0.2. Write 0.2 as a fraction with denominator 10.



0.1 is 1 tenth. Write 0.1 as a fraction with denominator 10.

$$0.9 = \frac{\quad}{10}$$

Ben cut a ribbon 0.4 of a meter long. Write 0.4 as a fraction with denominator 10.

$$0.8 = \frac{8}{\quad}$$

Converting Decimals to Fractions · 2

ANSWER

$\frac{7}{10}$

Converting Decimals to Fractions · 1

ANSWER

$\frac{6}{10}$

Converting Decimals to Fractions · 4

ANSWER

$\frac{2}{10}$

Converting Decimals to Fractions · 3

ANSWER

$\frac{3}{10}$

Converting Decimals to Fractions · 6

ANSWER

9

Converting Decimals to Fractions · 5

ANSWER

$\frac{1}{10}$

Converting Decimals to Fractions · 8

ANSWER

10

Converting Decimals to Fractions · 7

ANSWER

$\frac{4}{10}$

Converting Decimals to Fractions · 9

Write 0.54 as a fraction with denominator 100.

Converting Decimals to Fractions · 10

Write 0.31 as a fraction with denominator 100.

Converting Decimals to Fractions · 11

The shaded part shows 0.52. Write 0.52 as a fraction with denominator 100.



Converting Decimals to Fractions · 12

The shaded part shows 0.35. Write 0.35 as a fraction with denominator 100.



Converting Decimals to Fractions · 13

0.42 is 42 hundredths. Write 0.42 as a fraction with denominator 100.

Converting Decimals to Fractions · 14

$$0.93 = \frac{\quad}{100}$$

Converting Decimals to Fractions · 15

Ava drank 0.76 of a liter of water. Write 0.76 as a fraction with denominator 100.

Converting Decimals to Fractions · 16

$$0.94 = \frac{94}{\quad}$$

Converting Decimals to Fractions · 10

ANSWER

$$\frac{31}{100}$$

Converting Decimals to Fractions · 9

ANSWER

$$\frac{54}{100}$$

Converting Decimals to Fractions · 12

ANSWER

$$\frac{35}{100}$$

Converting Decimals to Fractions · 11

ANSWER

$$\frac{52}{100}$$

Converting Decimals to Fractions · 14

ANSWER

$$93$$

Converting Decimals to Fractions · 13

ANSWER

$$\frac{42}{100}$$

Converting Decimals to Fractions · 16

ANSWER

$$100$$

Converting Decimals to Fractions · 15

ANSWER

$$\frac{76}{100}$$

Write 0.3 as a fraction in lowest terms.

Write 0.01 as a fraction in lowest terms.

The shaded part shows 0.21. Write 0.21 as a fraction in lowest terms.



The shaded part shows 0.1. Write 0.1 as a fraction in lowest terms.



0.41 is 41 hundredths. Write 0.41 as a fraction in lowest terms.

$$0.99 = \frac{\quad}{100}$$

Mia drank 0.7 of a liter of water. Write 0.7 as a fraction in lowest terms.

$$0.07 = \frac{7}{\quad}$$

Converting Decimals to Fractions · 18

ANSWER

$$\frac{1}{100}$$

Converting Decimals to Fractions · 17

ANSWER

$$\frac{3}{10}$$

Converting Decimals to Fractions · 20

ANSWER

$$\frac{1}{10}$$

Converting Decimals to Fractions · 19

ANSWER

$$\frac{21}{100}$$

Converting Decimals to Fractions · 22

ANSWER

$$99$$

Converting Decimals to Fractions · 21

ANSWER

$$\frac{41}{100}$$

Converting Decimals to Fractions · 24

ANSWER

$$100$$

Converting Decimals to Fractions · 23

ANSWER

$$\frac{7}{10}$$