Task card 1 Compare Fractions with Different D...

$\frac{5}{12}$ ___ $\frac{3}{8}$

Task card 2 Compare Fractions with Different D...

$\frac{1}{4}$ ___ $\frac{2}{5}$

Task card 3 Compare Fractions with Different D...

The bars are the same length. Use them to compare: $\frac{4}{5}$ ___ $\frac{1}{2}$

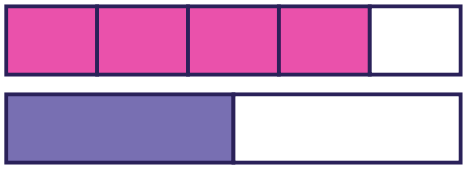

Task card 4 Compare Fractions with Different D...

The bars are the same length. Use them to compare: $\frac{1}{2}$ ___ $\frac{4}{8}$

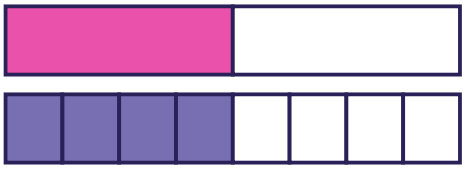

Task card 5 Compare Fractions with Different D...

$\frac{4}{5}$ is greater than $\frac{1}{2}$ and $\frac{1}{4}$ is less than $\frac{1}{2}$.

So $\frac{4}{5}$ ___ $\frac{1}{4}$

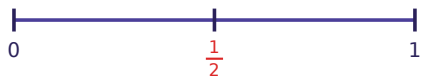

Task card 6 Compare Fractions with Different D...

Use the denominator 6: $\frac{1}{2} = \frac{3}{6}$

and $\frac{1}{3} = \frac{2}{6}$. So $\frac{1}{2}$ ___ $\frac{1}{3}$

Task card 7 Compare Fractions with Different D...

Which fraction is greater:

$\frac{2}{3}$ or $\frac{1}{4}$?

Task card 8 Compare Fractions with Different D...

Two jars are the same size. One is $\frac{1}{2}$ full and the other is $\frac{1}{4}$ full. Which fraction shows the jar with less in it?

Task card 9 Compare Fractions with Different D...

$\frac{1}{2}$ ___ $\frac{2}{3}$

Task card 10 Compare Fractions with Different D...

$\frac{5}{6}$ ___ $\frac{11}{12}$

Task card 11 Compare Fractions with Different D...

The bars are the same length. Use them to compare: $\frac{7}{8}$ ___ $\frac{9}{10}$

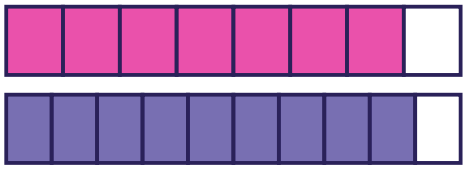

Task card 12 Compare Fractions with Different D...

The bars are the same length. Use them to compare: $\frac{1}{5}$ ___ $\frac{2}{10}$

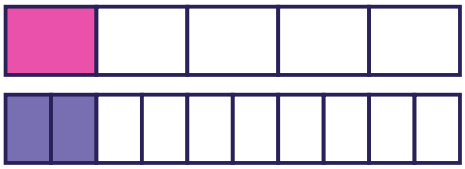

Task card 13 Compare Fractions with Different D...

$\frac{2}{3}$ is greater than $\frac{1}{2}$ and $\frac{1}{8}$ is less than $\frac{1}{2}$.

So $\frac{2}{3}$ ___ $\frac{1}{8}$

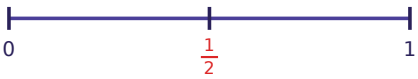

Task card 14 Compare Fractions with Different D...

Rename $\frac{1}{2}$ with the denominator 4: $\frac{1}{2} = \frac{2}{4}$. So $\frac{1}{2}$ ___ $\frac{3}{4}$

Task card 15 Compare Fractions with Different D...

Which fraction is greater: $\frac{5}{12}$ or $\frac{2}{3}$?

Task card 16 Compare Fractions with Different D...

Two jars are the same size. One is $\frac{1}{2}$ full and the other is $\frac{1}{5}$ full. Which fraction shows the jar with more in it?

Task card 17 Compare Fractions with Different D...

$\frac{5}{6}$ ___ $\frac{2}{5}$

Task card 18 Compare Fractions with Different D...

$\frac{5}{12}$ ___ $\frac{2}{3}$

Task card 19 Compare Fractions with Different D...

The bars are the same length. Use them to compare: $\frac{1}{6}$ ___ $\frac{1}{3}$

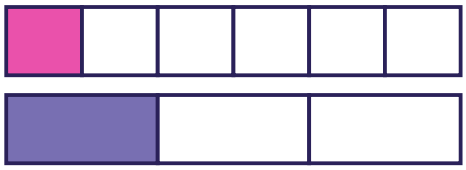

Task card 20 Compare Fractions with Different D...

The bars are the same length. Use them to compare: $\frac{1}{2}$ ___ $\frac{3}{6}$

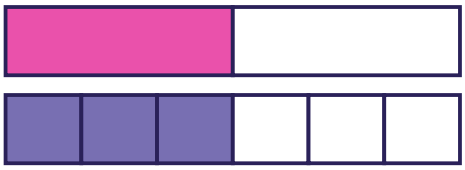

Task card 21 Compare Fractions with Different D...

$\frac{7}{12}$ is greater than $\frac{1}{2}$ and $\frac{2}{5}$ is less than $\frac{1}{2}$.

So $\frac{7}{12}$ ___ $\frac{2}{5}$

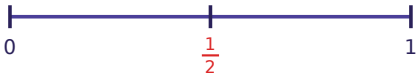

Task card 22 Compare Fractions with Different D...

Use the denominator 15: $\frac{4}{5} = \frac{12}{15}$

and $\frac{2}{3} = \frac{10}{15}$. So $\frac{4}{5}$ ___ $\frac{2}{3}$

Task card 23 Compare Fractions with Different D...

Which fraction is greater: $\frac{1}{2}$ or $\frac{9}{10}$?

Task card 24 Compare Fractions with Different D...

Two jars are the same size. One is $\frac{1}{4}$ full and the other is $\frac{1}{2}$ full. Which fraction shows the jar with more in it?

Compare Fractions with Different Denominators Task Cards

Recording sheet · Grade 4 · Compare the fractions. Write >, < or = unless the question asks for a fraction.

Scan to check your answers

Name: _____ Date: _____

1	2	3	4
5	6	7	8
9	10	11	12
13	14	15	16
17	18	19	20
21	22	23	24

Compare Fractions with Different Denominators Task Cards: Answer Key

Grade 4 · Hard

The answers online

1. >	**2.** <	**3.** >
4. =	**5.** >	**6.** >
7. $\frac{2}{3}$	**8.** $\frac{1}{4}$	**9.** <
10. <	**11.** <	**12.** =
13. >	**14.** <	**15.** $\frac{2}{3}$
16. $\frac{1}{2}$	**17.** >	**18.** <
19. <	**20.** =	**21.** >
22. >	**23.** $\frac{9}{10}$	**24.** $\frac{1}{2}$