Compare Fractions with Different Denominators · 1

$\frac{1}{2}$ ___ $\frac{1}{8}$

Compare Fractions with Different Denominators · 2

$\frac{1}{5}$ ___ $\frac{7}{10}$

Compare Fractions with Different Denominators · 3

The bars are the same length. Use them to compare: $\frac{1}{4}$ ___ $\frac{5}{12}$

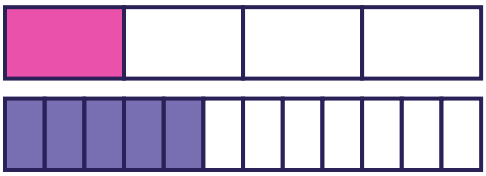

Compare Fractions with Different Denominators · 4

The bars are the same length. Use them to compare: $\frac{1}{6}$ ___ $\frac{2}{12}$

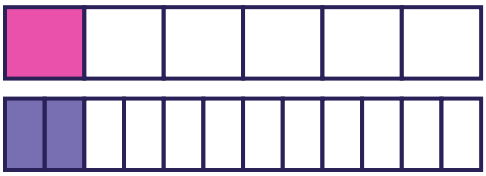

Compare Fractions with Different Denominators · 5

$\frac{2}{3}$ is greater than $\frac{1}{2}$ and $\frac{1}{12}$ is less than $\frac{1}{2}$.

So $\frac{2}{3}$ ___ $\frac{1}{12}$

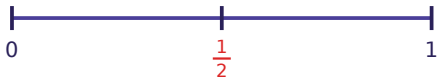

Compare Fractions with Different Denominators · 6

Rename $\frac{1}{4}$ with the denominator 8:

$\frac{1}{4} = \frac{2}{8}$. So $\frac{1}{4}$ ___ $\frac{7}{8}$

Compare Fractions with Different Denominators · 7

Which fraction is greater: $\frac{1}{5}$ or $\frac{3}{10}$?

Compare Fractions with Different Denominators · 8

Two jars are the same size. One is $\frac{1}{2}$ full and the other is $\frac{7}{10}$ full. Which fraction shows the jar with less in it?

Compare Fractions with Different Denominators · 2

ANSWER

$<$

Compare Fractions with Different Denominators · 1

ANSWER

$>$

Compare Fractions with Different Denominators · 4

ANSWER

$=$

Compare Fractions with Different Denominators · 3

ANSWER

$<$

Compare Fractions with Different Denominators · 6

ANSWER

$<$

Compare Fractions with Different Denominators · 5

ANSWER

$>$

Compare Fractions with Different Denominators · 8

ANSWER

$\frac{1}{2}$

Compare Fractions with Different Denominators · 7

ANSWER

$\frac{3}{10}$

Compare Fractions with Different Denominators · 9

$\frac{4}{5}$ ___ $\frac{9}{10}$

Compare Fractions with Different Denominators · 10

$\frac{1}{2}$ ___ $\frac{9}{10}$

Compare Fractions with Different Denominators · 11

The bars are the same length. Use them to compare: $\frac{1}{3}$ ___ $\frac{1}{12}$

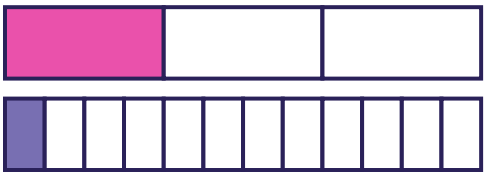

Compare Fractions with Different Denominators · 12

$\frac{1}{3}$ is less than $\frac{1}{2}$ and $\frac{7}{12}$ is greater than $\frac{1}{2}$.

So $\frac{1}{3}$ ___ $\frac{7}{12}$

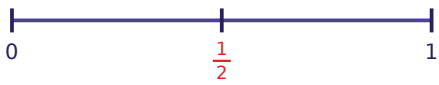

Compare Fractions with Different Denominators · 13

Rename $\frac{1}{2}$ with the denominator 4:

$\frac{1}{2} = \frac{2}{4}$. So $\frac{1}{2}$ ___ $\frac{3}{4}$

Compare Fractions with Different Denominators · 14

Which fraction is greater: $\frac{1}{5}$ or $\frac{1}{10}$?

Compare Fractions with Different Denominators · 15

Two jars are the same size. One is $\frac{1}{3}$ full and the other is $\frac{11}{12}$ full. Which fraction shows the jar with less in it?

Compare Fractions with Different Denominators · 16

$\frac{2}{3}$ ___ $\frac{1}{6}$

Compare Fractions with Different Denominators · 10

ANSWER

<

Compare Fractions with Different Denominators · 9

ANSWER

<

Compare Fractions with Different Denominators · 12

ANSWER

<

Compare Fractions with Different Denominators · 11

ANSWER

>

Compare Fractions with Different Denominators · 14

ANSWER

$\frac{1}{5}$

Compare Fractions with Different Denominators · 13

ANSWER

<

Compare Fractions with Different Denominators · 16

ANSWER

>

Compare Fractions with Different Denominators · 15

ANSWER

$\frac{1}{3}$

Compare Fractions with Different Denominators · 17

$\frac{2}{3}$ ____ $\frac{2}{5}$

Compare Fractions with Different Denominators · 18

The bars are the same length. Use them to compare: $\frac{2}{3}$ ___ $\frac{3}{10}$

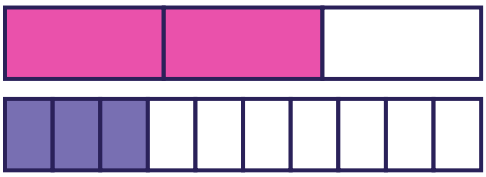

Compare Fractions with Different Denominators · 19

The bars are the same length. Use them to compare: $\frac{2}{3}$ ___ $\frac{4}{6}$

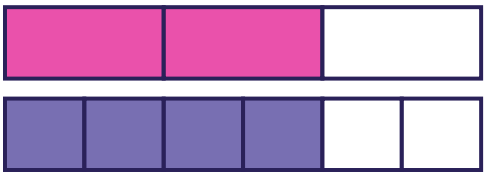

Compare Fractions with Different Denominators · 20

$\frac{3}{4}$ is greater than $\frac{1}{2}$ and $\frac{1}{5}$ is less than $\frac{1}{2}$.

So $\frac{3}{4}$ ___ $\frac{1}{5}$

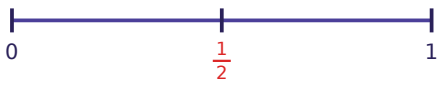

Compare Fractions with Different Denominators · 21

Rename $\frac{1}{3}$ with the denominator 6:

$\frac{1}{3} = \frac{2}{6}$. So $\frac{1}{3}$ ___ $\frac{5}{6}$

Compare Fractions with Different Denominators · 22

Which fraction is greater: $\frac{7}{8}$ or $\frac{3}{10}$?

Compare Fractions with Different Denominators · 23

Two jars are the same size. One is $\frac{1}{3}$ full and the other is $\frac{3}{4}$ full. Which fraction shows the jar with less in it?

Compare Fractions with Different Denominators · 24

$\frac{1}{2}$ ____ $\frac{3}{4}$

Compare Fractions with Different Denominators · 18

ANSWER

$>$

Compare Fractions with Different Denominators · 17

ANSWER

$>$

Compare Fractions with Different Denominators · 20

ANSWER

$>$

Compare Fractions with Different Denominators · 19

ANSWER

$=$

Compare Fractions with Different Denominators · 22

ANSWER

$\frac{7}{8}$

Compare Fractions with Different Denominators · 21

ANSWER

$<$

Compare Fractions with Different Denominators · 24

ANSWER

$<$

Compare Fractions with Different Denominators · 23

ANSWER

$\frac{1}{3}$