Task card 1 Classify Triangles by Angles & Sid...

Is this triangle equilateral, isosceles or scalene?

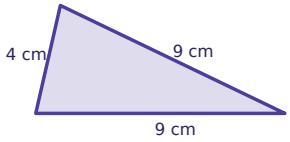

Task card 2 Classify Triangles by Angles & Sid...

Is this triangle equilateral, isosceles or scalene?

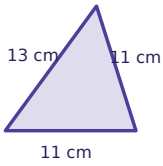

Task card 3 Classify Triangles by Angles & Sid...

Is this triangle equilateral, isosceles or scalene?

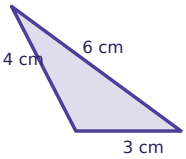

Task card 4 Classify Triangles by Angles & Sid...

How many angles of this triangle are smaller than a right angle (90°)?

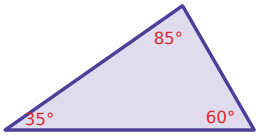

Task card 5 Classify Triangles by Angles & Sid...

A triangle has sides of 21 cm, 12 cm and 12 cm. Is it equilateral, isosceles or scalene?

Task card 6 Classify Triangles by Angles & Sid...

A triangle has angles of 45°, 45° and 90°. Is it acute, right or obtuse?

Task card 7 Classify Triangles by Angles & Sid...

A triangle has angles of 75°, 15° and 90°. Is it a right triangle? (yes or no)

Task card 8 Classify Triangles by Angles & Sid...

The perimeter of a triangle is 22 cm. Two of its sides are 8 cm and 6 cm long. Is it equilateral, isosceles or scalene?

Task card 9 Classify Triangles by Angles & Sid...

Is this triangle acute, right or obtuse?

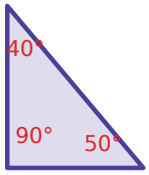

Task card 10 Classify Triangles by Angles & Sid...

Is this triangle equilateral, isosceles or scalene?

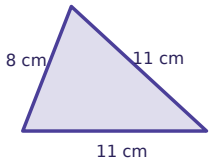

Task card 11 Classify Triangles by Angles & Sid...

Is this triangle acute, right or obtuse?



Task card 12 Classify Triangles by Angles & Sid...

How many angles of this triangle are smaller than a right angle (90°)?

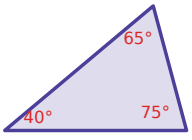

Task card 13 Classify Triangles by Angles & Sid...

A triangle has angles of 55°, 60° and 65°. Is it acute, right or obtuse?

Task card 14 Classify Triangles by Angles & Sid...

A triangle has angles of 25°, 30° and 125°. Is it acute, right or obtuse?

Task card 15 Classify Triangles by Angles & Sid...

A triangle has sides of 10 cm, 9 cm and 9 cm. Is it an equilateral triangle? (yes or no)

Task card 16 Classify Triangles by Angles & Sid...

The perimeter of a triangle is 14 cm. Two of its sides are 4 cm and 6 cm long. Is it equilateral, isosceles or scalene?

Task card 17 Classify Triangles by Angles & Sid...

Is this triangle equilateral, isosceles or scalene?

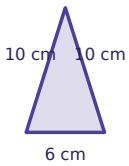

Task card 18 Classify Triangles by Angles & Sid...

Is this triangle acute, right or obtuse?



Task card 19 Classify Triangles by Angles & Sid...

Is this triangle equilateral, isosceles or scalene?

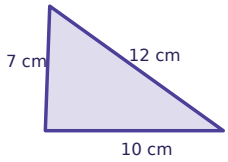

Task card 20 Classify Triangles by Angles & Sid...

How many sides of this triangle have the same length? (Write 0 if all three are different.)

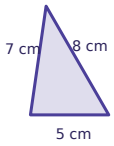

Task card 21 Classify Triangles by Angles & Sid...

A triangle has sides of 4 cm, 4 cm and 4 cm. Is it equilateral, isosceles or scalene?

Task card 22 Classify Triangles by Angles & Sid...

A triangle has angles of 140°, 25° and 15°. Is it acute, right or obtuse?

Task card 23 Classify Triangles by Angles & Sid...

A triangle has sides of 9 cm, 9 cm and 12 cm. Is it an equilateral triangle? (yes or no)

Task card 24 Classify Triangles by Angles & Sid...

The perimeter of a triangle is 11 cm. Two of its sides are 4 cm and 3 cm long. Is it equilateral, isosceles or scalene?

Classify Triangles by Angles & Sides Task Cards

Recording sheet · Grade 4 · Classify each triangle using one of the words in the question. The same kinds of triangle come in different shapes.

Scan to check your answers

Name: _____ Date: _____

1	2	3	4
5	6	7	8
9	10	11	12
13	14	15	16
17	18	19	20
21	22	23	24

Classify Triangles by Angles & Sides Task Cards: Answer Key

Grade 4 · Medium

The answers online

1. isosceles	**2.** isosceles	**3.** scalene
4. 3	**5.** isosceles	**6.** right
7. yes	**8.** isosceles	**9.** right
10. isosceles	**11.** obtuse	**12.** 3
13. acute	**14.** obtuse	**15.** no
16. isosceles	**17.** isosceles	**18.** obtuse
19. scalene	**20.** 0	**21.** equilateral
22. obtuse	**23.** no	**24.** isosceles