**Task card 1** Christmas Math

Each tin holds 23 cookies. The bakery fills 76 tins. How many cookies is that?

**Task card 2** Christmas Math

There are 28 candy canes. Each tin holds 5. How many tins can be filled all the way?

**Task card 3** Christmas Math

Ava eats $\frac{2}{9}$ of a Christmas cake. Lily eats $\frac{6}{9}$ of it. What fraction of the Christmas cake did they eat together?

**Task card 4** Christmas Math

There are 49 gingerbread men. Each tin holds 3. How many tins can be filled all the way?

**Task card 5** Christmas Math

Ben hangs lights all the way around a rectangular window that is 8 feet wide and 5 feet tall. How many feet of lights does Ben need?

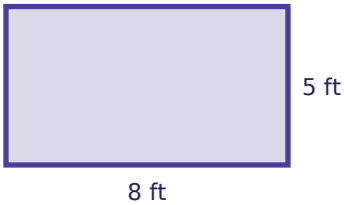


**Task card 6** Christmas Math

Each tin holds 23 cookies. The bakery fills 84 tins. How many cookies is that?

**Task card 7** Christmas Math

Sam eats $\frac{4}{12}$ of a Christmas cake. Noah eats $\frac{3}{12}$ of it. What fraction of the Christmas cake did they eat together?

**Task card 8** Christmas Math

Noah hangs lights all the way around a rectangular window that is 13 feet wide and 6 feet tall. How many feet of lights does Noah need?

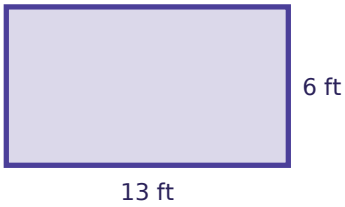


**Task card 9** Christmas Math

Ella hangs lights all the way around a rectangular window that is 11 feet wide and 10 feet tall. How many feet of lights does Ella need?

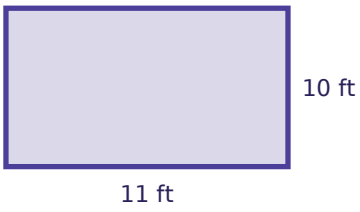


**Task card 10** Christmas Math

Lily hangs lights all the way around a rectangular window that is 8 feet wide and 5 feet tall. How many feet of lights does Lily need?

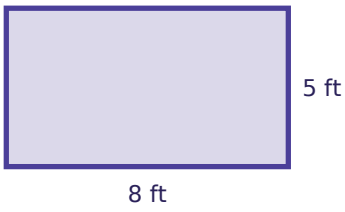


**Task card 11** Christmas Math

There are 78 cookies. Each tin holds 4. After filling as many tins as possible, how many cookies are left over?

**Task card 12** Christmas Math

Each tin holds 17 candy canes. The bakery fills 28 tins. How many candy canes is that?

**Task card 13** Christmas Math

Leo eats $\frac{5}{8}$ of a Christmas cake. Lily eats $\frac{2}{8}$ of it. What fraction of the Christmas cake did they eat together?

**Task card 14** Christmas Math

There are 20 candy canes. Each tin holds 3. After filling as many tins as possible, how many candy canes are left over?

**Task card 15** Christmas Math

Lily eats $\frac{1}{12}$ of a Christmas cake. Ben eats $\frac{4}{12}$ of it. What fraction of the Christmas cake did they eat together?

**Task card 16** Christmas Math

Each tin holds 21 cookies. The bakery fills 21 tins. How many cookies is that?

**Task card 17** Christmas Math

Zoe hangs lights all the way around a rectangular window that is 4 feet wide and 3 feet tall. How many feet of lights does Zoe need?

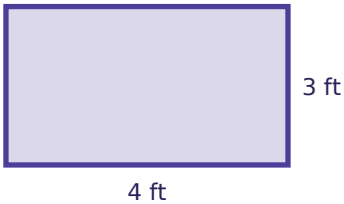


**Task card 18** Christmas Math

Ava eats $\frac{3}{8}$ of a Christmas cake. Mia eats $\frac{4}{8}$ of it. What fraction of the Christmas cake did they eat together?

**Task card 19** Christmas Math

Each tin holds 23 candy canes. The bakery fills 43 tins. How many candy canes is that?

**Task card 20** Christmas Math

There are 27 candy canes. Each tin holds 4. After filling as many tins as possible, how many candy canes are left over?

**Task card 21** Christmas Math

Omar hangs lights all the way around a rectangular window that is 8 feet wide and 6 feet tall. How many feet of lights does Omar need?

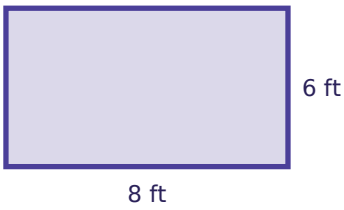


**Task card 22** Christmas Math

Zoe eats $\frac{4}{9}$ of a Christmas cake. Sam eats $\frac{1}{9}$ of it. What fraction of the Christmas cake did they eat together?

**Task card 23** Christmas Math

Each tin holds 12 cookies. The bakery fills 22 tins. How many cookies is that?

**Task card 24** Christmas Math

There are 117 candy canes. Each tin holds 8. After filling as many tins as possible, how many candy canes are left over?

# Christmas Math Task Cards

Recording sheet · Grade 4 · Read each story and solve.

Name: _____ Date: _____

Scan to check your answers

| | | | |
|---|---|---|---|
| 1 | 2 | 3 | 4 |
| 5 | 6 | 7 | 8 |
| 9 | 10 | 11 | 12 |
| 13 | 14 | 15 | 16 |
| 17 | 18 | 19 | 20 |
| 21 | 22 | 23 | 24 |

# Christmas Math Task Cards: Answer Key

Grade 4 · Hard

The answers online

| | | |
|---|---|---|
| **1.** 1748 | **2.** 5 | **3.** $\frac{8}{9}$ |
| **4.** 16 | **5.** 26 | **6.** 1932 |
| **7.** $\frac{7}{12}$ | **8.** 38 | **9.** 42 |
| **10.** 26 | **11.** 2 | **12.** 476 |
| **13.** $\frac{7}{8}$ | **14.** 2 | **15.** $\frac{5}{12}$ |
| **16.** 441 | **17.** 14 | **18.** $\frac{7}{8}$ |
| **19.** 989 | **20.** 3 | **21.** 28 |
| **22.** $\frac{5}{9}$ | **23.** 264 | **24.** 5 |