Task card 1 Christmas Math

Ava hangs lights all the way around a rectangular window that is 9 feet wide and 8 feet tall. How many feet of lights does Ava need?



Task card 2 Christmas Math

Ella hangs lights all the way around a rectangular window that is 5 feet wide and 4 feet tall. How many feet of lights does Ella need?



Task card 3 Christmas Math

Leo eats $\frac{1}{8}$ of a Christmas cake. Ella eats $\frac{2}{8}$ of it. What fraction of the Christmas cake did they eat together?

Task card 4 Christmas Math

There are 78 candy canes. Each tin holds 9. After filling as many tins as possible, how many candy canes are left over?

Task card 5 Christmas Math

Each tin holds 7 gingerbread men. The bakery fills 27 tins. How many gingerbread men is that?

Task card 6 Christmas Math

Each tin holds 5 cookies. The bakery fills 19 tins. How many cookies is that?

Task card 7 Christmas Math

Leo eats $\frac{9}{12}$ of a Christmas cake. Omar eats $\frac{2}{12}$ of it. What fraction of the Christmas cake did they eat together?

Task card 8 Christmas Math

There are 67 gingerbread men. Each tin holds 8. After filling as many tins as possible, how many gingerbread men are left over?

Task card 9 Christmas Math

Omar hangs lights all the way around a rectangular window that is 6 feet wide and 5 feet tall. How many feet of lights does Omar need?

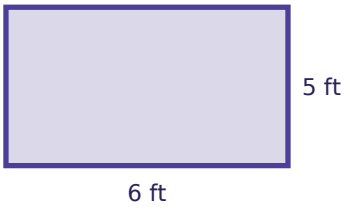

Task card 10 Christmas Math

Each tin holds 7 gingerbread men. The bakery fills 67 tins. How many gingerbread men is that?

Task card 11 Christmas Math

There are 92 cookies. Each tin holds 7. How many tins can be filled all the way?

Task card 12 Christmas Math

There are 38 cookies. Each tin holds 4. How many tins can be filled all the way?

Task card 13 Christmas Math

Each tin holds 4 cookies. The bakery fills 29 tins. How many cookies is that?

Task card 14 Christmas Math

Leo hangs lights all the way around a rectangular window that is 4 feet wide and 2 feet tall. How many feet of lights does Leo need?

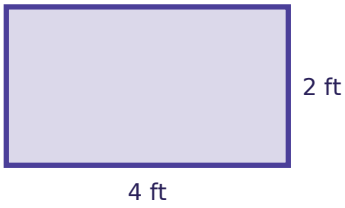

Task card 15 Christmas Math

Ella eats $\frac{2}{8}$ of a Christmas cake. Mia eats $\frac{3}{8}$ of it. What fraction of the Christmas cake did they eat together?

Task card 16 Christmas Math

Sam eats $\frac{6}{12}$ of a Christmas cake. Ella eats $\frac{1}{12}$ of it. What fraction of the Christmas cake did they eat together?

Task card 17 Christmas Math

There are 115 gingerbread men. Each tin holds 7. After filling as many tins as possible, how many gingerbread men are left over?

Task card 18 Christmas Math

Ella eats $\frac{1}{8}$ of a Christmas cake. Sam eats $\frac{2}{8}$ of it. What fraction of the Christmas cake did they eat together?

Task card 19 Christmas Math

Each tin holds 14 candy canes. The bakery fills 67 tins. How many candy canes is that?

Task card 20 Christmas Math

Zoe hangs lights all the way around a rectangular window that is 8 feet wide and 7 feet tall. How many feet of lights does Zoe need?

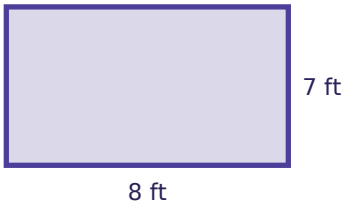

Task card 21 Christmas Math

Each tin holds 21 gingerbread men. The bakery fills 72 tins. How many gingerbread men is that?

Task card 22 Christmas Math

There are 38 cookies. Each tin holds 5. How many tins can be filled all the way?

Task card 23 Christmas Math

Noah eats $\frac{8}{10}$ of a Christmas cake. Lily eats $\frac{1}{10}$ of it. What fraction of the Christmas cake did they eat together?

Task card 24 Christmas Math

Mia hangs lights all the way around a rectangular window that is 7 feet wide and 4 feet tall. How many feet of lights does Mia need?

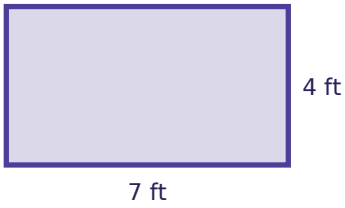

Christmas Math Task Cards

Recording sheet · Grade 4 · Read each story and solve.

Name: _____ Date: _____

Scan to check your answers

1	2	3	4
5	6	7	8
9	10	11	12
13	14	15	16
17	18	19	20
21	22	23	24

Christmas Math Task Cards: Answer Key

Grade 4 · Medium

The answers online

1. 34	**2.** 18	**3.** $\frac{3}{8}$
4. 6	**5.** 189	**6.** 95
7. $\frac{11}{12}$	**8.** 3	**9.** 22
10. 469	**11.** 13	**12.** 9
13. 116	**14.** 12	**15.** $\frac{5}{8}$
16. $\frac{7}{12}$	**17.** 3	**18.** $\frac{3}{8}$
19. 938	**20.** 30	**21.** 1512
22. 7	**23.** $\frac{9}{10}$	**24.** 22