Task card 1 Christmas Math

Each tin holds 23 cookies. The bakery fills 76 tins. How many cookies is that?

Task card 2 Christmas Math

There are 28 candy canes. Each tin holds 5. How many tins can be filled all the way?

Task card 3 Christmas Math

Ava eats $\frac{2}{9}$ of a Christmas cake. Lily eats $\frac{6}{9}$ of it. What fraction of the Christmas cake did they eat together?

Task card 4 Christmas Math

There are 49 gingerbread men. Each tin holds 3. How many tins can be filled all the way?

Task card 5 Christmas Math

Ben hangs lights all the way around a rectangular window that is 8 feet wide and 5 feet tall. How many feet of lights does Ben need?

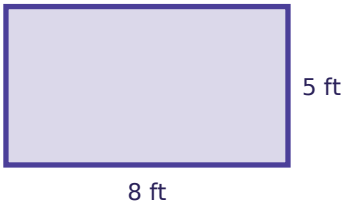

Task card 6 Christmas Math

Each tin holds 23 cookies. The bakery fills 84 tins. How many cookies is that?

Task card 7 Christmas Math

Sam eats $\frac{4}{12}$ of a Christmas cake. Noah eats $\frac{3}{12}$ of it. What fraction of the Christmas cake did they eat together?

Task card 8 Christmas Math

Noah hangs lights all the way around a rectangular window that is 13 feet wide and 6 feet tall. How many feet of lights does Noah need?

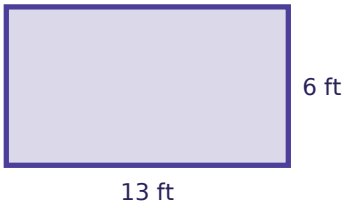

Task card 9 Christmas Math

Ella hangs lights all the way around a rectangular window that is 11 feet wide and 10 feet tall. How many feet of lights does Ella need?

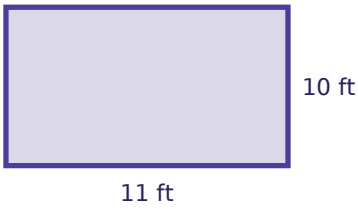

Task card 10 Christmas Math

Lily hangs lights all the way around a rectangular window that is 8 feet wide and 5 feet tall. How many feet of lights does Lily need?

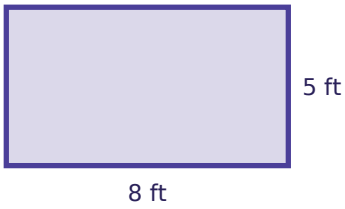

Task card 11 Christmas Math

There are 78 cookies. Each tin holds 4. After filling as many tins as possible, how many cookies are left over?

Task card 12 Christmas Math

Each tin holds 17 candy canes. The bakery fills 28 tins. How many candy canes is that?

Task card 13 Christmas Math

Leo eats $\frac{5}{8}$ of a Christmas cake. Lily eats $\frac{2}{8}$ of it. What fraction of the Christmas cake did they eat together?

Task card 14 Christmas Math

There are 20 candy canes. Each tin holds 3. After filling as many tins as possible, how many candy canes are left over?

Task card 15 Christmas Math

Lily eats $\frac{1}{12}$ of a Christmas cake. Ben eats $\frac{4}{12}$ of it. What fraction of the Christmas cake did they eat together?

Task card 16 Christmas Math

Each tin holds 21 cookies. The bakery fills 21 tins. How many cookies is that?

Task card 17 Christmas Math

Zoe hangs lights all the way around a rectangular window that is 4 feet wide and 3 feet tall. How many feet of lights does Zoe need?

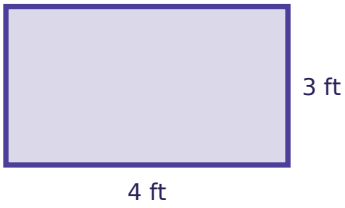

Task card 18 Christmas Math

Ava eats $\frac{3}{8}$ of a Christmas cake. Mia eats $\frac{4}{8}$ of it. What fraction of the Christmas cake did they eat together?

Task card 19 Christmas Math

Each tin holds 23 candy canes. The bakery fills 43 tins. How many candy canes is that?

Task card 20 Christmas Math

There are 27 candy canes. Each tin holds 4. After filling as many tins as possible, how many candy canes are left over?

Task card 21 Christmas Math

Omar hangs lights all the way around a rectangular window that is 8 feet wide and 6 feet tall. How many feet of lights does Omar need?

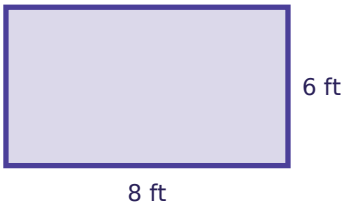

Task card 22 Christmas Math

Zoe eats $\frac{4}{9}$ of a Christmas cake. Sam eats $\frac{1}{9}$ of it. What fraction of the Christmas cake did they eat together?

Task card 23 Christmas Math

Each tin holds 12 cookies. The bakery fills 22 tins. How many cookies is that?

Task card 24 Christmas Math

There are 117 candy canes. Each tin holds 8. After filling as many tins as possible, how many candy canes are left over?

Christmas Math Task Cards

Recording sheet · Grade 4 · Read each story and solve.

Name: _____ Date: _____

Scan to check your answers

1	2	3	4
5	6	7	8
9	10	11	12
13	14	15	16
17	18	19	20
21	22	23	24

Christmas Math Task Cards: Answer Key

Grade 4 · Hard

The answers online

1. 1748	**2.** 5	**3.** $\frac{8}{9}$
4. 16	**5.** 26	**6.** 1932
7. $\frac{7}{12}$	**8.** 38	**9.** 42
10. 26	**11.** 2	**12.** 476
13. $\frac{7}{8}$	**14.** 2	**15.** $\frac{5}{12}$
16. 441	**17.** 14	**18.** $\frac{7}{8}$
19. 989	**20.** 3	**21.** 28
22. $\frac{5}{9}$	**23.** 264	**24.** 5