Task card 1 Christmas Math

There are 24 candy canes. Each tin holds 5. How many tins can be filled all the way?

Task card 2 Christmas Math

Lily hangs lights all the way around a rectangular window that is 7 feet wide and 2 feet tall. How many feet of lights does Lily need?



Task card 3 Christmas Math

Each tin holds 6 candy canes. The bakery fills 16 tins. How many candy canes is that?

Task card 4 Christmas Math

Zoe hangs lights all the way around a rectangular window that is 6 feet wide and 4 feet tall. How many feet of lights does Zoe need?



Task card 5 Christmas Math

Lily eats $\frac{1}{5}$ of a Christmas cake. Ben eats $\frac{2}{5}$ of it. What fraction of the Christmas cake did they eat together?

Task card 6 Christmas Math

Omar eats $\frac{1}{5}$ of a Christmas cake. Mia eats $\frac{2}{5}$ of it. What fraction of the Christmas cake did they eat together?

Task card 7 Christmas Math

Each tin holds 7 candy canes. The bakery fills 21 tins. How many candy canes is that?

Task card 8 Christmas Math

There are 47 cookies. Each tin holds 6. How many tins can be filled all the way?

Task card 9 Christmas Math

There are 45 gingerbread men. Each tin holds 8. After filling as many tins as possible, how many gingerbread men are left over?

Task card 10 Christmas Math

Each tin holds 9 cookies. The bakery fills 14 tins. How many cookies is that?

Task card 11 Christmas Math

Ella hangs lights all the way around a rectangular window that is 6 feet wide and 3 feet tall. How many feet of lights does Ella need?

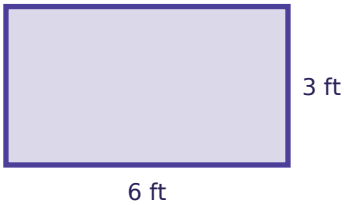

Task card 12 Christmas Math

Each tin holds 6 candy canes. The bakery fills 32 tins. How many candy canes is that?

Task card 13 Christmas Math

There are 42 cookies. Each tin holds 8. After filling as many tins as possible, how many cookies are left over?

Task card 14 Christmas Math

Ben hangs lights all the way around a rectangular window that is 7 feet wide and 5 feet tall. How many feet of lights does Ben need?

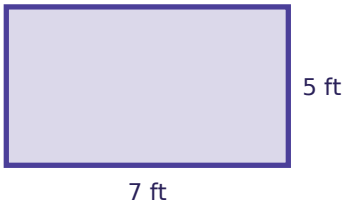

Task card 15 Christmas Math

Sam eats $\frac{2}{7}$ of a Christmas cake. Zoe eats $\frac{3}{7}$ of it. What fraction of the Christmas cake did they eat together?

Task card 16 Christmas Math

Sam eats $\frac{1}{8}$ of a Christmas cake. Ella eats $\frac{2}{8}$ of it. What fraction of the Christmas cake did they eat together?

Task card 17 Christmas Math

Each tin holds 5 cookies. The bakery fills 13 tins. How many cookies is that?

Task card 18 Christmas Math

Each tin holds 3 gingerbread men. The bakery fills 12 tins. How many gingerbread men is that?

Task card 19 Christmas Math

Zoe eats $\frac{2}{7}$ of a Christmas cake. Lily eats $\frac{1}{7}$ of it. What fraction of the Christmas cake did they eat together?

Task card 20 Christmas Math

Ben eats $\frac{1}{8}$ of a Christmas cake. Mia eats $\frac{2}{8}$ of it. What fraction of the Christmas cake did they eat together?

Task card 21 Christmas Math

There are 35 cookies. Each tin holds 3. After filling as many tins as possible, how many cookies are left over?

Task card 22 Christmas Math

Sam hangs lights all the way around a rectangular window that is 6 feet wide and 3 feet tall. How many feet of lights does Sam need?



Task card 23 Christmas Math

Ava hangs lights all the way around a rectangular window that is 8 feet wide and 2 feet tall. How many feet of lights does Ava need?

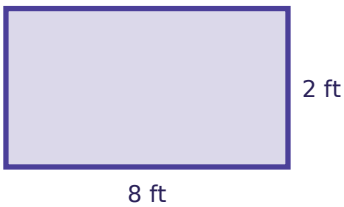

Task card 24 Christmas Math

There are 67 cookies. Each tin holds 9. How many tins can be filled all the way?

Christmas Math Task Cards

Recording sheet · Grade 4 · Read each story and solve.

Name: _____ Date: _____

Scan to check your answers

1	2	3	4
5	6	7	8
9	10	11	12
13	14	15	16
17	18	19	20
21	22	23	24

Christmas Math Task Cards: Answer Key

Grade 4 · Easy

The answers online

1. 4	**2.** 18	**3.** 96
4. 20	**5.** $\frac{3}{5}$	**6.** $\frac{3}{5}$
7. 147	**8.** 7	**9.** 5
10. 126	**11.** 18	**12.** 192
13. 2	**14.** 24	**15.** $\frac{5}{7}$
16. $\frac{3}{8}$	**17.** 65	**18.** 36
19. $\frac{3}{7}$	**20.** $\frac{3}{8}$	**21.** 2
22. 18	**23.** 20	**24.** 7