Christmas Math · 1

Each tin holds 23 cookies. The bakery fills 76 tins. How many cookies is that?

Christmas Math · 2

There are 28 candy canes. Each tin holds 5. How many tins can be filled all the way?

Christmas Math · 3

Ava eats $\frac{2}{9}$ of a Christmas cake. Lily eats $\frac{6}{9}$ of it. What fraction of the Christmas cake did they eat together?

Christmas Math · 4

There are 49 gingerbread men. Each tin holds 3. How many tins can be filled all the way?

Christmas Math · 5

Ben hangs lights all the way around a rectangular window that is 8 feet wide and 5 feet tall. How many feet of lights does Ben need?



Christmas Math · 6

Each tin holds 23 cookies. The bakery fills 84 tins. How many cookies is that?

Christmas Math · 7

Sam eats $\frac{4}{12}$ of a Christmas cake. Noah eats $\frac{3}{12}$ of it. What fraction of the Christmas cake did they eat together?

Christmas Math · 8

Noah hangs lights all the way around a rectangular window that is 13 feet wide and 6 feet tall. How many feet of lights does Noah need?

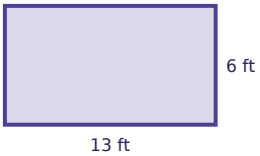

Christmas Math · 2

ANSWER

5

Christmas Math · 1

ANSWER

1748

Christmas Math · 4

ANSWER

16

Christmas Math · 3

ANSWER

$$\frac{8}{9}$$

Christmas Math · 6

ANSWER

1932

Christmas Math · 5

ANSWER

26

Christmas Math · 8

ANSWER

38

Christmas Math · 7

ANSWER

$$\frac{7}{12}$$

Christmas Math · 9

Ella hangs lights all the way around a rectangular window that is 11 feet wide and 10 feet tall. How many feet of lights does Ella need?

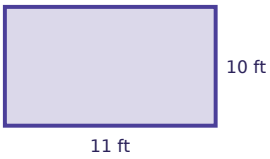

Christmas Math · 10

Lily hangs lights all the way around a rectangular window that is 8 feet wide and 5 feet tall. How many feet of lights does Lily need?

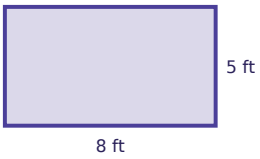

Christmas Math · 11

There are 78 cookies. Each tin holds 4. After filling as many tins as possible, how many cookies are left over?

Christmas Math · 12

Each tin holds 17 candy canes. The bakery fills 28 tins. How many candy canes is that?

Christmas Math · 13

Leo eats $\frac{5}{8}$ of a Christmas cake. Lily eats $\frac{2}{8}$ of it. What fraction of the Christmas cake did they eat together?

Christmas Math · 14

There are 20 candy canes. Each tin holds 3. After filling as many tins as possible, how many candy canes are left over?

Christmas Math · 15

Lily eats $\frac{1}{12}$ of a Christmas cake. Ben eats $\frac{4}{12}$ of it. What fraction of the Christmas cake did they eat together?

Christmas Math · 16

Each tin holds 21 cookies. The bakery fills 21 tins. How many cookies is that?

Christmas Math · 10

ANSWER

26

Christmas Math · 9

ANSWER

42

Christmas Math · 12

ANSWER

476

Christmas Math · 11

ANSWER

2

Christmas Math · 14

ANSWER

2

Christmas Math · 13

ANSWER

$$\frac{7}{8}$$

Christmas Math · 16

ANSWER

441

Christmas Math · 15

ANSWER

$$\frac{5}{12}$$

Christmas Math · 17

Zoe hangs lights all the way around a rectangular window that is 4 feet wide and 3 feet tall. How many feet of lights does Zoe need?

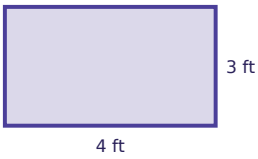

Christmas Math · 18

Ava eats $\frac{3}{8}$ of a Christmas cake. Mia eats $\frac{4}{8}$ of it. What fraction of the Christmas cake did they eat together?

Christmas Math · 19

Each tin holds 23 candy canes. The bakery fills 43 tins. How many candy canes is that?

Christmas Math · 20

There are 27 candy canes. Each tin holds 4. After filling as many tins as possible, how many candy canes are left over?

Christmas Math · 21

Omar hangs lights all the way around a rectangular window that is 8 feet wide and 6 feet tall. How many feet of lights does Omar need?

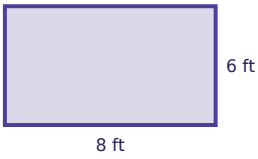

Christmas Math · 22

Zoe eats $\frac{4}{9}$ of a Christmas cake. Sam eats $\frac{1}{9}$ of it. What fraction of the Christmas cake did they eat together?

Christmas Math · 23

Each tin holds 12 cookies. The bakery fills 22 tins. How many cookies is that?

Christmas Math · 24

There are 117 candy canes. Each tin holds 8. After filling as many tins as possible, how many candy canes are left over?

Christmas Math · 18

ANSWER

$\frac{7}{8}$

Christmas Math · 17

ANSWER

14

Christmas Math · 20

ANSWER

3

Christmas Math · 19

ANSWER

989

Christmas Math · 22

ANSWER

$\frac{5}{9}$

Christmas Math · 21

ANSWER

28

Christmas Math · 24

ANSWER

5

Christmas Math · 23

ANSWER

264