Christmas Math · 1

There are 24 candy canes. Each tin holds 5. How many tins can be filled all the way?

Christmas Math · 2

Lily hangs lights all the way around a rectangular window that is 7 feet wide and 2 feet tall. How many feet of lights does Lily need?

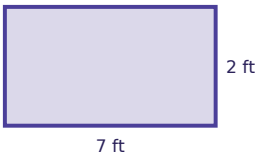

Christmas Math · 3

Each tin holds 6 candy canes. The bakery fills 16 tins. How many candy canes is that?

Christmas Math · 4

Zoe hangs lights all the way around a rectangular window that is 6 feet wide and 4 feet tall. How many feet of lights does Zoe need?

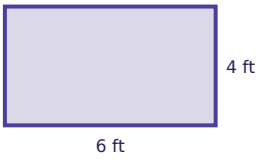

Christmas Math · 5

Lily eats $\frac{1}{5}$ of a Christmas cake. Ben eats $\frac{2}{5}$ of it. What fraction of the Christmas cake did they eat together?

Christmas Math · 6

Omar eats $\frac{1}{5}$ of a Christmas cake. Mia eats $\frac{2}{5}$ of it. What fraction of the Christmas cake did they eat together?

Christmas Math · 7

Each tin holds 7 candy canes. The bakery fills 21 tins. How many candy canes is that?

Christmas Math · 8

There are 47 cookies. Each tin holds 6. How many tins can be filled all the way?

Christmas Math · 2

ANSWER

18

Christmas Math · 1

ANSWER

4

Christmas Math · 4

ANSWER

20

Christmas Math · 3

ANSWER

96

Christmas Math · 6

ANSWER

$\frac{3}{5}$

Christmas Math · 5

ANSWER

$\frac{3}{5}$

Christmas Math · 8

ANSWER

7

Christmas Math · 7

ANSWER

147

Christmas Math · 9

There are 45 gingerbread men. Each tin holds 8. After filling as many tins as possible, how many gingerbread men are left over?

Christmas Math · 10

Each tin holds 9 cookies. The bakery fills 14 tins. How many cookies is that?

Christmas Math · 11

Ella hangs lights all the way around a rectangular window that is 6 feet wide and 3 feet tall. How many feet of lights does Ella need?

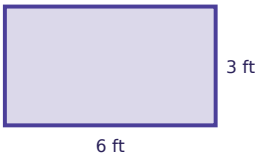

Christmas Math · 12

Each tin holds 6 candy canes. The bakery fills 32 tins. How many candy canes is that?

Christmas Math · 13

There are 42 cookies. Each tin holds 8. After filling as many tins as possible, how many cookies are left over?

Christmas Math · 14

Ben hangs lights all the way around a rectangular window that is 7 feet wide and 5 feet tall. How many feet of lights does Ben need?

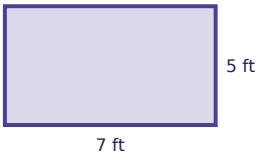

Christmas Math · 15

Sam eats $\frac{2}{7}$ of a Christmas cake. Zoe eats $\frac{3}{7}$ of it. What fraction of the Christmas cake did they eat together?

Christmas Math · 16

Sam eats $\frac{1}{8}$ of a Christmas cake. Ella eats $\frac{2}{8}$ of it. What fraction of the Christmas cake did they eat together?

Christmas Math · 10

ANSWER

126

Christmas Math · 9

ANSWER

5

Christmas Math · 12

ANSWER

192

Christmas Math · 11

ANSWER

18

Christmas Math · 14

ANSWER

24

Christmas Math · 13

ANSWER

2

Christmas Math · 16

ANSWER

$$\frac{3}{8}$$

Christmas Math · 15

ANSWER

$$\frac{5}{7}$$

Christmas Math · 17

Each tin holds 5 cookies. The bakery fills 13 tins. How many cookies is that?

Christmas Math · 18

Each tin holds 3 gingerbread men. The bakery fills 12 tins. How many gingerbread men is that?

Christmas Math · 19

Zoe eats $\frac{2}{7}$ of a Christmas cake. Lily eats $\frac{1}{7}$ of it. What fraction of the Christmas cake did they eat together?

Christmas Math · 20

Ben eats $\frac{1}{8}$ of a Christmas cake. Mia eats $\frac{2}{8}$ of it. What fraction of the Christmas cake did they eat together?

Christmas Math · 21

There are 35 cookies. Each tin holds 3. After filling as many tins as possible, how many cookies are left over?

Christmas Math · 22

Sam hangs lights all the way around a rectangular window that is 6 feet wide and 3 feet tall. How many feet of lights does Sam need?

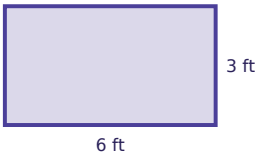

Christmas Math · 23

Ava hangs lights all the way around a rectangular window that is 8 feet wide and 2 feet tall. How many feet of lights does Ava need?

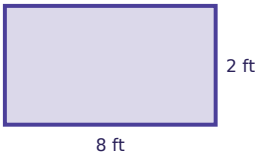

Christmas Math · 24

There are 67 cookies. Each tin holds 9. How many tins can be filled all the way?

Christmas Math · 18

ANSWER

36

Christmas Math · 17

ANSWER

65

Christmas Math · 20

ANSWER

$$\frac{3}{8}$$

Christmas Math · 19

ANSWER

$$\frac{3}{7}$$

Christmas Math · 22

ANSWER

18

Christmas Math · 21

ANSWER

2

Christmas Math · 24

ANSWER

7

Christmas Math · 23

ANSWER

20