Task card 1 Back to School Math

There are 73 muffins. Each lunch box holds 5. After filling as many lunch boxs as possible, how many muffins are left over?

Task card 2 Back to School Math

Each lunch box holds 13 granola bars. The bakery fills 82 lunch boxs. How many granola bars is that?

Task card 3 Back to School Math

Noah puts a paper border all the way around a rectangular bulletin board that is 9 feet wide and 4 feet tall. How many feet of border does Noah need?



Task card 4 Back to School Math

Sam puts a paper border all the way around a rectangular bulletin board that is 9 feet wide and 5 feet tall. How many feet of border does Sam need?

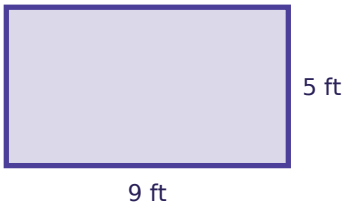

Task card 5 Back to School Math

Lily eats $\frac{1}{10}$ of a pizza. Ava eats $\frac{8}{10}$ of it. What fraction of the pizza did they eat together?

Task card 6 Back to School Math

Leo eats $\frac{4}{12}$ of a pizza. Ella eats $\frac{3}{12}$ of it. What fraction of the pizza did they eat together?

Task card 7 Back to School Math

Each lunch box holds 15 granola bars. The bakery fills 30 lunch boxs. How many granola bars is that?

Task card 8 Back to School Math

There are 91 granola bars. Each lunch box holds 9. After filling as many lunch boxs as possible, how many granola bars are left over?

Task card 9 Back to School Math

Each lunch box holds 19 muffins. The bakery fills 91 lunch boxs. How many muffins is that?

Task card 10 Back to School Math

Lily puts a paper border all the way around a rectangular bulletin board that is 4 feet wide and 2 feet tall. How many feet of border does Lily need?

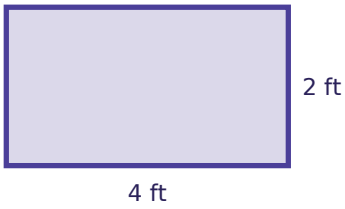

Task card 11 Back to School Math

Noah eats $\frac{1}{8}$ of a pizza. Sam eats $\frac{4}{8}$ of it. What fraction of the pizza did they eat together?

Task card 12 Back to School Math

There are 50 granola bars. Each lunch box holds 3. After filling as many lunch boxs as possible, how many granola bars are left over?

Task card 13 Back to School Math

Ava puts a paper border all the way around a rectangular bulletin board that is 13 feet wide and 8 feet tall. How many feet of border does Ava need?

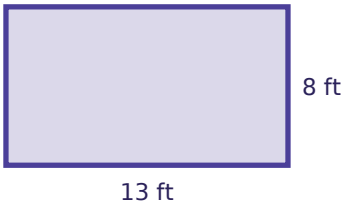

Task card 14 Back to School Math

Mia eats $\frac{1}{10}$ of a pizza. Ava eats $\frac{2}{10}$ of it. What fraction of the pizza did they eat together?

Task card 15 Back to School Math

There are 31 granola bars. Each lunch box holds 6. After filling as many lunch boxs as possible, how many granola bars are left over?

Task card 16 Back to School Math

Each lunch box holds 22 granola bars. The bakery fills 15 lunch boxs. How many granola bars is that?

Task card 17 Back to School Math

Each lunch box holds 14 granola bars. The bakery fills 59 lunch boxs. How many granola bars is that?

Task card 18 Back to School Math

Leo eats $\frac{3}{9}$ of a pizza. Ben eats $\frac{4}{9}$ of it. What fraction of the pizza did they eat together?

Task card 19 Back to School Math

Leo puts a paper border all the way around a rectangular bulletin board that is 9 feet wide and 4 feet tall. How many feet of border does Leo need?

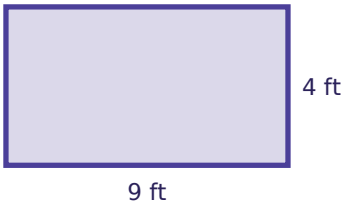

Task card 20 Back to School Math

Noah eats $\frac{3}{8}$ of a pizza. Omar eats $\frac{2}{8}$ of it. What fraction of the pizza did they eat together?

Task card 21 Back to School Math

Each lunch box holds 13 granola bars. The bakery fills 53 lunch boxs. How many granola bars is that?

Task card 22 Back to School Math

Ella puts a paper border all the way around a rectangular bulletin board that is 10 feet wide and 7 feet tall. How many feet of border does Ella need?

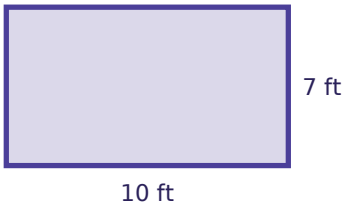

Task card 23 Back to School Math

There are 77 muffins. Each lunch box holds 5. How many lunch boxs can be filled all the way?

Task card 24 Back to School Math

There are 82 muffins. Each lunch box holds 9. After filling as many lunch boxs as possible, how many muffins are left over?

Back to School Math Task Cards

Recording sheet · Grade 4 · Read each story and solve.

Name: _____ Date: _____

Scan to check your answers

1	2	3	4
5	6	7	8
9	10	11	12
13	14	15	16
17	18	19	20
21	22	23	24

Back to School Math Task Cards: Answer Key

Grade 4 · Hard

The answers online

1. 3	**2.** 1066	**3.** 26
4. 28	**5.** $\frac{9}{10}$	**6.** $\frac{7}{12}$
7. 450	**8.** 1	**9.** 1729
10. 12	**11.** $\frac{5}{8}$	**12.** 2
13. 42	**14.** $\frac{3}{10}$	**15.** 1
16. 330	**17.** 826	**18.** $\frac{7}{9}$
19. 26	**20.** $\frac{5}{8}$	**21.** 689
22. 34	**23.** 15	**24.** 1