Back to School Math · 1

Each lunch box holds 7 oatmeal cookies. The bakery fills 29 lunch boxs. How many oatmeal cookies is that?

Back to School Math · 2

There are 68 oatmeal cookies. Each lunch box holds 6. How many lunch boxs can be filled all the way?

Back to School Math · 3

Each lunch box holds 9 muffins. The bakery fills 12 lunch boxs. How many muffins is that?

Back to School Math · 4

Omar eats $\frac{1}{9}$ of a pizza. Lily eats $\frac{1}{9}$ of it. What fraction of the pizza did they eat together?

Back to School Math · 5

Sam eats $\frac{8}{10}$ of a pizza. Lily eats $\frac{1}{10}$ of it. What fraction of the pizza did they eat together?

Back to School Math · 6

There are 73 granola bars. Each lunch box holds 5. After filling as many lunch boxs as possible, how many granola bars are left over?

Back to School Math · 7

Ava puts a paper border all the way around a rectangular bulletin board that is 10 feet wide and 4 feet tall. How many feet of border does Ava need?

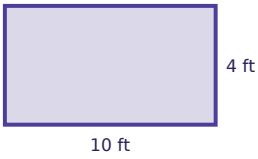

Back to School Math · 8

Noah puts a paper border all the way around a rectangular bulletin board that is 5 feet wide and 2 feet tall. How many feet of border does Noah need?

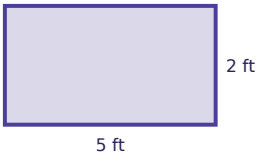

Back to School Math · 2

ANSWER

11

Back to School Math · 1

ANSWER

203

Back to School Math · 4

ANSWER

$$\frac{2}{9}$$

Back to School Math · 3

ANSWER

108

Back to School Math · 6

ANSWER

3

Back to School Math · 5

ANSWER

$$\frac{9}{10}$$

Back to School Math · 8

ANSWER

14

Back to School Math · 7

ANSWER

28

Back to School Math · 9

Zoe puts a paper border all the way around a rectangular bulletin board that is 10 feet wide and 8 feet tall. How many feet of border does Zoe need?

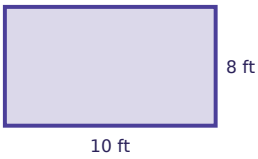

Back to School Math · 10

There are 34 muffins. Each lunch box holds 3. After filling as many lunch boxs as possible, how many muffins are left over?

Back to School Math · 11

Ella puts a paper border all the way around a rectangular bulletin board that is 6 feet wide and 3 feet tall. How many feet of border does Ella need?



Back to School Math · 12

Ben eats $\frac{5}{12}$ of a pizza. Omar eats $\frac{6}{12}$ of it. What fraction of the pizza did they eat together?

Back to School Math · 13

Lily eats $\frac{5}{10}$ of a pizza. Sam eats $\frac{4}{10}$ of it. What fraction of the pizza did they eat together?

Back to School Math · 14

Each lunch box holds 5 oatmeal cookies. The bakery fills 41 lunch boxs. How many oatmeal cookies is that?

Back to School Math · 15

There are 94 oatmeal cookies. Each lunch box holds 7. How many lunch boxs can be filled all the way?

Back to School Math · 16

Each lunch box holds 4 muffins. The bakery fills 50 lunch boxs. How many muffins is that?

Back to School Math · 10

ANSWER

1

Back to School Math · 9

ANSWER

36

Back to School Math · 12

ANSWER

$$\frac{11}{12}$$

Back to School Math · 11

ANSWER

18

Back to School Math · 14

ANSWER

205

Back to School Math · 13

ANSWER

$$\frac{9}{10}$$

Back to School Math · 16

ANSWER

200

Back to School Math · 15

ANSWER

13

Back to School Math · 17

Each lunch box holds 24 muffins. The bakery fills 75 lunch boxs. How many muffins is that?

Back to School Math · 18

Omar eats $\frac{5}{10}$ of a pizza. Ella eats $\frac{4}{10}$ of it. What fraction of the pizza did they eat together?

Back to School Math · 19

Mia eats $\frac{4}{10}$ of a pizza. Ben eats $\frac{3}{10}$ of it. What fraction of the pizza did they eat together?

Back to School Math · 20

Each lunch box holds 19 granola bars. The bakery fills 35 lunch boxs. How many granola bars is that?

Back to School Math · 21

Mia puts a paper border all the way around a rectangular bulletin board that is 5 feet wide and 4 feet tall. How many feet of border does Mia need?

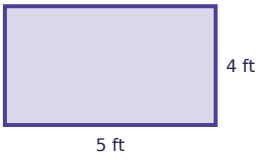

Back to School Math · 22

There are 58 oatmeal cookies. Each lunch box holds 4. How many lunch boxs can be filled all the way?

Back to School Math · 23

Ben puts a paper border all the way around a rectangular bulletin board that is 12 feet wide and 3 feet tall. How many feet of border does Ben need?

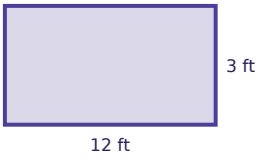

Back to School Math · 24

There are 45 muffins. Each lunch box holds 7. After filling as many lunch boxs as possible, how many muffins are left over?

Back to School Math · 18

ANSWER

$\frac{9}{10}$

Back to School Math · 17

ANSWER

1800

Back to School Math · 20

ANSWER

665

Back to School Math · 19

ANSWER

$\frac{7}{10}$

Back to School Math · 22

ANSWER

14

Back to School Math · 21

ANSWER

18

Back to School Math · 24

ANSWER

3

Back to School Math · 23

ANSWER

30