Back to School Math · 1

There are 73 muffins. Each lunch box holds 5. After filling as many lunch boxs as possible, how many muffins are left over?

Back to School Math · 2

Each lunch box holds 13 granola bars. The bakery fills 82 lunch boxs. How many granola bars is that?

Back to School Math · 3

Noah puts a paper border all the way around a rectangular bulletin board that is 9 feet wide and 4 feet tall. How many feet of border does Noah need?

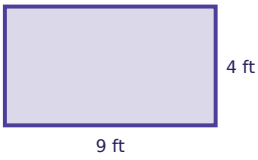

Back to School Math · 4

Sam puts a paper border all the way around a rectangular bulletin board that is 9 feet wide and 5 feet tall. How many feet of border does Sam need?

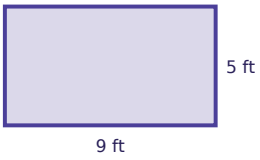

Back to School Math · 5

Lily eats $\frac{1}{10}$ of a pizza. Ava eats $\frac{8}{10}$ of it. What fraction of the pizza did they eat together?

Back to School Math · 6

Leo eats $\frac{4}{12}$ of a pizza. Ella eats $\frac{3}{12}$ of it. What fraction of the pizza did they eat together?

Back to School Math · 7

Each lunch box holds 15 granola bars. The bakery fills 30 lunch boxs. How many granola bars is that?

Back to School Math · 8

There are 91 granola bars. Each lunch box holds 9. After filling as many lunch boxs as possible, how many granola bars are left over?

Back to School Math · 2

ANSWER

1066

Back to School Math · 1

ANSWER

3

Back to School Math · 4

ANSWER

28

Back to School Math · 3

ANSWER

26

Back to School Math · 6

ANSWER

$$\frac{7}{12}$$

Back to School Math · 5

ANSWER

$$\frac{9}{10}$$

Back to School Math · 8

ANSWER

1

Back to School Math · 7

ANSWER

450

Back to School Math · 9

Each lunch box holds 19 muffins. The bakery fills 91 lunch boxs. How many muffins is that?

Back to School Math · 10

Lily puts a paper border all the way around a rectangular bulletin board that is 4 feet wide and 2 feet tall. How many feet of border does Lily need?

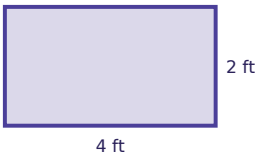

Back to School Math · 11

Noah eats $\frac{1}{8}$ of a pizza. Sam eats $\frac{4}{8}$ of it. What fraction of the pizza did they eat together?

Back to School Math · 12

There are 50 granola bars. Each lunch box holds 3. After filling as many lunch boxs as possible, how many granola bars are left over?

Back to School Math · 13

Ava puts a paper border all the way around a rectangular bulletin board that is 13 feet wide and 8 feet tall. How many feet of border does Ava need?



Back to School Math · 14

Mia eats $\frac{1}{10}$ of a pizza. Ava eats $\frac{2}{10}$ of it. What fraction of the pizza did they eat together?

Back to School Math · 15

There are 31 granola bars. Each lunch box holds 6. After filling as many lunch boxs as possible, how many granola bars are left over?

Back to School Math · 16

Each lunch box holds 22 granola bars. The bakery fills 15 lunch boxs. How many granola bars is that?

Back to School Math · 10

ANSWER

12

Back to School Math · 9

ANSWER

1729

Back to School Math · 12

ANSWER

2

Back to School Math · 11

ANSWER

$$\frac{5}{8}$$

Back to School Math · 14

ANSWER

$$\frac{3}{10}$$

Back to School Math · 13

ANSWER

42

Back to School Math · 16

ANSWER

330

Back to School Math · 15

ANSWER

1

Back to School Math · 17

Each lunch box holds 14 granola bars. The bakery fills 59 lunch boxs. How many granola bars is that?

Back to School Math · 18

Leo eats $\frac{3}{9}$ of a pizza. Ben eats $\frac{4}{9}$ of it. What fraction of the pizza did they eat together?

Back to School Math · 19

Leo puts a paper border all the way around a rectangular bulletin board that is 9 feet wide and 4 feet tall. How many feet of border does Leo need?

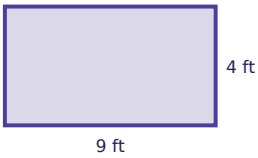

Back to School Math · 20

Noah eats $\frac{3}{8}$ of a pizza. Omar eats $\frac{2}{8}$ of it. What fraction of the pizza did they eat together?

Back to School Math · 21

Each lunch box holds 13 granola bars. The bakery fills 53 lunch boxs. How many granola bars is that?

Back to School Math · 22

Ella puts a paper border all the way around a rectangular bulletin board that is 10 feet wide and 7 feet tall. How many feet of border does Ella need?

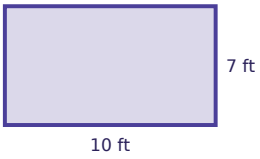

Back to School Math · 23

There are 77 muffins. Each lunch box holds 5. How many lunch boxs can be filled all the way?

Back to School Math · 24

There are 82 muffins. Each lunch box holds 9. After filling as many lunch boxs as possible, how many muffins are left over?

Back to School Math · 18

ANSWER

$\frac{7}{9}$

Back to School Math · 17

ANSWER

826

Back to School Math · 20

ANSWER

$\frac{5}{8}$

Back to School Math · 19

ANSWER

26

Back to School Math · 22

ANSWER

34

Back to School Math · 21

ANSWER

689

Back to School Math · 24

ANSWER

1

Back to School Math · 23

ANSWER

15