Back to School Math · 1

Mia eats $\frac{2}{5}$ of a pizza. Ella eats $\frac{1}{5}$ of it. What fraction of the pizza did they eat together?

Back to School Math · 2

Each lunch box holds 8 oatmeal cookies. The bakery fills 17 lunch boxs. How many oatmeal cookies is that?

Back to School Math · 3

Noah eats $\frac{1}{8}$ of a pizza. Omar eats $\frac{2}{8}$ of it. What fraction of the pizza did they eat together?

Back to School Math · 4

Ben puts a paper border all the way around a rectangular bulletin board that is 4 feet wide and 3 feet tall. How many feet of border does Ben need?

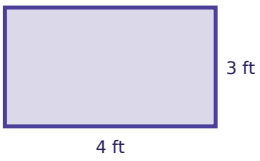

Back to School Math · 5

Lily puts a paper border all the way around a rectangular bulletin board that is 7 feet wide and 2 feet tall. How many feet of border does Lily need?

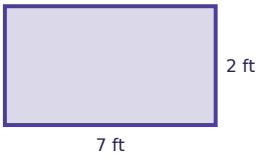

Back to School Math · 6

There are 26 muffins. Each lunch box holds 3. After filling as many lunch boxs as possible, how many muffins are left over?

Back to School Math · 7

Each lunch box holds 3 granola bars. The bakery fills 25 lunch boxs. How many granola bars is that?

Back to School Math · 8

There are 53 granola bars. Each lunch box holds 9. How many lunch boxs can be filled all the way?

Back to School Math · 2

ANSWER

136

Back to School Math · 1

ANSWER

$$\frac{3}{5}$$

Back to School Math · 4

ANSWER

14

Back to School Math · 3

ANSWER

$$\frac{3}{8}$$

Back to School Math · 6

ANSWER

2

Back to School Math · 5

ANSWER

18

Back to School Math · 8

ANSWER

5

Back to School Math · 7

ANSWER

75

Back to School Math · 9

Each lunch box holds 3 granola bars. The bakery fills 18 lunch boxs. How many granola bars is that?

Back to School Math · 10

Zoe eats $\frac{3}{8}$ of a pizza. Mia eats $\frac{2}{8}$ of it. What fraction of the pizza did they eat together?

Back to School Math · 11

There are 75 muffins. Each lunch box holds 9. After filling as many lunch boxs as possible, how many muffins are left over?

Back to School Math · 12

Each lunch box holds 9 oatmeal cookies. The bakery fills 25 lunch boxs. How many oatmeal cookies is that?

Back to School Math · 13

Sam puts a paper border all the way around a rectangular bulletin board that is 6 feet wide and 5 feet tall. How many feet of border does Sam need?

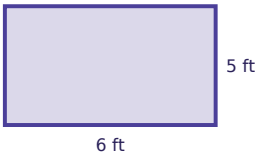

Back to School Math · 14

Ava puts a paper border all the way around a rectangular bulletin board that is 6 feet wide and 3 feet tall. How many feet of border does Ava need?

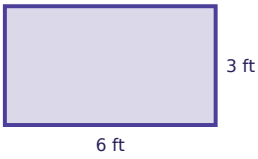

Back to School Math · 15

There are 32 muffins. Each lunch box holds 3. How many lunch boxs can be filled all the way?

Back to School Math · 16

Omar eats $\frac{2}{7}$ of a pizza. Ella eats $\frac{2}{7}$ of it. What fraction of the pizza did they eat together?

Back to School Math · 10

ANSWER

$\frac{5}{8}$

Back to School Math · 9

ANSWER

54

Back to School Math · 12

ANSWER

225

Back to School Math · 11

ANSWER

3

Back to School Math · 14

ANSWER

18

Back to School Math · 13

ANSWER

22

Back to School Math · 16

ANSWER

$\frac{4}{7}$

Back to School Math · 15

ANSWER

10

Back to School Math · 17

Each lunch box holds 7 granola bars. The bakery fills 41 lunch boxs. How many granola bars is that?

Back to School Math · 18

Zoe puts a paper border all the way around a rectangular bulletin board that is 9 feet wide and 6 feet tall. How many feet of border does Zoe need?

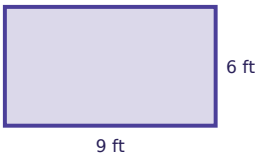

Back to School Math · 19

Zoe eats $\frac{2}{8}$ of a pizza. Ella eats $\frac{1}{8}$ of it. What fraction of the pizza did they eat together?

Back to School Math · 20

There are 50 granola bars. Each lunch box holds 7. After filling as many lunch boxs as possible, how many granola bars are left over?

Back to School Math · 21

Each lunch box holds 7 muffins. The bakery fills 46 lunch boxs. How many muffins is that?

Back to School Math · 22

Ava puts a paper border all the way around a rectangular bulletin board that is 5 feet wide and 4 feet tall. How many feet of border does Ava need?

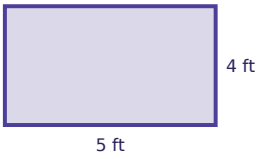

Back to School Math · 23

Zoe eats $\frac{4}{8}$ of a pizza. Ella eats $\frac{3}{8}$ of it. What fraction of the pizza did they eat together?

Back to School Math · 24

There are 24 oatmeal cookies. Each lunch box holds 5. After filling as many lunch boxs as possible, how many oatmeal cookies are left over?

Back to School Math · 18

ANSWER

30

Back to School Math · 17

ANSWER

287

Back to School Math · 20

ANSWER

1

Back to School Math · 19

ANSWER

$$\frac{3}{8}$$

Back to School Math · 22

ANSWER

18

Back to School Math · 21

ANSWER

322

Back to School Math · 24

ANSWER

4

Back to School Math · 23

ANSWER

$$\frac{7}{8}$$