Task card 1 Area & Perimeter Formulas (Unknown...

What is the area of the rectangle, in square feet?



Task card 2 Area & Perimeter Formulas (Unknown...

What is the perimeter of the rectangle, in meters?



Task card 3 Area & Perimeter Formulas (Unknown...

What is the area of the rectangle, in square yards?



Task card 4 Area & Perimeter Formulas (Unknown...

What is the perimeter of the rectangle, in feet?



Task card 5 Area & Perimeter Formulas (Unknown...

What is the area of the rectangle, in square feet?



Task card 6 Area & Perimeter Formulas (Unknown...

What is the perimeter of the rectangle, in centimeters?



Task card 7 Area & Perimeter Formulas (Unknown...

What is the area of the rectangle, in square centimeters?

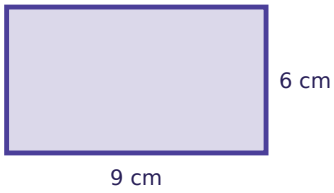

Task card 8 Area & Perimeter Formulas (Unknown...

What is the perimeter of the rectangle, in inches?

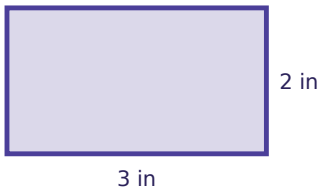

Task card 9 Area & Perimeter Formulas (Unknown...

What is the area of the rectangle, in square meters?



Task card 10 Area & Perimeter Formulas (Unknown...

What is the perimeter of the rectangle, in feet?



Task card 11 Area & Perimeter Formulas (Unknown...

What is the area of the rectangle, in square meters?



Task card 12 Area & Perimeter Formulas (Unknown...

What is the perimeter of the rectangle, in yards?



Task card 13 Area & Perimeter Formulas (Unknown...

What is the area of the rectangle, in square meters?



Task card 14 Area & Perimeter Formulas (Unknown...

What is the perimeter of the rectangle, in centimeters?



Task card 15 Area & Perimeter Formulas (Unknown...

What is the area of the rectangle, in square yards?



Task card 16 Area & Perimeter Formulas (Unknown...

What is the perimeter of the rectangle, in centimeters?



Task card 17 Area & Perimeter Formulas (Unknown...

What is the area of the rectangle, in square yards?



Task card 18 Area & Perimeter Formulas (Unknown...

What is the perimeter of the rectangle, in yards?



Task card 19 Area & Perimeter Formulas (Unknown...

The area of the rectangle is 40 square yards. What is the missing side length, in yards?



Task card 20 Area & Perimeter Formulas (Unknown...

The perimeter of the rectangle is 14 feet. What is the missing side length, in feet?

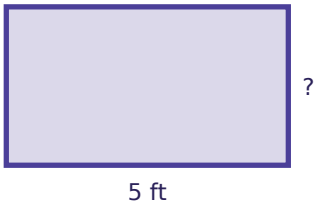

Task card 21 Area & Perimeter Formulas (Unknown...

What is the area of the rectangle, in square feet?



Task card 22 Area & Perimeter Formulas (Unknown...

What is the perimeter of the rectangle, in yards?



Task card 23 Area & Perimeter Formulas (Unknown...

The area of the rectangle is 84 square centimeters. What is the missing side length, in centimeters?

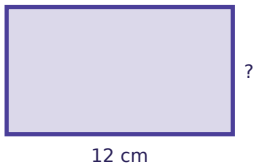

Task card 24 Area & Perimeter Formulas (Unknown...

The perimeter of the rectangle is 26 feet. What is the missing side length, in feet?

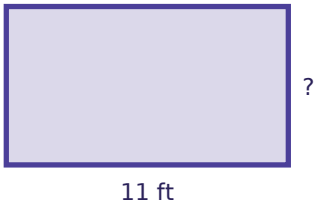

Area & Perimeter Formulas (Unknown Sides) Task Cards

Recording sheet · Grade 4 · Use the area and perimeter formulas for rectangles to answer each question.

Scan to check your answers

Name: _____ Date: _____

1	2	3	4
5	6	7	8
9	10	11	12
13	14	15	16
17	18	19	20
21	22	23	24

Area & Perimeter Formulas (Unknown Sides) Task Cards: Answer Key

Grade 4 · Easy

The answers online

1. 18	**2.** 36	**3.** 40
4. 20	**5.** 9	**6.** 20
7. 54	**8.** 10	**9.** 64
10. 16	**11.** 20	**12.** 16
13. 6	**14.** 26	**15.** 12
16. 28	**17.** 30	**18.** 18
19. 4	**20.** 2	**21.** 42
22. 18	**23.** 7	**24.** 2