Area & Perimeter Formulas (Unknown Sides) · 1

The area of the rectangle is 18 square yards. What is the missing side length, in yards?



Area & Perimeter Formulas (Unknown Sides) · 2

The perimeter of the rectangle is 32 feet. What is the missing side length, in feet?

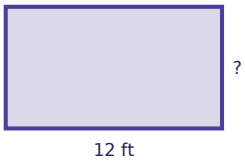

Area & Perimeter Formulas (Unknown Sides) · 3

A square has a perimeter of 28 inches. What is its area, in square inches?

Area & Perimeter Formulas (Unknown Sides) · 4

A fence goes all the way around a yard that is 16 meters long. The fence is 62 meters long. How wide is the yard, in meters?

Area & Perimeter Formulas (Unknown Sides) · 5

The area of the rectangle is 85 square feet. What is the missing side length, in feet?



Area & Perimeter Formulas (Unknown Sides) · 6

The perimeter of the rectangle is 38 meters. What is the missing side length, in meters?



Area & Perimeter Formulas (Unknown Sides) · 7

A square has an area of 49 square meters. What is its perimeter, in meters?

Area & Perimeter Formulas (Unknown Sides) · 8

A garden is 10 feet long and has an area of 40 square feet. How wide is the garden, in feet?

Area & Perimeter Formulas (Unknown Sides) · 2

ANSWER

4

Area & Perimeter Formulas (Unknown Sides) · 1

ANSWER

3

Area & Perimeter Formulas (Unknown Sides) · 4

ANSWER

15

Area & Perimeter Formulas (Unknown Sides) · 3

ANSWER

49

Area & Perimeter Formulas (Unknown Sides) · 6

ANSWER

3

Area & Perimeter Formulas (Unknown Sides) · 5

ANSWER

5

Area & Perimeter Formulas (Unknown Sides) · 8

ANSWER

4

Area & Perimeter Formulas (Unknown Sides) · 7

ANSWER

28

Area & Perimeter Formulas (Unknown Sides) · 9

The area of the rectangle is 12 square centimeters. What is the missing side length, in centimeters?



Area & Perimeter Formulas (Unknown Sides) · 10

The perimeter of the rectangle is 12 meters. What is the missing side length, in meters?



Area & Perimeter Formulas (Unknown Sides) · 11

A square has a perimeter of 36 meters. What is its area, in square meters?

Area & Perimeter Formulas (Unknown Sides) · 12

A garden is 26 feet long and has an area of 338 square feet. How wide is the garden, in feet?

Area & Perimeter Formulas (Unknown Sides) · 13

The area of the rectangle is 24 square inches. What is the missing side length, in inches?



Area & Perimeter Formulas (Unknown Sides) · 14

The perimeter of the rectangle is 54 feet. What is the missing side length, in feet?



Area & Perimeter Formulas (Unknown Sides) · 15

A square has a perimeter of 12 meters. What is its area, in square meters?

Area & Perimeter Formulas (Unknown Sides) · 16

A garden is 19 feet long and has an area of 342 square feet. How wide is the garden, in feet?

Area & Perimeter Formulas (Unknown Sides) · 10

ANSWER

2

Area & Perimeter Formulas (Unknown Sides) · 9

ANSWER

2

Area & Perimeter Formulas (Unknown Sides) · 12

ANSWER

13

Area & Perimeter Formulas (Unknown Sides) · 11

ANSWER

81

Area & Perimeter Formulas (Unknown Sides) · 14

ANSWER

3

Area & Perimeter Formulas (Unknown Sides) · 13

ANSWER

2

Area & Perimeter Formulas (Unknown Sides) · 16

ANSWER

18

Area & Perimeter Formulas (Unknown Sides) · 15

ANSWER

9

Area & Perimeter Formulas (Unknown Sides) · 17

The area of the rectangle is 182 square centimeters. What is the missing side length, in centimeters?

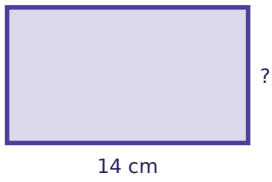

Area & Perimeter Formulas (Unknown Sides) · 18

The perimeter of the rectangle is 16 feet. What is the missing side length, in feet?

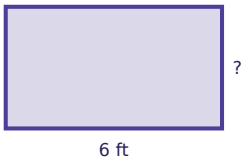

Area & Perimeter Formulas (Unknown Sides) · 19

A fence goes all the way around a yard that is 22 meters long. The fence is 56 meters long. How wide is the yard, in meters?

Area & Perimeter Formulas (Unknown Sides) · 20

The area of the rectangle is 105 square meters. What is the missing side length, in meters?



Area & Perimeter Formulas (Unknown Sides) · 21

The perimeter of the rectangle is 66 meters. What is the missing side length, in meters?



Area & Perimeter Formulas (Unknown Sides) · 22

A square has a perimeter of 60 inches. What is its area, in square inches?

Area & Perimeter Formulas (Unknown Sides) · 23

A fence goes all the way around a yard that is 20 meters long. The fence is 60 meters long. How wide is the yard, in meters?

Area & Perimeter Formulas (Unknown Sides) · 24

The area of the rectangle is 20 square centimeters. What is the missing side length, in centimeters?

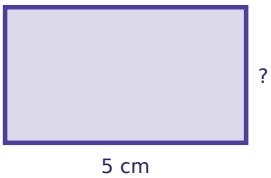

Area & Perimeter Formulas (Unknown Sides) · 18

ANSWER

2

Area & Perimeter Formulas (Unknown Sides) · 17

ANSWER

13

Area & Perimeter Formulas (Unknown Sides) · 20

ANSWER

7

Area & Perimeter Formulas (Unknown Sides) · 19

ANSWER

6

Area & Perimeter Formulas (Unknown Sides) · 22

ANSWER

225

Area & Perimeter Formulas (Unknown Sides) · 21

ANSWER

10

Area & Perimeter Formulas (Unknown Sides) · 24

ANSWER

4

Area & Perimeter Formulas (Unknown Sides) · 23

ANSWER

10