Area & Perimeter Formulas (Unknown Sides) · 1

The area of the rectangle is 18 square yards. What is the missing side length, in yards?




Area & Perimeter Formulas (Unknown Sides) · 2

The perimeter of the rectangle is 32 feet. What is the missing side length, in feet?

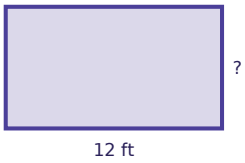


Area & Perimeter Formulas (Unknown Sides) · 3

A square has a perimeter of 28 inches. What is its area, in square inches?

Area & Perimeter Formulas (Unknown Sides) · 4

A fence goes all the way around a yard that is 16 meters long. The fence is 62 meters long. How wide is the yard, in meters?

Area & Perimeter Formulas (Unknown Sides) · 5

The area of the rectangle is 85 square feet. What is the missing side length, in feet?




Area & Perimeter Formulas (Unknown Sides) · 6

The perimeter of the rectangle is 38 meters. What is the missing side length, in meters?




Area & Perimeter Formulas (Unknown Sides) · 7

A square has an area of 49 square meters. What is its perimeter, in meters?

Area & Perimeter Formulas (Unknown Sides) · 8

A garden is 10 feet long and has an area of 40 square feet. How wide is the garden, in feet?

Area & Perimeter Formulas (Unknown Sides) · 2

**ANSWER**

**4**

Area & Perimeter Formulas (Unknown Sides) · 1

**ANSWER**

**3**

Area & Perimeter Formulas (Unknown Sides) · 4

**ANSWER**

**15**

Area & Perimeter Formulas (Unknown Sides) · 3

**ANSWER**

**49**

Area & Perimeter Formulas (Unknown Sides) · 6

**ANSWER**

**3**

Area & Perimeter Formulas (Unknown Sides) · 5

**ANSWER**

**5**

Area & Perimeter Formulas (Unknown Sides) · 8

**ANSWER**

**4**

Area & Perimeter Formulas (Unknown Sides) · 7

**ANSWER**

**28**

Area & Perimeter Formulas (Unknown Sides) · 9

The area of the rectangle is 12 square centimeters. What is the missing side length, in centimeters?




Area & Perimeter Formulas (Unknown Sides) · 10

The perimeter of the rectangle is 12 meters. What is the missing side length, in meters?




Area & Perimeter Formulas (Unknown Sides) · 11

A square has a perimeter of 36 meters. What is its area, in square meters?

Area & Perimeter Formulas (Unknown Sides) · 12

A garden is 26 feet long and has an area of 338 square feet. How wide is the garden, in feet?

Area & Perimeter Formulas (Unknown Sides) · 13

The area of the rectangle is 24 square inches. What is the missing side length, in inches?




Area & Perimeter Formulas (Unknown Sides) · 14

The perimeter of the rectangle is 54 feet. What is the missing side length, in feet?




Area & Perimeter Formulas (Unknown Sides) · 15

A square has a perimeter of 12 meters. What is its area, in square meters?

Area & Perimeter Formulas (Unknown Sides) · 16

A garden is 19 feet long and has an area of 342 square feet. How wide is the garden, in feet?

Area & Perimeter Formulas (Unknown Sides) · 10

**ANSWER**

**2**

Area & Perimeter Formulas (Unknown Sides) · 9

**ANSWER**

**2**

Area & Perimeter Formulas (Unknown Sides) · 12

**ANSWER**

**13**

Area & Perimeter Formulas (Unknown Sides) · 11

**ANSWER**

**81**

Area & Perimeter Formulas (Unknown Sides) · 14

**ANSWER**

**3**

Area & Perimeter Formulas (Unknown Sides) · 13

**ANSWER**

**2**

Area & Perimeter Formulas (Unknown Sides) · 16

**ANSWER**

**18**

Area & Perimeter Formulas (Unknown Sides) · 15

**ANSWER**

**9**

Area & Perimeter Formulas (Unknown Sides) · 17

The area of the rectangle is 182 square centimeters. What is the missing side length, in centimeters?

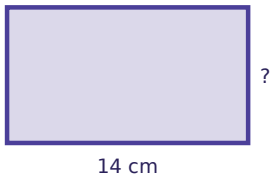


Area & Perimeter Formulas (Unknown Sides) · 18

The perimeter of the rectangle is 16 feet. What is the missing side length, in feet?

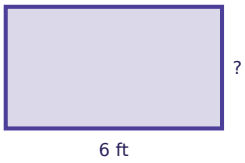


Area & Perimeter Formulas (Unknown Sides) · 19

A fence goes all the way around a yard that is 22 meters long. The fence is 56 meters long. How wide is the yard, in meters?

Area & Perimeter Formulas (Unknown Sides) · 20

The area of the rectangle is 105 square meters. What is the missing side length, in meters?




Area & Perimeter Formulas (Unknown Sides) · 21

The perimeter of the rectangle is 66 meters. What is the missing side length, in meters?




Area & Perimeter Formulas (Unknown Sides) · 22

A square has a perimeter of 60 inches. What is its area, in square inches?

Area & Perimeter Formulas (Unknown Sides) · 23

A fence goes all the way around a yard that is 20 meters long. The fence is 60 meters long. How wide is the yard, in meters?

Area & Perimeter Formulas (Unknown Sides) · 24

The area of the rectangle is 20 square centimeters. What is the missing side length, in centimeters?

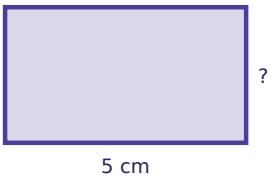

Area & Perimeter Formulas (Unknown Sides) · 18

**ANSWER**

**2**

Area & Perimeter Formulas (Unknown Sides) · 17

**ANSWER**

**13**

Area & Perimeter Formulas (Unknown Sides) · 20

**ANSWER**

**7**

Area & Perimeter Formulas (Unknown Sides) · 19

**ANSWER**

**6**

Area & Perimeter Formulas (Unknown Sides) · 22

**ANSWER**

**225**

Area & Perimeter Formulas (Unknown Sides) · 21

**ANSWER**

**10**

Area & Perimeter Formulas (Unknown Sides) · 24

**ANSWER**

**4**

Area & Perimeter Formulas (Unknown Sides) · 23

**ANSWER**

**10**