Division with an Area Model: 2-Digit by 1-Digit · 1

Each length along the top is one part ÷ 4.

Add the lengths. 48 ÷ 4 = ___

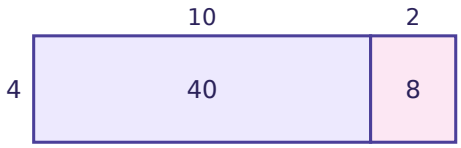

Division with an Area Model: 2-Digit by 1-Digit · 2

69 ÷ 3 = (60 ÷ 3) + (9 ÷ 3) = ___ + 3. What number goes in the blank?

Division with an Area Model: 2-Digit by 1-Digit · 3

A rectangular garden has an area of 84 square feet. It is 4 feet wide. How many feet long is it?

Division with an Area Model: 2-Digit by 1-Digit · 4

Each length along the top is one part ÷ 4.

Add the lengths. 76 ÷ 4 = ___

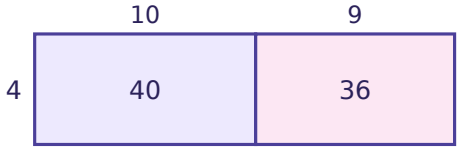

Division with an Area Model: 2-Digit by 1-Digit · 5

92 ÷ 2 = (80 ÷ 2) + (12 ÷ 2) = ___ + 6. What number goes in the blank?

Division with an Area Model: 2-Digit by 1-Digit · 6

A rectangular field has an area of 78 square yards. It is 3 yards wide. How many yards long is it?

Division with an Area Model: 2-Digit by 1-Digit · 7

Each length along the top is one part ÷ 6.

Add the lengths. 78 ÷ 6 = ___

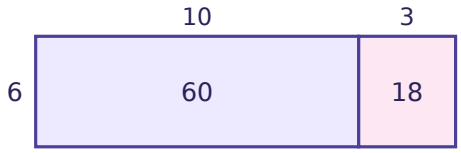

Division with an Area Model: 2-Digit by 1-Digit · 8

84 ÷ 6 = (60 ÷ 6) + (24 ÷ 6) = ___ + 4. What number goes in the blank?

Division with an Area Model: 2-Digit by 1-Digit · 2

ANSWER

20

Division with an Area Model: 2-Digit by 1-Digit · 1

ANSWER

12

Division with an Area Model: 2-Digit by 1-Digit · 4

ANSWER

19

Division with an Area Model: 2-Digit by 1-Digit · 3

ANSWER

21

Division with an Area Model: 2-Digit by 1-Digit · 6

ANSWER

26

Division with an Area Model: 2-Digit by 1-Digit · 5

ANSWER

40

Division with an Area Model: 2-Digit by 1-Digit · 8

ANSWER

10

Division with an Area Model: 2-Digit by 1-Digit · 7

ANSWER

13

Division with an Area Model: 2-Digit by 1-Digit · 9

A rectangular garden has an area of 98 square feet. It is 7 feet wide. How many feet long is it?

Division with an Area Model: 2-Digit by 1-Digit · 10

Each length along the top is one part ÷ 4.

Add the lengths. 84 ÷ 4 = ___

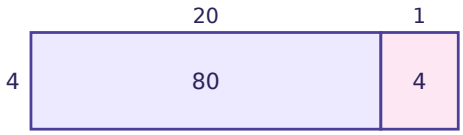

Division with an Area Model: 2-Digit by 1-Digit · 11

39 ÷ 3 = (30 ÷ 3) + (9 ÷ 3) = ___ + 3. What number goes in the blank?

Division with an Area Model: 2-Digit by 1-Digit · 12

A rectangular field has an area of 48 square yards. It is 2 yards wide. How many yards long is it?

Division with an Area Model: 2-Digit by 1-Digit · 13

Each length along the top is one part ÷ 5.

Add the lengths. 85 ÷ 5 = ___

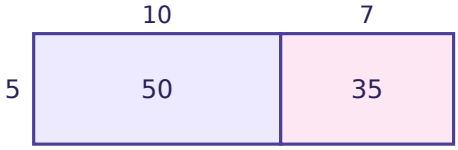

Division with an Area Model: 2-Digit by 1-Digit · 14

96 ÷ 2 = (80 ÷ 2) + (16 ÷ 2) = 40 + ___. What number goes in the blank?

Division with an Area Model: 2-Digit by 1-Digit · 15

A rectangular garden has an area of 90 square feet. It is 5 feet wide. How many feet long is it?

Division with an Area Model: 2-Digit by 1-Digit · 16

Each length along the top is one part ÷ 7.

Add the lengths. 98 ÷ 7 = ___

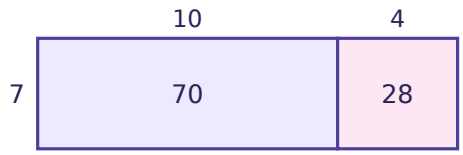

Division with an Area Model: 2-Digit by 1-Digit · 10

ANSWER

21

Division with an Area Model: 2-Digit by 1-Digit · 9

ANSWER

14

Division with an Area Model: 2-Digit by 1-Digit · 12

ANSWER

24

Division with an Area Model: 2-Digit by 1-Digit · 11

ANSWER

10

Division with an Area Model: 2-Digit by 1-Digit · 14

ANSWER

8

Division with an Area Model: 2-Digit by 1-Digit · 13

ANSWER

17

Division with an Area Model: 2-Digit by 1-Digit · 16

ANSWER

14

Division with an Area Model: 2-Digit by 1-Digit · 15

ANSWER

18

Division with an Area Model: 2-Digit by 1-Digit · 17

96 ÷ 6 = (60 ÷ 6) + (36 ÷ 6) = ___ + 6. What number goes in the blank?

Division with an Area Model: 2-Digit by 1-Digit · 18

A rectangular poster has an area of 78 square centimeters. It is 6 centimeters wide. How many centimeters long is it?

Division with an Area Model: 2-Digit by 1-Digit · 19

A rectangular poster has an area of 39 square centimeters. It is 3 centimeters wide. How many centimeters long is it?

Division with an Area Model: 2-Digit by 1-Digit · 20

Each length along the top is one part ÷ 2. Add the lengths. 78 ÷ 2 = ___

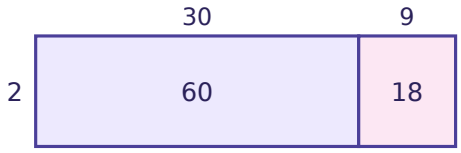

Division with an Area Model: 2-Digit by 1-Digit · 21

54 ÷ 3 = (30 ÷ 3) + (24 ÷ 3) = 10 + ___. What number goes in the blank?

Division with an Area Model: 2-Digit by 1-Digit · 22

A rectangular rug has an area of 65 square inches. It is 5 inches wide. How many inches long is it?

Division with an Area Model: 2-Digit by 1-Digit · 23

72 ÷ 6 = (60 ÷ 6) + (12 ÷ 6) = ___ + 2. What number goes in the blank?

Division with an Area Model: 2-Digit by 1-Digit · 24

A rectangular garden has an area of 78 square feet. It is 6 feet wide. How many feet long is it?

Division with an Area Model: 2-Digit by 1-Digit · 18

ANSWER

13

Division with an Area Model: 2-Digit by 1-Digit · 17

ANSWER

10

Division with an Area Model: 2-Digit by 1-Digit · 20

ANSWER

39

Division with an Area Model: 2-Digit by 1-Digit · 19

ANSWER

13

Division with an Area Model: 2-Digit by 1-Digit · 22

ANSWER

13

Division with an Area Model: 2-Digit by 1-Digit · 21

ANSWER

8

Division with an Area Model: 2-Digit by 1-Digit · 24

ANSWER

13

Division with an Area Model: 2-Digit by 1-Digit · 23

ANSWER

10