Task card 1 Angle Measurement

Classify the angle: 90°

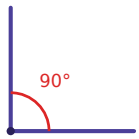

Task card 2 Angle Measurement

Classify the angle: 149°

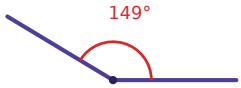

Task card 3 Angle Measurement

Classify the angle: 132°



Task card 4 Angle Measurement

It is 8 o'clock. Is the smaller angle between the two hands acute, right or obtuse?



Task card 5 Angle Measurement

It is 1 o'clock. Is the smaller angle between the two hands acute, right or obtuse?



Task card 6 Angle Measurement

Which of these is an acute angle: 90°, 71° or 167°?

Task card 7 Angle Measurement

Is a 132° angle an acute angle? (yes or no)

Task card 8 Angle Measurement

An angle of 10° and an angle of 30° are joined side by side to make one bigger angle. Is the new angle acute, right or obtuse?

Task card 9 Angle Measurement

Classify the angle: 11°



Task card 10 Angle Measurement

Classify the angle: 155°

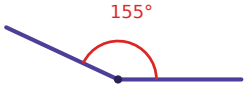

Task card 11 Angle Measurement

Classify the angle: 119°

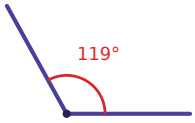

Task card 12 Angle Measurement

It is 3 o'clock. Is the smaller angle between the two hands acute, right or obtuse?



Task card 13 Angle Measurement

It is 9 o'clock. Is the smaller angle between the two hands acute, right or obtuse?



Task card 14 Angle Measurement

Which of these is an obtuse angle: 40°, 90° or 153°?

Task card 15 Angle Measurement

Is a 69° angle a right angle? (yes or no)

Task card 16 Angle Measurement

An angle of 25° and an angle of 65° are joined side by side to make one bigger angle. Is the new angle acute, right or obtuse?

Task card 17 Angle Measurement

Classify the angle: 31°

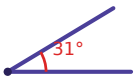

Task card 18 Angle Measurement

Classify the angle: 29°

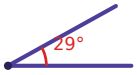

Task card 19 Angle Measurement

It is 3 o'clock. Is the smaller angle between the two hands acute, right, obtuse or straight?



Task card 20 Angle Measurement

It is 7 o'clock. Is the smaller angle between the two hands acute, right, obtuse or straight?



Task card 21 Angle Measurement

Which of these is an acute angle: 137°, 90° or 55°?

Task card 22 Angle Measurement

Is a 172° angle a right angle? (yes or no)

Task card 23 Angle Measurement

An angle of 170° and an angle of 10° are joined side by side to make one bigger angle. Is the new angle acute, right, obtuse or straight?

Task card 24 Angle Measurement

Classify the angle: 66°

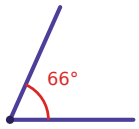

Angle Measurement Task Cards

Recording sheet · Grade 4 · Classify each angle. The same kinds of angle come in different shapes.

Name: _____ Date: _____

Scan to check your answers

1	2	3	4
5	6	7	8
9	10	11	12
13	14	15	16
17	18	19	20
21	22	23	24

Angle Measurement Task Cards: Answer Key

Grade 4 · Medium

The answers online

1. right	**2.** obtuse	**3.** obtuse
4. obtuse	**5.** acute	**6.** 71°
7. no	**8.** acute	**9.** acute
10. obtuse	**11.** obtuse	**12.** right
13. right	**14.** 153°	**15.** no
16. right	**17.** acute	**18.** acute
19. right	**20.** obtuse	**21.** 55°
22. no	**23.** straight	**24.** acute