Task card 1 Angle Measurement

Classify the angle: 37°

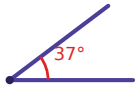

Task card 2 Angle Measurement

Classify the angle: 90°

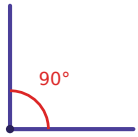

Task card 3 Angle Measurement

Classify the angle: 180°



Task card 4 Angle Measurement

It is 10 o'clock. Is the smaller angle between the two hands acute, right, obtuse or straight?



Task card 5 Angle Measurement

It is 5 o'clock. Is the smaller angle between the two hands acute, right, obtuse or straight?



Task card 6 Angle Measurement

Which of these is an acute angle: 90°, 149° or 74°?

Task card 7 Angle Measurement

Is a 120° angle a right angle? (yes or no)

Task card 8 Angle Measurement

An angle of 115° and an angle of 20° are joined side by side to make one bigger angle. Is the new angle acute, right, obtuse or straight?

Task card 9 Angle Measurement

Classify the angle: 25°

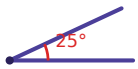

Task card 10 Angle Measurement

It is 7 o'clock. Is the smaller angle between the two hands acute, right, obtuse or straight?



Task card 11 Angle Measurement

It is 4 o'clock. Is the smaller angle between the two hands acute, right, obtuse or straight?



Task card 12 Angle Measurement

Which of these is an obtuse angle: 90°, 173° or 71°?

Task card 13 Angle Measurement

Is a 9° angle a right angle? (yes or no)

Task card 14 Angle Measurement

An angle of 75° and an angle of 25° are joined side by side to make one bigger angle. Is the new angle acute, right, obtuse or straight?

Task card 15 Angle Measurement

Classify the angle: 152°

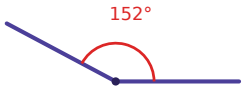

Task card 16 Angle Measurement

Classify the angle: 88°

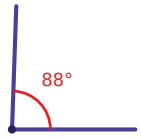

Task card 17 Angle Measurement

It is 6 o'clock. Is the smaller angle between the two hands acute, right, obtuse or straight?



Task card 18 Angle Measurement

It is 11 o'clock. Is the smaller angle between the two hands acute, right, obtuse or straight?



Task card 19 Angle Measurement

Which of these is a straight angle: 90°, 180° or 89°?

Task card 20 Angle Measurement

Is a 180° angle an obtuse angle? (yes or no)

Task card 21 Angle Measurement

An angle of 105° and an angle of 75° are joined side by side to make one bigger angle. Is the new angle acute, right, obtuse or straight?

Task card 22 Angle Measurement

Classify the angle: 66°

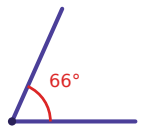

Task card 23 Angle Measurement

Classify the angle: 133°

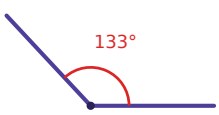

Task card 24 Angle Measurement

It is 9 o'clock. Is the smaller angle between the two hands acute, right, obtuse or straight?



Angle Measurement Task Cards

Recording sheet · Grade 4 · Classify each angle. The same kinds of angle come in different shapes.

Name: _____ Date: _____

Scan to check your answers

1	2	3	4
5	6	7	8
9	10	11	12
13	14	15	16
17	18	19	20
21	22	23	24

Angle Measurement Task Cards: Answer Key

Grade 4 · Hard

The answers online

1. acute	**2.** right	**3.** straight
4. acute	**5.** obtuse	**6.** 74°
7. no	**8.** obtuse	**9.** acute
10. obtuse	**11.** obtuse	**12.** 173°
13. no	**14.** obtuse	**15.** obtuse
16. acute	**17.** straight	**18.** acute
19. 180°	**20.** no	**21.** straight
22. acute	**23.** obtuse	**24.** right