Task card 1 Angle Measurement

Classify the angle:

90°

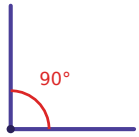

Task card 2 Angle Measurement

Classify the angle:

23°

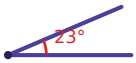

Task card 3 Angle Measurement

Classify the angle:

71°

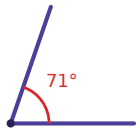

Task card 4 Angle Measurement

It is 11 o'clock. Is the smaller angle between the two hands acute or right?



Task card 5 Angle Measurement

It is 10 o'clock. Is the smaller angle between the two hands acute or right?



Task card 6 Angle Measurement

Which of these is a right angle: 159°, 90° or 70°?

Task card 7 Angle Measurement

Is a 63° angle an acute angle? (yes or no)

Task card 8 Angle Measurement

An angle of 45° and an angle of 45° are joined side by side to make one bigger angle. Is the new angle acute or right?

Task card 9 Angle Measurement

Classify the angle: 10°



Task card 10 Angle Measurement

Classify the angle: 22°

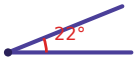

Task card 11 Angle Measurement

It is 9 o'clock. Is the smaller angle between the two hands acute or right?



Task card 12 Angle Measurement

Which of these is a right angle: 177°, 90° or 55°?

Task card 13 Angle Measurement

Is a 5° angle an acute angle? (yes or no)

Task card 14 Angle Measurement

An angle of 50° and an angle of 25° are joined side by side to make one bigger angle. Is the new angle acute or right?

Task card 15 Angle Measurement

Classify the angle: 122°

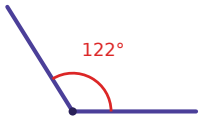

Task card 16 Angle Measurement

Classify the angle: 123°

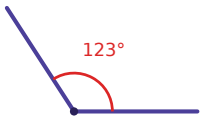

Task card 17 Angle Measurement

It is 8 o'clock. Is the smaller angle between the two hands acute, right or obtuse?



Task card 18 Angle Measurement

It is 4 o'clock. Is the smaller angle between the two hands acute, right or obtuse?



Task card 19 Angle Measurement

Which of these is an obtuse angle: 29°, 90° or 94°?

Task card 20 Angle Measurement

Is a 3° angle an obtuse angle? (yes or no)

Task card 21 Angle Measurement

An angle of 75° and an angle of 15° are joined side by side to make one bigger angle. Is the new angle acute, right or obtuse?

Task card 22 Angle Measurement

Classify the angle: 78°

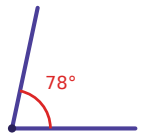

Task card 23 Angle Measurement

Classify the angle: 81°

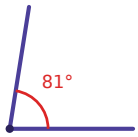

Task card 24 Angle Measurement

It is 3 o'clock. Is the smaller angle between the two hands acute or right?



Angle Measurement Task Cards

Recording sheet · Grade 4 · Classify each angle. The same kinds of angle come in different shapes.

Name: _____ Date: _____

Scan to check your answers

1	2	3	4
5	6	7	8
9	10	11	12
13	14	15	16
17	18	19	20
21	22	23	24

Angle Measurement Task Cards: Answer Key

Grade 4 · Easy

The answers online

1. right	**2.** acute	**3.** acute
4. acute	**5.** acute	**6.** 90°
7. yes	**8.** right	**9.** acute
10. acute	**11.** right	**12.** 90°
13. yes	**14.** acute	**15.** obtuse
16. obtuse	**17.** obtuse	**18.** obtuse
19. 94°	**20.** no	**21.** right
22. acute	**23.** acute	**24.** right