Angle Measurement · 1

Classify the angle: 37°

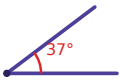

Angle Measurement · 2

Classify the angle: 90°

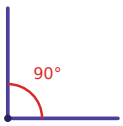

Angle Measurement · 3

Classify the angle: 180°



Angle Measurement · 4

It is 10 o'clock. Is the smaller angle between the two hands acute, right, obtuse or straight?



Angle Measurement · 5

It is 5 o'clock. Is the smaller angle between the two hands acute, right, obtuse or straight?



Angle Measurement · 6

Which of these is an acute angle: 90°, 149° or 74°?

Angle Measurement · 7

Is a 120° angle a right angle? (yes or no)

Angle Measurement · 8

An angle of 115° and an angle of 20° are joined side by side to make one bigger angle. Is the new angle acute, right, obtuse or straight?

Angle Measurement · 2

ANSWER

right

Angle Measurement · 1

ANSWER

acute

Angle Measurement · 4

ANSWER

acute

Angle Measurement · 3

ANSWER

straight

Angle Measurement · 6

ANSWER

74°

Angle Measurement · 5

ANSWER

obtuse

Angle Measurement · 8

ANSWER

obtuse

Angle Measurement · 7

ANSWER

no

Angle Measurement · 9

Classify the angle: 25°

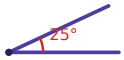

Angle Measurement · 10

It is 7 o'clock. Is the smaller angle between the two hands acute, right, obtuse or straight?



Angle Measurement · 11

It is 4 o'clock. Is the smaller angle between the two hands acute, right, obtuse or straight?



Angle Measurement · 12

Which of these is an obtuse angle: 90°, 173° or 71°?

Angle Measurement · 13

Is a 9° angle a right angle? (yes or no)

Angle Measurement · 14

An angle of 75° and an angle of 25° are joined side by side to make one bigger angle. Is the new angle acute, right, obtuse or straight?

Angle Measurement · 15

Classify the angle: 152°



Angle Measurement · 16

Classify the angle: 88°

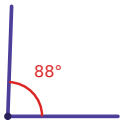

Angle Measurement · 10

ANSWER

obtuse

Angle Measurement · 9

ANSWER

acute

Angle Measurement · 12

ANSWER

173°

Angle Measurement · 11

ANSWER

obtuse

Angle Measurement · 14

ANSWER

obtuse

Angle Measurement · 13

ANSWER

no

Angle Measurement · 16

ANSWER

acute

Angle Measurement · 15

ANSWER

obtuse

Angle Measurement · 17

It is 6 o'clock. Is the smaller angle between the two hands acute, right, obtuse or straight?



Angle Measurement · 18

It is 11 o'clock. Is the smaller angle between the two hands acute, right, obtuse or straight?



Angle Measurement · 19

Which of these is a straight angle: 90°, 180° or 89°?

Angle Measurement · 20

Is a 180° angle an obtuse angle? (yes or no)

Angle Measurement · 21

An angle of 105° and an angle of 75° are joined side by side to make one bigger angle. Is the new angle acute, right, obtuse or straight?

Angle Measurement · 22

Classify the angle: 66°

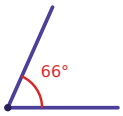

Angle Measurement · 23

Classify the angle: 133°



Angle Measurement · 24

It is 9 o'clock. Is the smaller angle between the two hands acute, right, obtuse or straight?



Angle Measurement · 18

ANSWER

acute

Angle Measurement · 17

ANSWER

straight

Angle Measurement · 20

ANSWER

no

Angle Measurement · 19

ANSWER

180°

Angle Measurement · 22

ANSWER

acute

Angle Measurement · 21

ANSWER

straight

Angle Measurement · 24

ANSWER

right

Angle Measurement · 23

ANSWER

obtuse