Task card 1 Adding Mixed Numbers (Like Denomin...

$8\frac{4}{5} + 7\frac{1}{5} = ___$

Task card 2 Adding Mixed Numbers (Like Denomin...

$3\frac{5}{6} + 3\frac{1}{6} = ___$

Task card 3 Adding Mixed Numbers (Like Denomin...

$3\frac{4}{5} + 1\frac{4}{5} = ___$

Task card 4 Adding Mixed Numbers (Like Denomin...

The parts make one long bar. How long is the whole bar? $4\frac{2}{3} + 4\frac{2}{3} = ___$

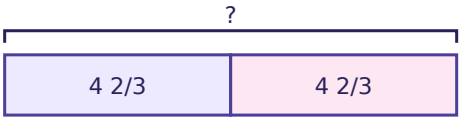

Task card 5 Adding Mixed Numbers (Like Denomin...

Add the whole numbers: 4 + 5 = 9.

Add the fractions: $\frac{3}{5} + \frac{4}{5} = \frac{7}{5} = 1\frac{2}{5}$.

So $4\frac{3}{5} + 5\frac{4}{5} = ___$

Task card 6 Adding Mixed Numbers (Like Denomin...

$4\frac{1}{4} + ___ = 13$

Task card 7 Adding Mixed Numbers (Like Denomin...

Max walked $2\frac{1}{3}$ miles, then $3\frac{2}{3}$ miles. How many miles did Max walk in all?

Task card 8 Adding Mixed Numbers (Like Denomin...

$1\frac{2}{3} + 6\frac{1}{3} = 8$. Check it by subtracting: $8 - 6\frac{1}{3} =$ ___

Task card 9 Adding Mixed Numbers (Like Denomin...

$$1\frac{4}{7} + 12\frac{5}{7} = ___$$

Task card 10 Adding Mixed Numbers (Like Denomin...

$$9\frac{1}{8} + 9\frac{7}{8} = ___$$

Task card 11 Adding Mixed Numbers (Like Denomin...

$$12\frac{1}{6} + 4\frac{5}{6} = ___$$

Task card 12 Adding Mixed Numbers (Like Denomin...

The parts make one long bar. How long is the whole bar? $7\frac{6}{7} + 5\frac{3}{7} =$ ___

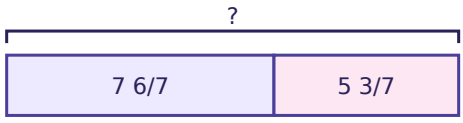

Task card 13 Adding Mixed Numbers (Like Denomin...

Add the whole numbers: $4 + 7 = 11$.

Add the fractions: $\frac{2}{5} + \frac{4}{5} = \frac{6}{5} = 1\frac{1}{5}$.

So $4\frac{2}{5} + 7\frac{4}{5} =$ ___

Task card 14 Adding Mixed Numbers (Like Denomin...

$3\frac{5}{7} + ___ = 13\frac{2}{7}$

Task card 15 Adding Mixed Numbers (Like Denomin...

Leo walked $12\frac{2}{7}$ miles, then $8\frac{6}{7}$ miles. How many miles did Leo walk in all?

Task card 16 Adding Mixed Numbers (Like Denomin...

$2\frac{11}{12} + 6\frac{1}{12} = 9$. Check it by subtracting: $9 - 6\frac{1}{12} =$ ___

Task card 17 Adding Mixed Numbers (Like Denomin...

$9\frac{3}{8} + 4\frac{7}{8} =$ ___

Task card 18 Adding Mixed Numbers (Like Denomin...

$7\frac{5}{8} + 8\frac{7}{8} =$ ___

Task card 19 Adding Mixed Numbers (Like Denomin...

$11\frac{7}{8} + 12\frac{3}{8} = ___$

Task card 20 Adding Mixed Numbers (Like Denomin...

The parts make one long bar. How long is the whole bar? $2\frac{7}{10} + 4\frac{7}{10} = ___$

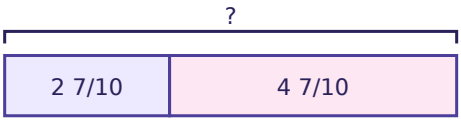

Task card 21 Adding Mixed Numbers (Like Denomin...

Add the whole numbers: 4 + 7 = 11.

Add the fractions: $\frac{5}{6} + \frac{5}{6} = \frac{10}{6} = 1\frac{4}{6}$.

So $4\frac{5}{6} + 7\frac{5}{6} = ___$

Task card 22 Adding Mixed Numbers (Like Denomin...

$10\frac{5}{6} + ___ = 17\frac{2}{3}$

Task card 23 Adding Mixed Numbers (Like Denomin...

Lily walked $12\frac{3}{4}$ miles, then $9\frac{3}{4}$ miles. How many miles did Lily walk in all?

Task card 24 Adding Mixed Numbers (Like Denomin...

$8\frac{7}{8} + 11\frac{7}{8} = 20\frac{3}{4}$. Check it by subtracting: $20\frac{3}{4} - 11\frac{7}{8} = ___$

Adding Mixed Numbers (Like Denominators) Task Cards

Recording sheet · Grade 4 · Answer each question. Write each answer in lowest terms as a mixed number or a whole number.

Scan to check your answers

Name: _____ Date: _____

1	2	3	4
5	6	7	8
9	10	11	12
13	14	15	16
17	18	19	20
21	22	23	24

Adding Mixed Numbers (Like Denominators) Task Cards: Answer Key

Grade 4 · Medium

The answers online

1. 16	**2.** 7	**3.** $5\frac{3}{5}$
4. $9\frac{1}{3}$	**5.** $10\frac{2}{5}$	**6.** $8\frac{3}{4}$
7. 6	**8.** $1\frac{2}{3}$	**9.** $14\frac{2}{7}$
10. 19	**11.** 17	**12.** $13\frac{2}{7}$
13. $12\frac{1}{5}$	**14.** $9\frac{4}{7}$	**15.** $21\frac{1}{7}$
16. $2\frac{11}{12}$	**17.** $14\frac{1}{4}$	**18.** $16\frac{1}{2}$
19. $24\frac{1}{4}$	**20.** $7\frac{2}{5}$	**21.** $12\frac{2}{3}$
22. $6\frac{5}{6}$	**23.** $22\frac{1}{2}$	**24.** $8\frac{7}{8}$