Task card 1 Adding Mixed Numbers (Like Denomin...

$18\frac{1}{10} + 18\frac{9}{10} = ___$

Task card 2 Adding Mixed Numbers (Like Denomin...

$25\frac{4}{5} + 23\frac{1}{5} = ___$

Task card 3 Adding Mixed Numbers (Like Denomin...

$14\frac{2}{5} + 24\frac{4}{5} = ___$

Task card 4 Adding Mixed Numbers (Like Denomin...

The parts make one long bar. How long is the whole bar? $17\frac{2}{3} + 12\frac{2}{3} = ___$

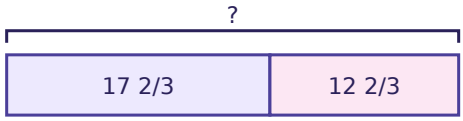

Task card 5 Adding Mixed Numbers (Like Denomin...

Add the whole numbers: 20 + 20 = 40. Add the fractions: $\frac{5}{8} + \frac{5}{8} = \frac{10}{8} = 1\frac{2}{8}$. So $20\frac{5}{8} + 20\frac{5}{8} = ___$

Task card 6 Adding Mixed Numbers (Like Denomin...

$21\frac{5}{12} + ___ = 39\frac{1}{3}$

Task card 7 Adding Mixed Numbers (Like Denomin...

Sam used $22\frac{1}{5}$ meters of ribbon, then $13\frac{4}{5}$ meters of ribbon. How many meters of ribbon did Sam use in all?

Task card 8 Adding Mixed Numbers (Like Denomin...

$14\frac{4}{5} + 20\frac{4}{5} = 35\frac{3}{5}$. Check it by subtracting: $35\frac{3}{5} - 20\frac{4}{5} =$ ___

Task card 9 Adding Mixed Numbers (Like Denomin...

$$7\frac{1}{3} + 9\frac{1}{3} + 3\frac{2}{3} =$$

___

Task card 10 Adding Mixed Numbers (Like Denomin...

$$7\frac{2}{3} + 1\frac{1}{3} + 7\frac{2}{3} =$$

___

Task card 11 Adding Mixed Numbers (Like Denomin...

$$3\frac{1}{5} + 7\frac{2}{5} + 1\frac{2}{5} =$$

___

Task card 12 Adding Mixed Numbers (Like Denomin...

The parts make one long bar. How long is the whole bar? $4\frac{2}{5} + 6\frac{2}{5} + 7\frac{2}{5} =$ ___

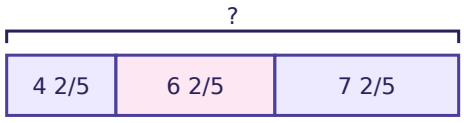

Task card 13 Adding Mixed Numbers (Like Denomin...

Add the whole numbers: 9 + 2 + 6 = 17.

Add the fractions: $\frac{7}{12} + \frac{7}{12} + \frac{7}{12} = \frac{21}{12} = 1\frac{9}{12}$. So $9\frac{7}{12} + 2\frac{7}{12} + 6\frac{7}{12} =$ ___

Task card 14 Adding Mixed Numbers (Like Denomin...

$6\frac{1}{3} + 7\frac{1}{3} + ___ = 20$

Task card 15 Adding Mixed Numbers (Like Denomin...

Lily used $1\frac{3}{5}$ meters of ribbon, then $3\frac{3}{5}$ meters of ribbon, then $3\frac{3}{5}$ meters of ribbon. How many meters of ribbon did Lily use in all?

Task card 16 Adding Mixed Numbers (Like Denomin...

$___ + 8\frac{2}{3} + 7\frac{2}{3} = 20$

Task card 17 Adding Mixed Numbers (Like Denomin...

$23\frac{2}{3} + 12\frac{1}{3} = ___$

Task card 18 Adding Mixed Numbers (Like Denomin...

$24\frac{3}{5} + 25\frac{4}{5} = ___$

Task card 19 Adding Mixed Numbers (Like Denomin...

$21\ \frac{9}{10} + 19\ \frac{3}{10} = ___$

Task card 20 Adding Mixed Numbers (Like Denomin...

The parts make one long bar. How long is the whole bar? $19\ \frac{3}{5} + 19\ \frac{4}{5} = ___$

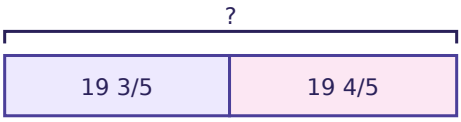

Task card 21 Adding Mixed Numbers (Like Denomin...

Add the whole numbers: 12 + 17 = 29. Add the fractions: $\frac{3}{4} + \frac{1}{4} = \frac{4}{4} = 1$.

So $12\ \frac{3}{4} + 17\ \frac{1}{4} = ___$

Task card 22 Adding Mixed Numbers (Like Denomin...

$17\ \frac{5}{6} + ___ = 31$

Task card 23 Adding Mixed Numbers (Like Denomin...

Ben walked $23\ \frac{1}{3}$ miles, then $19\ \frac{2}{3}$ miles. How many miles did Ben walk in all?

Task card 24 Adding Mixed Numbers (Like Denomin...

$24\ \frac{1}{3} + 23\ \frac{2}{3} = 48$. Check it by subtracting: $48 - 23\ \frac{2}{3} = ___$

Adding Mixed Numbers (Like Denominators) Task Cards

Recording sheet · Grade 4 · Answer each question. Write each answer in lowest terms as a mixed number or a whole number.

Scan to check your answers

Name: _____ Date: _____

1	2	3	4
5	6	7	8
9	10	11	12
13	14	15	16
17	18	19	20
21	22	23	24

Adding Mixed Numbers (Like Denominators) Task Cards: Answer Key

Grade 4 · Hard

The answers online

1. 37	**2.** 49	**3.** $39\frac{1}{5}$
4. $30\frac{1}{3}$	**5.** $41\frac{1}{4}$	**6.** $17\frac{11}{12}$
7. 36	**8.** $14\frac{4}{5}$	**9.** $20\frac{1}{3}$
10. $16\frac{2}{3}$	**11.** 12	**12.** $18\frac{1}{5}$
13. $18\frac{3}{4}$	**14.** $6\frac{1}{3}$	**15.** $8\frac{4}{5}$
16. $3\frac{2}{3}$	**17.** 36	**18.** $50\frac{2}{5}$
19. $41\frac{1}{5}$	**20.** $39\frac{2}{5}$	**21.** 30
22. $13\frac{1}{6}$	**23.** 43	**24.** $24\frac{1}{3}$