Task card 1 Adding Mixed Numbers (Like Denomin...

$1\frac{2}{5} + 4\frac{2}{5} = ___$

Task card 2 Adding Mixed Numbers (Like Denomin...

$5\frac{1}{5} + 4\frac{2}{5} = ___$

Task card 3 Adding Mixed Numbers (Like Denomin...

$5\frac{1}{3} + 5\frac{1}{3} = ___$

Task card 4 Adding Mixed Numbers (Like Denomin...

The parts make one long bar. How long is the whole bar? $5\frac{3}{5} + 2\frac{1}{5} = ___$

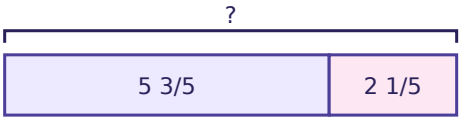

Task card 5 Adding Mixed Numbers (Like Denomin...

Add the whole numbers: 4 + 2 = 6.

Add the fractions: $\frac{1}{5} + \frac{1}{5} = \frac{2}{5}$. So $4\frac{1}{5} + 2\frac{1}{5} = ___$

Task card 6 Adding Mixed Numbers (Like Denomin...

$2\frac{1}{3} + ___ = 7\frac{2}{3}$

Task card 7 Adding Mixed Numbers (Like Denomin...

Max walked $5\frac{3}{5}$ miles, then $3\frac{1}{5}$ miles. How many miles did Max walk in all?

Task card 8 Adding Mixed Numbers (Like Denomin...

$2\frac{3}{5} + 5\frac{1}{5} = 7\frac{4}{5}$. Check it by subtracting: $7\frac{4}{5} - 5\frac{1}{5} =$ ___

Task card 9 Adding Mixed Numbers (Like Denomin...

$$7\frac{1}{5} + 8\frac{3}{5} = ___$$

Task card 10 Adding Mixed Numbers (Like Denomin...

$$4\frac{3}{7} + 6\frac{1}{7} = ___$$

Task card 11 Adding Mixed Numbers (Like Denomin...

$$4\frac{2}{9} + 6\frac{2}{9} = ___$$

Task card 12 Adding Mixed Numbers (Like Denomin...

The parts make one long bar. How long is the whole bar? $1\frac{4}{7} + 7\frac{1}{7} =$ ___

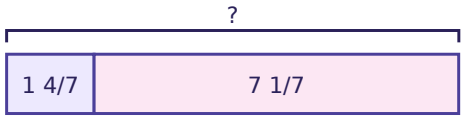

Task card 13 Adding Mixed Numbers (Like Denomin...

Add the whole numbers: 7 + 6 = 13.

Add the fractions: $\frac{2}{7} + \frac{4}{7} = \frac{6}{7}$. So $7\frac{2}{7} + 6\frac{4}{7} =$ ___

Task card 14 Adding Mixed Numbers (Like Denomin...

$$1\frac{3}{7} + ___ = 6\frac{5}{7}$$

Task card 15 Adding Mixed Numbers (Like Denomin...

Zoe used $5\frac{2}{5}$ meters of ribbon, then $9\frac{1}{5}$ meters of ribbon. How many meters of ribbon did Zoe use in all?

Task card 16 Adding Mixed Numbers (Like Denomin...

$9\frac{1}{7} + 3\frac{4}{7} = 12\frac{5}{7}$. Check it by subtracting: $12\frac{5}{7} - 3\frac{4}{7} =$ ___

Task card 17 Adding Mixed Numbers (Like Denomin...

$$4\frac{1}{10} + 7\frac{1}{10} = ___$$

Task card 18 Adding Mixed Numbers (Like Denomin...

$$9\frac{1}{6} + 4\frac{1}{6} = ___$$

Task card 19 Adding Mixed Numbers (Like Denomin...

$3\frac{1}{4} + 5\frac{1}{4} = ___$

Task card 20 Adding Mixed Numbers (Like Denomin...

The parts make one long bar. How long is the whole bar? $5\frac{3}{8} + 8\frac{3}{8} = ___$

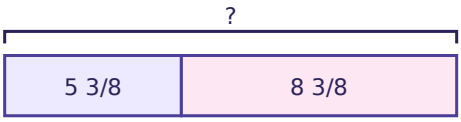

Task card 21 Adding Mixed Numbers (Like Denomin...

Add the whole numbers: 4 + 1 = 5.

Add the fractions: $\frac{1}{6} + \frac{1}{6} = \frac{2}{6}$. So $4\frac{1}{6} + 1\frac{1}{6} = ___$

Task card 22 Adding Mixed Numbers (Like Denomin...

$5\frac{5}{12} + ___ = 6\frac{1}{2}$

Task card 23 Adding Mixed Numbers (Like Denomin...

Leo used $8\frac{1}{10}$ meters of ribbon, then $7\frac{7}{10}$ meters of ribbon. How many meters of ribbon did Leo use in all?

Task card 24 Adding Mixed Numbers (Like Denomin...

$6\frac{7}{12} + 6\frac{1}{12} = 12\frac{2}{3}$. Check it by subtracting: $12\frac{2}{3} - 6\frac{1}{12} = ___$

Adding Mixed Numbers (Like Denominators) Task Cards

Recording sheet · Grade 4 · Answer each question. Write each answer in lowest terms as a mixed number or a whole number.

Scan to check your answers

Name: _____ Date: _____

1	2	3	4
5	6	7	8
9	10	11	12
13	14	15	16
17	18	19	20
21	22	23	24

Adding Mixed Numbers (Like Denominators) Task Cards: Answer Key

Grade 4 · Easy

The answers online

1. $5\frac{4}{5}$	**2.** $9\frac{3}{5}$	**3.** $10\frac{2}{3}$
4. $7\frac{4}{5}$	**5.** $6\frac{2}{5}$	**6.** $5\frac{1}{3}$
7. $8\frac{4}{5}$	**8.** $2\frac{3}{5}$	**9.** $15\frac{4}{5}$
10. $10\frac{4}{7}$	**11.** $10\frac{4}{9}$	**12.** $8\frac{5}{7}$
13. $13\frac{6}{7}$	**14.** $5\frac{2}{7}$	**15.** $14\frac{3}{5}$
16. $9\frac{1}{7}$	**17.** $11\frac{1}{5}$	**18.** $13\frac{1}{3}$
19. $8\frac{1}{2}$	**20.** $13\frac{3}{4}$	**21.** $5\frac{1}{3}$
22. $1\frac{1}{12}$	**23.** $15\frac{4}{5}$	**24.** $6\frac{7}{12}$